Halloween Math · 1

Sam buys a pumpkin for $5.10 and pays with a $10 bill. How much change does Sam get?

Halloween Math · 2

One batch of a recipe uses $\frac{1}{3}$ cup of candy corn. Ava makes 2 batches. How many cups of candy corn does Ava use?

Halloween Math · 3

One bag of candy costs $7.55. Ella buys 3 bags of candy. How much does Ella spend?

Halloween Math · 4

Ava buys a costume mask for $9.80 and pays with a $10 bill. How much change does Ava get?

Halloween Math · 5

One batch of a recipe uses $\frac{1}{4}$ cup of candy corn. Omar makes 2 batches. How many cups of candy corn does Omar use?

Halloween Math · 6

A costume box is 9 inches long, 6 inches wide and 5 inches tall. What is its volume in cubic inches?

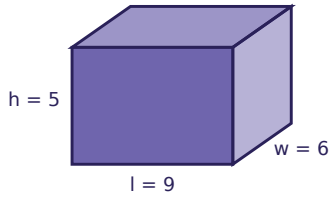

Halloween Math · 7

One pumpkin costs $5.50. Lily buys 2 pumpkins. How much does Lily spend?

Halloween Math · 8

A costume box is 4 inches long, 7 inches wide and 2 inches tall. What is its volume in cubic inches?

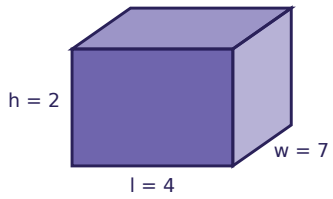

Halloween Math · 2

ANSWER

$\frac{2}{3}$

Halloween Math · 1

ANSWER

$4.90

Halloween Math · 4

ANSWER

$0.20

Halloween Math · 3

ANSWER

$22.65

Halloween Math · 6

ANSWER

270

Halloween Math · 5

ANSWER

$\frac{1}{2}$

Halloween Math · 8

ANSWER

56

Halloween Math · 7

ANSWER

$11.00

Halloween Math · 9

One pumpkin costs $4.05. Ben buys 3 pumpkins. How much does Ben spend?

Halloween Math · 10

One costume mask costs $5.60. Zoe buys 6 costume masks. How much does Zoe spend?

Halloween Math · 11

A costume box is 5 inches long, 3 inches wide and 8 inches tall. What is its volume in cubic inches?

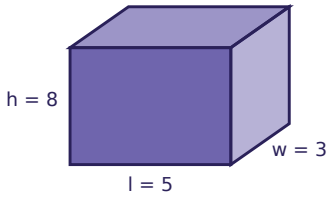

Halloween Math · 12

Zoe buys a costume mask for $9.82 and pays with a $10 bill. How much change does Zoe get?

Halloween Math · 13

One batch of a recipe uses $\frac{5}{6}$ cup of candy corn. Lily makes 2 batches. How many cups of candy corn does Lily use?

Halloween Math · 14

Sam buys a bag of candy for $6.29 and pays with a $10 bill. How much change does Sam get?

Halloween Math · 15

A costume box is 11 inches long, 8 inches wide and 7 inches tall. What is its volume in cubic inches?

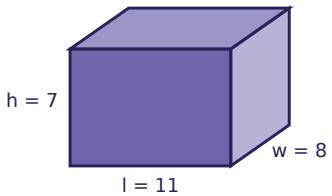

Halloween Math · 16

One batch of a recipe uses $\frac{3}{8}$ cup of candy corn. Mia makes 4 batches. How many cups of candy corn does Mia use?

Halloween Math · 10

ANSWER

$33.60

Halloween Math · 9

ANSWER

$12.15

Halloween Math · 12

ANSWER

$0.18

Halloween Math · 11

ANSWER

120

Halloween Math · 14

ANSWER

$3.71

Halloween Math · 13

ANSWER

$$1\frac{2}{3}$$

Halloween Math · 16

ANSWER

$$1\frac{1}{2}$$

Halloween Math · 15

ANSWER

616

Halloween Math · 17

One batch of a recipe uses $\frac{2}{3}$ cup of candy corn. Mia makes 3 batches. How many cups of candy corn does Mia use?

Halloween Math · 18

One pumpkin costs $7.85. Noah buys 4 pumpkins. How much does Noah spend?

Halloween Math · 19

A costume box is 11 inches long, 6 inches wide and 5 inches tall. What is its volume in cubic inches?

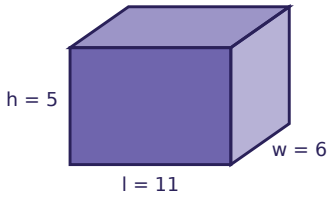

Halloween Math · 20

One costume mask costs $8.35. Noah buys 2 costume masks. How much does Noah spend?

Halloween Math · 21

Sam buys a pumpkin for $4.02 and pays with a $10 bill. How much change does Sam get?

Halloween Math · 22

Noah buys a costume mask for $11.96 and pays with a $20 bill. How much change does Noah get?

Halloween Math · 23

One batch of a recipe uses $\frac{3}{8}$ cup of candy corn. Lily makes 4 batches. How many cups of candy corn does Lily use?

Halloween Math · 24

A costume box is 9 inches long, 4 inches wide and 2 inches tall. What is its volume in cubic inches?

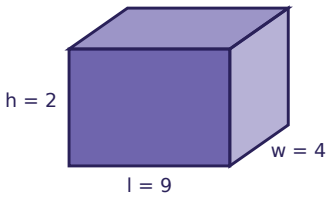

Halloween Math · 18

ANSWER

$31.40

Halloween Math · 17

ANSWER

2

Halloween Math · 20

ANSWER

$16.70

Halloween Math · 19

ANSWER

330

Halloween Math · 22

ANSWER

$8.04

Halloween Math · 21

ANSWER

$5.98

Halloween Math · 24

ANSWER

72

Halloween Math · 23

ANSWER

$$1\frac{1}{2}$$