Halloween Math · 1

One batch of a recipe uses $\frac{1}{3}$ cup of candy corn. Zoe makes 3 batches. How many cups of candy corn does Zoe use?

Halloween Math · 2

One costume mask costs $6.75. Noah buys 3 costume masks. How much does Noah spend?

Halloween Math · 3

A costume box is 7 inches long, 3 inches wide and 3 inches tall. What is its volume in cubic inches?

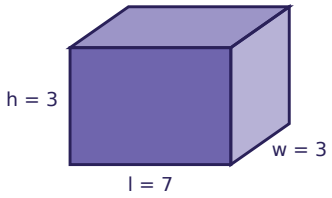

Halloween Math · 4

One batch of a recipe uses $\frac{1}{4}$ cup of candy corn. Noah makes 3 batches. How many cups of candy corn does Noah use?

Halloween Math · 5

Leo buys a costume mask for $10.70 and pays with a $20 bill. How much change does Leo get?

Halloween Math · 6

A costume box is 6 inches long, 4 inches wide and 4 inches tall. What is its volume in cubic inches?

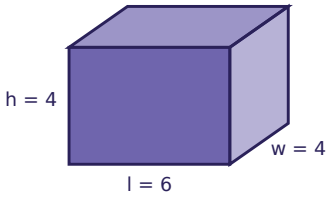

Halloween Math · 7

Lily buys a pumpkin for $6.65 and pays with a $10 bill. How much change does Lily get?

Halloween Math · 8

One costume mask costs $10.20. Mia buys 3 costume masks. How much does Mia spend?

Halloween Math · 2

ANSWER

$20.25

Halloween Math · 1

ANSWER

1

Halloween Math · 4

ANSWER

$$\frac{3}{4}$$

Halloween Math · 3

ANSWER

63

Halloween Math · 6

ANSWER

96

Halloween Math · 5

ANSWER

$9.30

Halloween Math · 8

ANSWER

$30.60

Halloween Math · 7

ANSWER

$3.35

Halloween Math · 9

Omar buys a pumpkin for $7.60 and pays with a $10 bill. How much change does Omar get?

Halloween Math · 10

One bag of candy costs $7.85. Omar buys 4 bags of candy. How much does Omar spend?

Halloween Math · 11

One costume mask costs $9.85. Ella buys 4 costume masks. How much does Ella spend?

Halloween Math · 12

A costume box is 7 inches long, 6 inches wide and 3 inches tall. What is its volume in cubic inches?

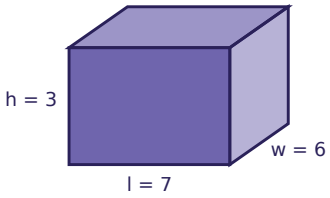

Halloween Math · 13

A costume box is 4 inches long, 3 inches wide and 4 inches tall. What is its volume in cubic inches?

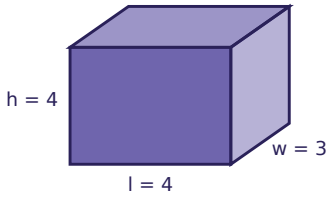

Halloween Math · 14

One batch of a recipe uses $\frac{3}{4}$ cup of candy corn. Lily makes 4 batches. How many cups of candy corn does Lily use?

Halloween Math · 15

One batch of a recipe uses $\frac{1}{3}$ cup of candy corn. Leo makes 2 batches. How many cups of candy corn does Leo use?

Halloween Math · 16

Omar buys a costume mask for $11.25 and pays with a $20 bill. How much change does Omar get?

Halloween Math · 10

ANSWER

$31.40

Halloween Math · 9

ANSWER

$2.40

Halloween Math · 12

ANSWER

126

Halloween Math · 11

ANSWER

$39.40

Halloween Math · 14

ANSWER

3

Halloween Math · 13

ANSWER

48

Halloween Math · 16

ANSWER

$8.75

Halloween Math · 15

ANSWER

$$\frac{2}{3}$$

Halloween Math · 17

Leo buys a pumpkin for $5.15 and pays with a $10 bill. How much change does Leo get?

Halloween Math · 18

One batch of a recipe uses $\frac{1}{3}$ cup of candy corn. Omar makes 3 batches. How many cups of candy corn does Omar use?

Halloween Math · 19

One bag of candy costs $4.95. Ava buys 3 bags of candy. How much does Ava spend?

Halloween Math · 20

One bag of candy costs $7.50. Omar buys 5 bags of candy. How much does Omar spend?

Halloween Math · 21

A costume box is 4 inches long, 7 inches wide and 2 inches tall. What is its volume in cubic inches?

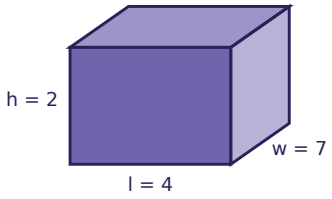

Halloween Math · 22

One batch of a recipe uses $\frac{1}{2}$ cup of candy corn. Ella makes 2 batches. How many cups of candy corn does Ella use?

Halloween Math · 23

A costume box is 8 inches long, 7 inches wide and 4 inches tall. What is its volume in cubic inches?

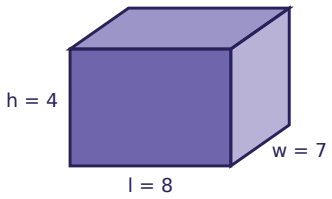

Halloween Math · 24

Mia buys a bag of candy for $5.65 and pays with a $10 bill. How much change does Mia get?

Halloween Math · 18

ANSWER

1

Halloween Math · 17

ANSWER

$4.85

Halloween Math · 20

ANSWER

$37.50

Halloween Math · 19

ANSWER

$14.85

Halloween Math · 22

ANSWER

1

Halloween Math · 21

ANSWER

56

Halloween Math · 24

ANSWER

$4.35

Halloween Math · 23

ANSWER

224