Task card 1 Graphing Points & Coordinate Probl...

Which point is located at (6, 4)?

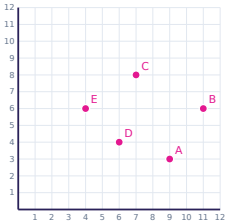

Task card 2 Graphing Points & Coordinate Probl...

How many units apart are points A and B?

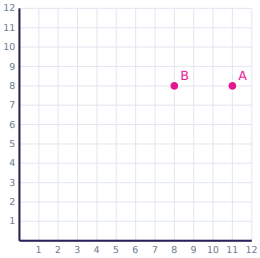

Task card 3 Graphing Points & Coordinate Probl...

Which point is located at (7, 7)?

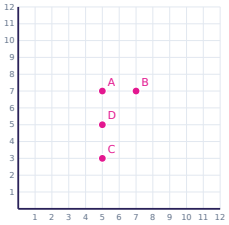

Task card 4 Graphing Points & Coordinate Probl...

How many units apart are points A and B?

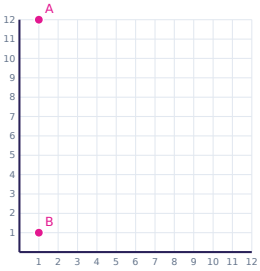

Task card 5 Graphing Points & Coordinate Probl...

Which point is located at (5, 2)?

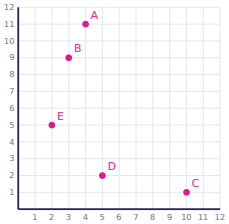

Task card 6 Graphing Points & Coordinate Probl...

How many units apart are points A and B?

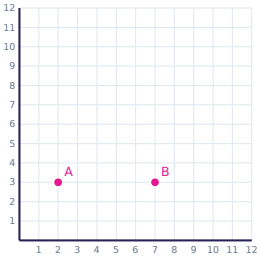

Task card 7 Graphing Points & Coordinate Probl...

Which point is located at (5, 5)?

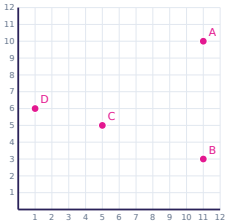

Task card 8 Graphing Points & Coordinate Probl...

How many units apart are points A and B?

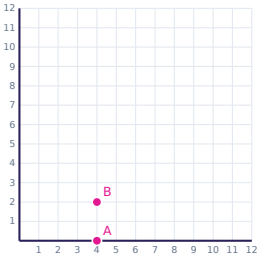

Task card 9 Graphing Points & Coordinate Probl...

Which point is located at (6, 3)?

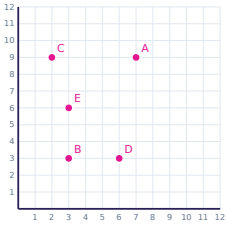

Task card 10 Graphing Points & Coordinate Probl...

How many units apart are points A and B?

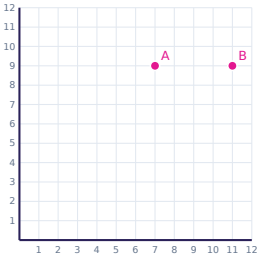

Task card 11 Graphing Points & Coordinate Probl...

Which point is located at (5, 9)?

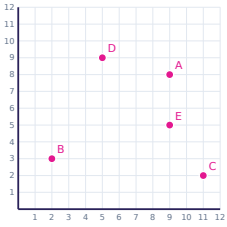

Task card 12 Graphing Points & Coordinate Probl...

How many units apart are points A and B?

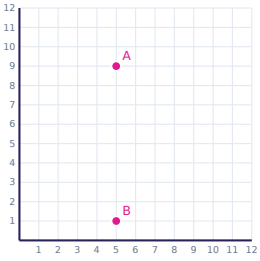

Task card 13 Graphing Points & Coordinate Probl...

Which point is located at (5, 11)?

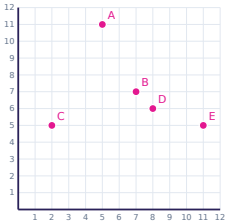

Task card 14 Graphing Points & Coordinate Probl...

How many units apart are points A and B?

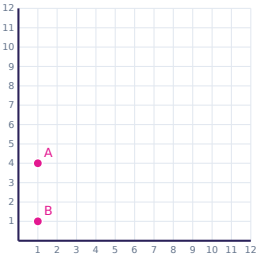

Task card 15 Graphing Points & Coordinate Probl...

Which point is located at (7, 5)?

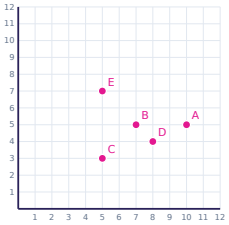

Task card 16 Graphing Points & Coordinate Probl...

How many units apart are points A and B?

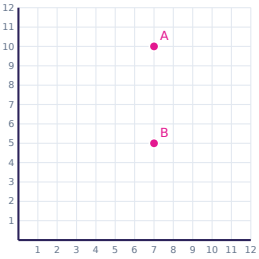

Task card 17 Graphing Points & Coordinate Probl...

Which point is located at (4, 9)?

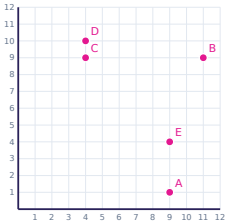

Task card 18 Graphing Points & Coordinate Probl...

How many units apart are points A and B?

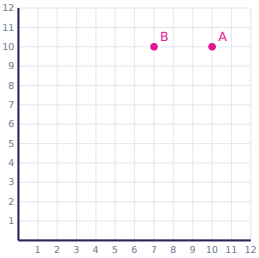

Task card 19 Graphing Points & Coordinate Probl...

Which point is located at (6, 11)?

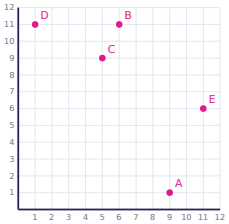

Task card 20 Graphing Points & Coordinate Probl...

How many units apart are points A and B?

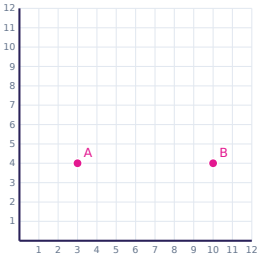

Task card 21 Graphing Points & Coordinate Probl...

Which point is located at (8, 7)?

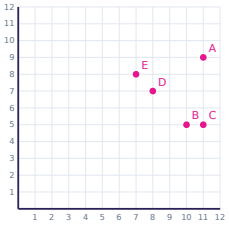

Task card 22 Graphing Points & Coordinate Probl...

How many units apart are points A and B?

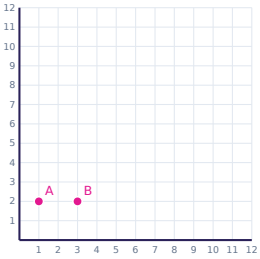

Task card 23 Graphing Points & Coordinate Probl...

Which point is located at (7, 8)?

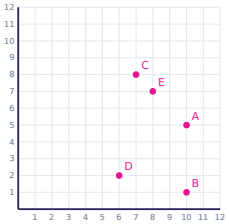

Task card 24 Graphing Points & Coordinate Probl...

How many units apart are points A and B?

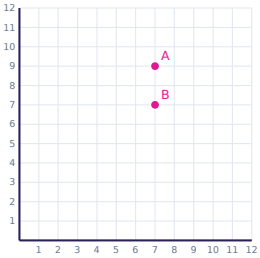

Graphing Points & Coordinate Problems Task Cards

Recording sheet · Grade 5 · Use the coordinate grid. Write points as (x, y).

Scan to check your answers

Name: _____ Date: _____

1	2	3	4
5	6	7	8
9	10	11	12
13	14	15	16
17	18	19	20
21	22	23	24

Graphing Points & Coordinate Problems Task Cards: Answer Key

Grade 5 · Hard

The answers online

1. D	**2.** 3	**3.** B
4. 11	**5.** D	**6.** 5
7. C	**8.** 2	**9.** D
10. 4	**11.** D	**12.** 8
13. A	**14.** 3	**15.** B
16. 5	**17.** C	**18.** 3
19. B	**20.** 7	**21.** D
22. 2	**23.** C	**24.** 2