Task card 1 Graphing Points & Coordinate Probl...

Which point is located at (1, 9)?

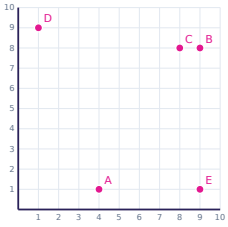

Task card 2 Graphing Points & Coordinate Probl...

How many units apart are points A and B?

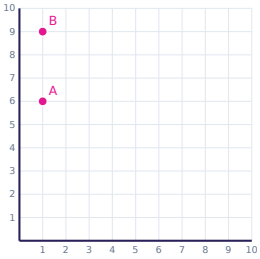

Task card 3 Graphing Points & Coordinate Probl...

What are the coordinates of point C?

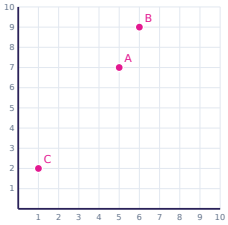

Task card 4 Graphing Points & Coordinate Probl...

What are the coordinates of point C?

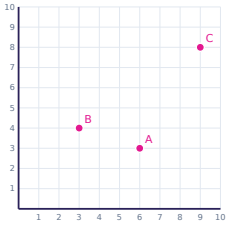

Task card 5 Graphing Points & Coordinate Probl...

Which point is located at (1, 6)?

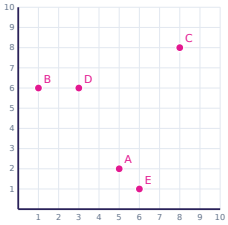

Task card 6 Graphing Points & Coordinate Probl...

How many units apart are points A and B?

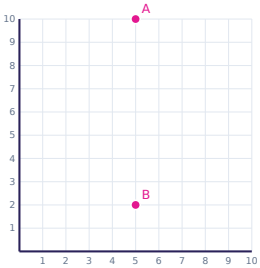

Task card 7 Graphing Points & Coordinate Probl...

Which point is located at (8, 3)?

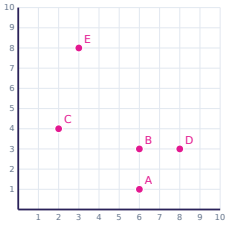

Task card 8 Graphing Points & Coordinate Probl...

How many units apart are points A and B?

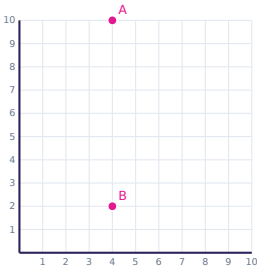

Task card 9 Graphing Points & Coordinate Probl...

What are the coordinates of point B?

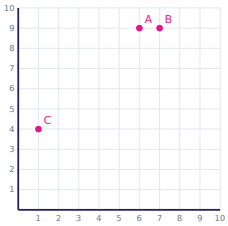

Task card 10 Graphing Points & Coordinate Probl...

What are the coordinates of point C?

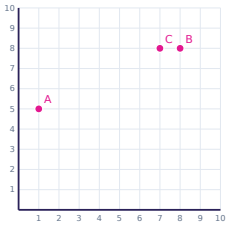

Task card 11 Graphing Points & Coordinate Probl...

Which point is located at (7, 7)?

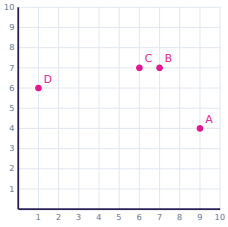

Task card 12 Graphing Points & Coordinate Probl...

How many units apart are points A and B?

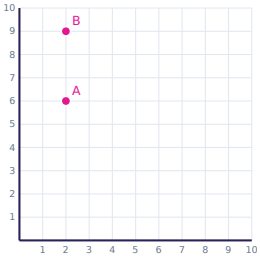

Task card 13 Graphing Points & Coordinate Probl...

Which point is located at (1, 1)?

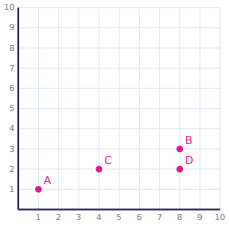

Task card 14 Graphing Points & Coordinate Probl...

How many units apart are points A and B?

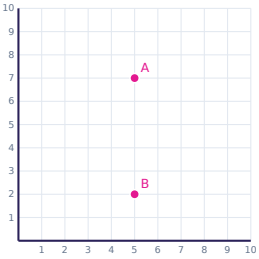

Task card 15 Graphing Points & Coordinate Probl...

Which point is located at (9, 9)?

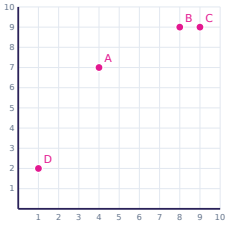

Task card 16 Graphing Points & Coordinate Probl...

How many units apart are points A and B?

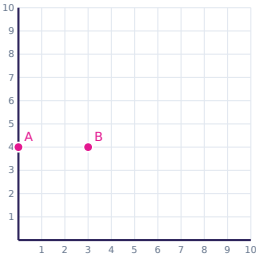

Task card 17 Graphing Points & Coordinate Probl...

Which point is located at (6, 1)?

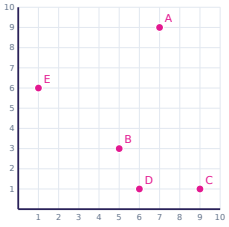

Task card 18 Graphing Points & Coordinate Probl...

How many units apart are points A and B?

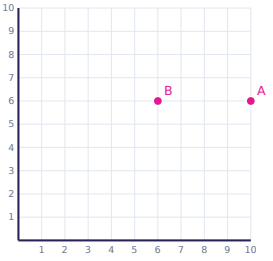

Task card 19 Graphing Points & Coordinate Probl...

What are the coordinates of point B?

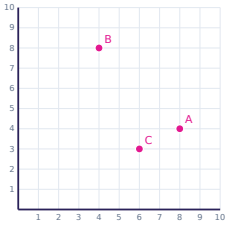

Task card 20 Graphing Points & Coordinate Probl...

What are the coordinates of point C?

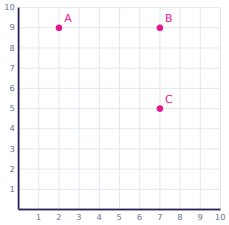

Task card 21 Graphing Points & Coordinate Probl...

Which point is located at (4, 2)?

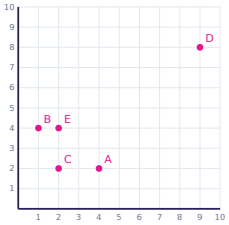

Task card 22 Graphing Points & Coordinate Probl...

How many units apart are points A and B?

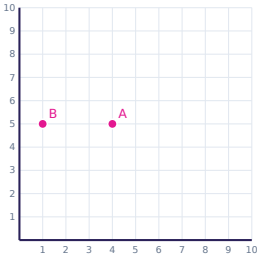

Task card 23 Graphing Points & Coordinate Probl...

Which point is located at (2, 2)?

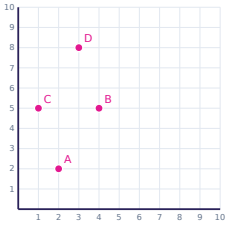

Task card 24 Graphing Points & Coordinate Probl...

How many units apart are points A and B?

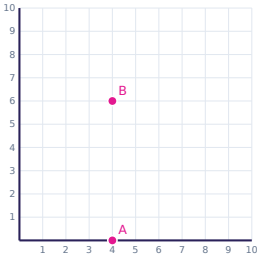

Graphing Points & Coordinate Problems Task Cards

Recording sheet · Grade 5 · Use the coordinate grid. Write points as (x, y).

Scan to check your answers

Name: _____ Date: _____

1	2	3	4
5	6	7	8
9	10	11	12
13	14	15	16
17	18	19	20
21	22	23	24

Graphing Points & Coordinate Problems Task Cards: Answer Key

Grade 5 · Easy

The answers online

1. D	**2.** 3	**3.** (1, 2)
4. (9, 8)	**5.** B	**6.** 8
7. D	**8.** 8	**9.** (7, 9)
10. (7, 8)	**11.** B	**12.** 3
13. A	**14.** 5	**15.** C
16. 3	**17.** D	**18.** 4
19. (4, 8)	**20.** (7, 5)	**21.** A
22. 3	**23.** A	**24.** 6