Graphing Points & Coordinate Problems · 1

Which point is located at (5, 1)?

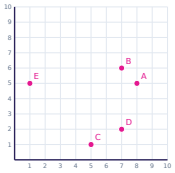

Graphing Points & Coordinate Problems · 2

How many units apart are points A and B?

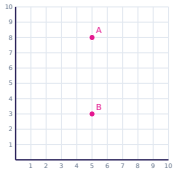

Graphing Points & Coordinate Problems · 3

Which point is located at (7, 3)?

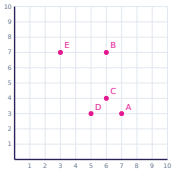

Graphing Points & Coordinate Problems · 4

How many units apart are points A and B?

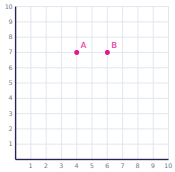

Graphing Points & Coordinate Problems · 5

Which point is located at (7, 9)?

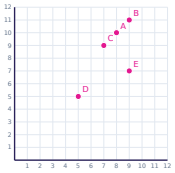

Graphing Points & Coordinate Problems · 6

How many units apart are points A and B?

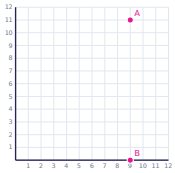

Graphing Points & Coordinate Problems · 7

Which point is located at (8, 4)?

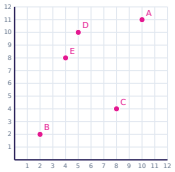

Graphing Points & Coordinate Problems · 8

How many units apart are points A and B?

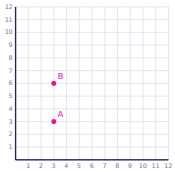

Graphing Points & Coordinate Problems · 2

ANSWER

5

Graphing Points & Coordinate Problems · 1

ANSWER

C

Graphing Points & Coordinate Problems · 4

ANSWER

2

Graphing Points & Coordinate Problems · 3

ANSWER

A

Graphing Points & Coordinate Problems · 6

ANSWER

11

Graphing Points & Coordinate Problems · 5

ANSWER

C

Graphing Points & Coordinate Problems · 8

ANSWER

3

Graphing Points & Coordinate Problems · 7

ANSWER

C

Graphing Points & Coordinate Problems · 9

Which point is located at (9, 5)?

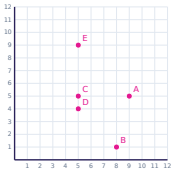

Graphing Points & Coordinate Problems · 10

How many units apart are points A and B?

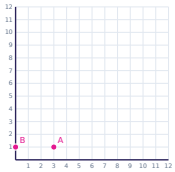

Graphing Points & Coordinate Problems · 11

Which point is located at (2, 6)?

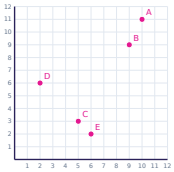

Graphing Points & Coordinate Problems · 12

How many units apart are points A and B?

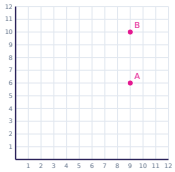

Graphing Points & Coordinate Problems · 13

Which point is located at (3, 3)?

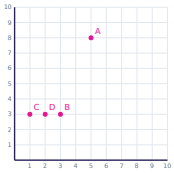

Graphing Points & Coordinate Problems · 14

How many units apart are points A and B?

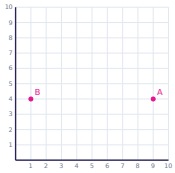

Graphing Points & Coordinate Problems · 15

Which point is located at (5, 6)?

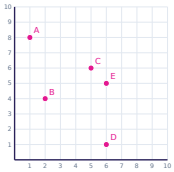

Graphing Points & Coordinate Problems · 16

How many units apart are points A and B?

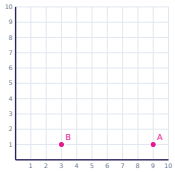

Graphing Points & Coordinate Problems · 10

ANSWER

3

Graphing Points & Coordinate Problems · 9

ANSWER

A

Graphing Points & Coordinate Problems · 12

ANSWER

4

Graphing Points & Coordinate Problems · 11

ANSWER

D

Graphing Points & Coordinate Problems · 14

ANSWER

8

Graphing Points & Coordinate Problems · 13

ANSWER

B

Graphing Points & Coordinate Problems · 16

ANSWER

6

Graphing Points & Coordinate Problems · 15

ANSWER

C

Graphing Points & Coordinate Problems · 17

Which point is located at (1, 1)?

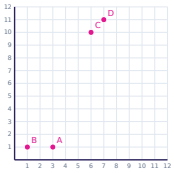

Graphing Points & Coordinate Problems · 18

How many units apart are points A and B?

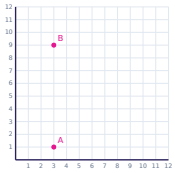

Graphing Points & Coordinate Problems · 19

Which point is located at (4, 3)?

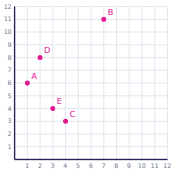

Graphing Points & Coordinate Problems · 20

How many units apart are points A and B?

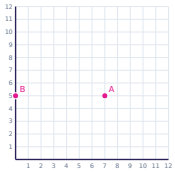

Graphing Points & Coordinate Problems · 21

Which point is located at (8, 8)?

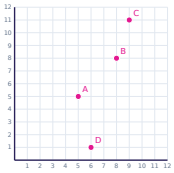

Graphing Points & Coordinate Problems · 22

How many units apart are points A and B?

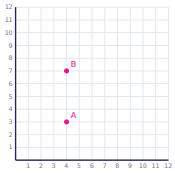

Graphing Points & Coordinate Problems · 23

Which point is located at (4, 9)?

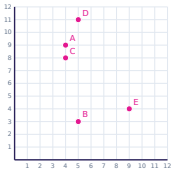

Graphing Points & Coordinate Problems · 24

How many units apart are points A and B?

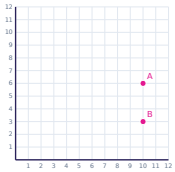

Graphing Points & Coordinate Problems · 18

ANSWER

8

Graphing Points & Coordinate Problems · 17

ANSWER

B

Graphing Points & Coordinate Problems · 20

ANSWER

7

Graphing Points & Coordinate Problems · 19

ANSWER

C

Graphing Points & Coordinate Problems · 22

ANSWER

4

Graphing Points & Coordinate Problems · 21

ANSWER

B

Graphing Points & Coordinate Problems · 24

ANSWER

3

Graphing Points & Coordinate Problems · 23

ANSWER

A