Graphing Points & Coordinate Problems · 1

## Which point is located at (5, 1)?

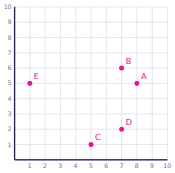


Graphing Points & Coordinate Problems · 2

## How many units apart are points A and B?

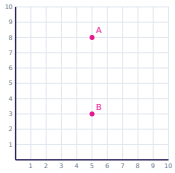


Graphing Points & Coordinate Problems · 3

## Which point is located at (7, 3)?

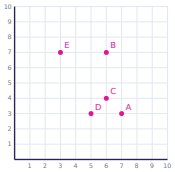


Graphing Points & Coordinate Problems · 4

## How many units apart are points A and B?

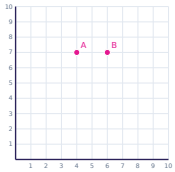


Graphing Points & Coordinate Problems · 5

## Which point is located at (7, 9)?

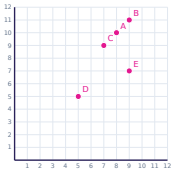


Graphing Points & Coordinate Problems · 6

## How many units apart are points A and B?

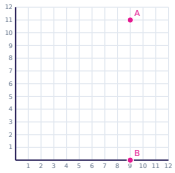


Graphing Points & Coordinate Problems · 7

## Which point is located at (8, 4)?

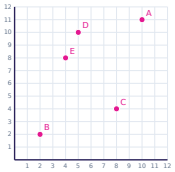


Graphing Points & Coordinate Problems · 8

## How many units apart are points A and B?

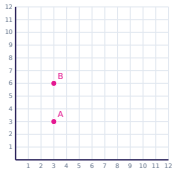

Graphing Points & Coordinate Problems · 2

**ANSWER**

**5**

Graphing Points & Coordinate Problems · 1

**ANSWER**

**C**

Graphing Points & Coordinate Problems · 4

**ANSWER**

**2**

Graphing Points & Coordinate Problems · 3

**ANSWER**

**A**

Graphing Points & Coordinate Problems · 6

**ANSWER**

**11**

Graphing Points & Coordinate Problems · 5

**ANSWER**

**C**

Graphing Points & Coordinate Problems · 8

**ANSWER**

**3**

Graphing Points & Coordinate Problems · 7

**ANSWER**

**C**

Graphing Points & Coordinate Problems · 9

## Which point is located at (9, 5)?

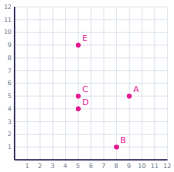


Graphing Points & Coordinate Problems · 10

## How many units apart are points A and B?

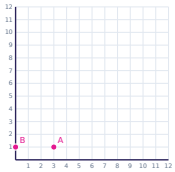


Graphing Points & Coordinate Problems · 11

## Which point is located at (2, 6)?

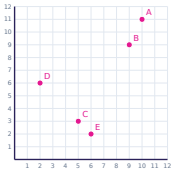


Graphing Points & Coordinate Problems · 12

## How many units apart are points A and B?

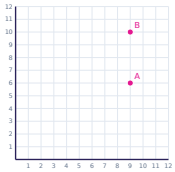


Graphing Points & Coordinate Problems · 13

## Which point is located at (3, 3)?

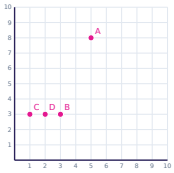


Graphing Points & Coordinate Problems · 14

## How many units apart are points A and B?

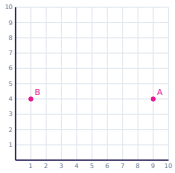


Graphing Points & Coordinate Problems · 15

## Which point is located at (5, 6)?

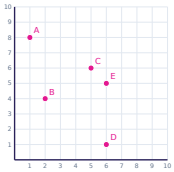


Graphing Points & Coordinate Problems · 16

## How many units apart are points A and B?

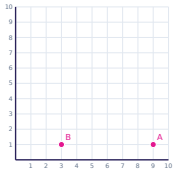

Graphing Points & Coordinate Problems · 10

**ANSWER**

**3**

Graphing Points & Coordinate Problems · 9

**ANSWER**

**A**

Graphing Points & Coordinate Problems · 12

**ANSWER**

**4**

Graphing Points & Coordinate Problems · 11

**ANSWER**

**D**

Graphing Points & Coordinate Problems · 14

**ANSWER**

**8**

Graphing Points & Coordinate Problems · 13

**ANSWER**

**B**

Graphing Points & Coordinate Problems · 16

**ANSWER**

**6**

Graphing Points & Coordinate Problems · 15

**ANSWER**

**C**

Graphing Points & Coordinate Problems · 17

## Which point is located at (1, 1)?

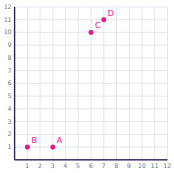


Graphing Points & Coordinate Problems · 18

## How many units apart are points A and B?

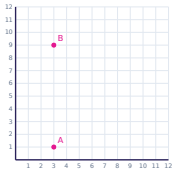


Graphing Points & Coordinate Problems · 19

## Which point is located at (4, 3)?

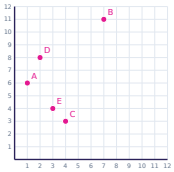


Graphing Points & Coordinate Problems · 20

## How many units apart are points A and B?

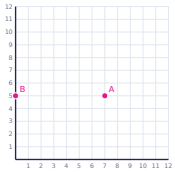


Graphing Points & Coordinate Problems · 21

## Which point is located at (8, 8)?

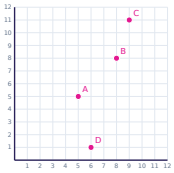


Graphing Points & Coordinate Problems · 22

## How many units apart are points A and B?

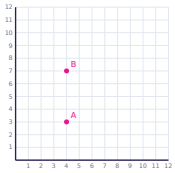


Graphing Points & Coordinate Problems · 23

## Which point is located at (4, 9)?

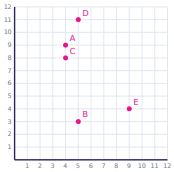


Graphing Points & Coordinate Problems · 24

## How many units apart are points A and B?

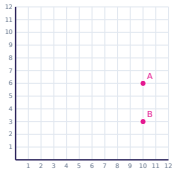

Graphing Points & Coordinate Problems · 18

**ANSWER**

**8**

Graphing Points & Coordinate Problems · 17

**ANSWER**

**B**

Graphing Points & Coordinate Problems · 20

**ANSWER**

**7**

Graphing Points & Coordinate Problems · 19

**ANSWER**

**C**

Graphing Points & Coordinate Problems · 22

**ANSWER**

**4**

Graphing Points & Coordinate Problems · 21

**ANSWER**

**B**

Graphing Points & Coordinate Problems · 24

**ANSWER**

**3**

Graphing Points & Coordinate Problems · 23

**ANSWER**

**A**