Graphing Points & Coordinate Problems · 1

Which point is located at (1, 9)?

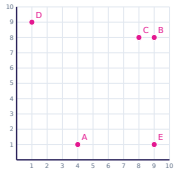

Graphing Points & Coordinate Problems · 2

How many units apart are points A and B?

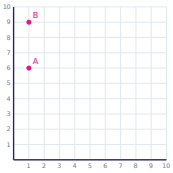

Graphing Points & Coordinate Problems · 3

What are the coordinates of point C?

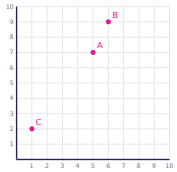

Graphing Points & Coordinate Problems · 4

What are the coordinates of point C?

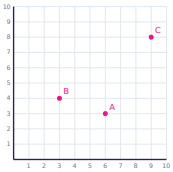

Graphing Points & Coordinate Problems · 5

Which point is located at (1, 6)?

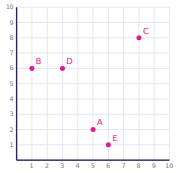

Graphing Points & Coordinate Problems · 6

How many units apart are points A and B?

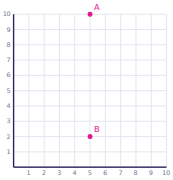

Graphing Points & Coordinate Problems · 7

Which point is located at (8, 3)?

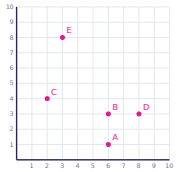

Graphing Points & Coordinate Problems · 8

How many units apart are points A and B?

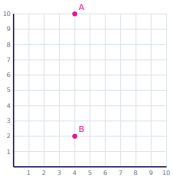

Graphing Points & Coordinate Problems · 2

ANSWER

3

Graphing Points & Coordinate Problems · 1

ANSWER

D

Graphing Points & Coordinate Problems · 4

ANSWER

(9, 8)

Graphing Points & Coordinate Problems · 3

ANSWER

(1, 2)

Graphing Points & Coordinate Problems · 6

ANSWER

8

Graphing Points & Coordinate Problems · 5

ANSWER

B

Graphing Points & Coordinate Problems · 8

ANSWER

8

Graphing Points & Coordinate Problems · 7

ANSWER

D

Graphing Points & Coordinate Problems · 9

What are the coordinates of point B?

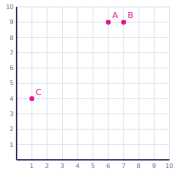

Graphing Points & Coordinate Problems · 10

What are the coordinates of point C?

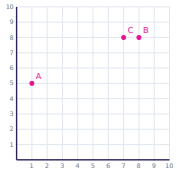

Graphing Points & Coordinate Problems · 11

Which point is located at (7, 7)?

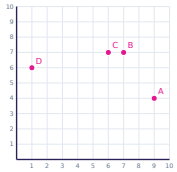

Graphing Points & Coordinate Problems · 12

How many units apart are points A and B?

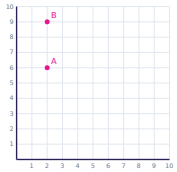

Graphing Points & Coordinate Problems · 13

Which point is located at (1, 1)?

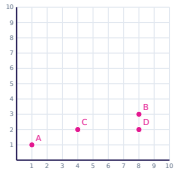

Graphing Points & Coordinate Problems · 14

How many units apart are points A and B?

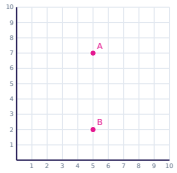

Graphing Points & Coordinate Problems · 15

Which point is located at (9, 9)?

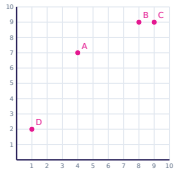

Graphing Points & Coordinate Problems · 16

How many units apart are points A and B?

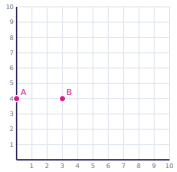

Graphing Points & Coordinate Problems · 10

ANSWER

(7, 8)

Graphing Points & Coordinate Problems · 9

ANSWER

(7, 9)

Graphing Points & Coordinate Problems · 12

ANSWER

3

Graphing Points & Coordinate Problems · 11

ANSWER

B

Graphing Points & Coordinate Problems · 14

ANSWER

5

Graphing Points & Coordinate Problems · 13

ANSWER

A

Graphing Points & Coordinate Problems · 16

ANSWER

3

Graphing Points & Coordinate Problems · 15

ANSWER

C

Graphing Points & Coordinate Problems · 17

Which point is located at (6, 1)?

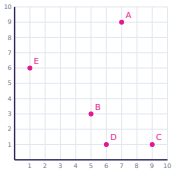

Graphing Points & Coordinate Problems · 18

How many units apart are points A and B?

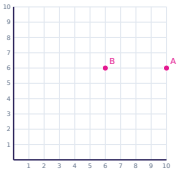

Graphing Points & Coordinate Problems · 19

What are the coordinates of point B?

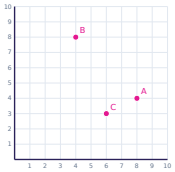

Graphing Points & Coordinate Problems · 20

What are the coordinates of point C?

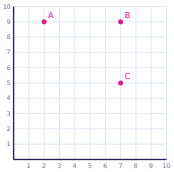

Graphing Points & Coordinate Problems · 21

Which point is located at (4, 2)?

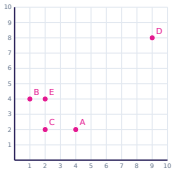

Graphing Points & Coordinate Problems · 22

How many units apart are points A and B?

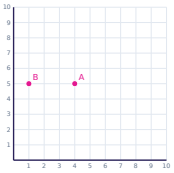

Graphing Points & Coordinate Problems · 23

Which point is located at (2, 2)?

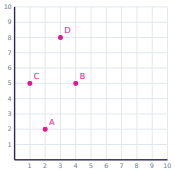

Graphing Points & Coordinate Problems · 24

How many units apart are points A and B?

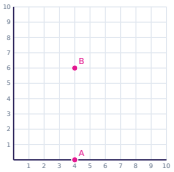

Graphing Points & Coordinate Problems · 18

ANSWER

4

Graphing Points & Coordinate Problems · 17

ANSWER

D

Graphing Points & Coordinate Problems · 20

ANSWER

(7, 5)

Graphing Points & Coordinate Problems · 19

ANSWER

(4, 8)

Graphing Points & Coordinate Problems · 22

ANSWER

3

Graphing Points & Coordinate Problems · 21

ANSWER

A

Graphing Points & Coordinate Problems · 24

ANSWER

6

Graphing Points & Coordinate Problems · 23

ANSWER

A