Area with Fraction Side Lengths · 1

The large square is 1 unit long and 1 unit wide. What is the area of the shaded rectangle in square units?

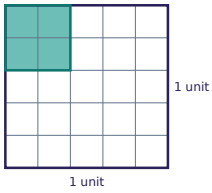

Area with Fraction Side Lengths · 2

Find the area of the rectangle in square centimeters.



Area with Fraction Side Lengths · 3

The large square is 1 unit long and 1 unit wide. What is the area of the shaded rectangle in square units?

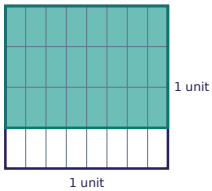

Area with Fraction Side Lengths · 4

Find the area of the rectangle in square yards.



Area with Fraction Side Lengths · 5

Find the area of the rectangle in square meters.

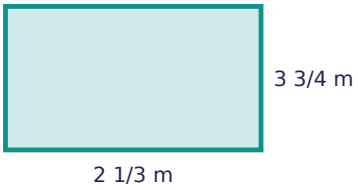

Area with Fraction Side Lengths · 6

The large square is 1 unit long and 1 unit wide. What is the area of the shaded rectangle in square units?

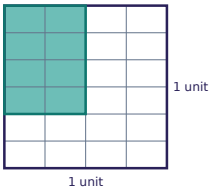

Area with Fraction Side Lengths · 7

Find the area of the rectangle in square feet.



Area with Fraction Side Lengths · 8

A tile is $3\frac{3}{8}$ inches long and $1\frac{3}{4}$ inches wide. What is its area in square inches?

Area with Fraction Side Lengths · 2

ANSWER

$1\frac{2}{7}$

Area with Fraction Side Lengths · 1

ANSWER

$\frac{4}{25}$

Area with Fraction Side Lengths · 4

ANSWER

$1\frac{3}{8}$

Area with Fraction Side Lengths · 3

ANSWER

$\frac{3}{4}$

Area with Fraction Side Lengths · 6

ANSWER

$\frac{1}{3}$

Area with Fraction Side Lengths · 5

ANSWER

$8\frac{3}{4}$

Area with Fraction Side Lengths · 8

ANSWER

$5\frac{29}{32}$

Area with Fraction Side Lengths · 7

ANSWER

$3\frac{7}{16}$

Area with Fraction Side Lengths · 9

The large square is 1 unit long and 1 unit wide. What is the area of the shaded rectangle in square units?

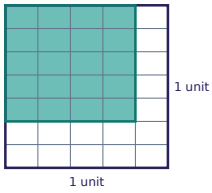

Area with Fraction Side Lengths · 10

Find the area of the rectangle in square inches.



Area with Fraction Side Lengths · 11

The large square is 1 unit long and 1 unit wide. What is the area of the shaded rectangle in square units?

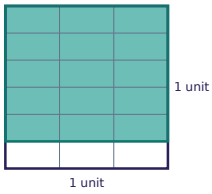

Area with Fraction Side Lengths · 12

Find the area of the rectangle in square yards.



Area with Fraction Side Lengths · 13

Find the area of the rectangle in square meters.

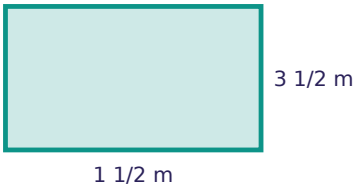

Area with Fraction Side Lengths · 14

The large square is 1 unit long and 1 unit wide. What is the area of the shaded rectangle in square units?

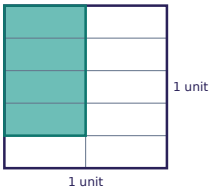

Area with Fraction Side Lengths · 15

Find the area of the rectangle in square centimeters.



Area with Fraction Side Lengths · 16

A garden bed is $2\frac{1}{5}$ yards long and $\frac{1}{2}$ yard wide. What is its area in square yards?

Area with Fraction Side Lengths · 10

ANSWER

$12\frac{5}{36}$

Area with Fraction Side Lengths · 9

ANSWER

$\frac{4}{7}$

Area with Fraction Side Lengths · 12

ANSWER

$5\frac{1}{2}$

Area with Fraction Side Lengths · 11

ANSWER

$\frac{5}{6}$

Area with Fraction Side Lengths · 14

ANSWER

$\frac{2}{5}$

Area with Fraction Side Lengths · 13

ANSWER

$5\frac{1}{4}$

Area with Fraction Side Lengths · 16

ANSWER

$1\frac{1}{10}$

Area with Fraction Side Lengths · 15

ANSWER

$1\frac{31}{35}$

Area with Fraction Side Lengths · 17

The large square is 1 unit long and 1 unit wide. What is the area of the shaded rectangle in square units?

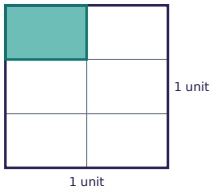

Area with Fraction Side Lengths · 18

Find the area of the rectangle in square meters.



Area with Fraction Side Lengths · 19

The large square is 1 unit long and 1 unit wide. What is the area of the shaded rectangle in square units?

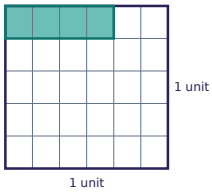

Area with Fraction Side Lengths · 20

Find the area of the rectangle in square meters.



Area with Fraction Side Lengths · 21

Find the area of the rectangle in square feet.



Area with Fraction Side Lengths · 22

The large square is 1 unit long and 1 unit wide. What is the area of the shaded rectangle in square units?

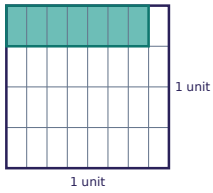

Area with Fraction Side Lengths · 23

Find the area of the rectangle in square yards.



Area with Fraction Side Lengths · 24

A garden bed is 6 yards long and $3\frac{5}{7}$ yards wide. What is its area in square yards?

Area with Fraction Side Lengths · 18

ANSWER

$$12$$

Area with Fraction Side Lengths · 17

ANSWER

$$\frac{1}{6}$$

Area with Fraction Side Lengths · 20

ANSWER

$$3\,\frac{33}{40}$$

Area with Fraction Side Lengths · 19

ANSWER

$$\frac{2}{15}$$

Area with Fraction Side Lengths · 22

ANSWER

$$\frac{7}{32}$$

Area with Fraction Side Lengths · 21

ANSWER

$$7\,\frac{5}{7}$$

Area with Fraction Side Lengths · 24

ANSWER

$$22\,\frac{2}{7}$$

Area with Fraction Side Lengths · 23

ANSWER

$$19\,\frac{1}{2}$$