Area with Fraction Side Lengths · 1

The large square is 1 unit long and 1 unit wide. What is the area of the shaded rectangle in square units?

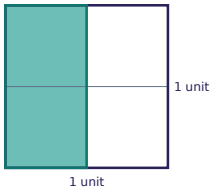

Area with Fraction Side Lengths · 2

Find the area of the rectangle in square inches.

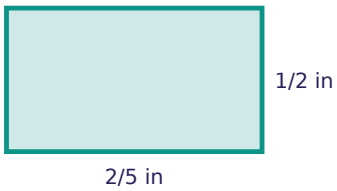

Area with Fraction Side Lengths · 3

The large square is 1 unit long and 1 unit wide. What is the area of the shaded rectangle in square units?

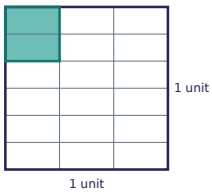

Area with Fraction Side Lengths · 4

Find the area of the rectangle in square meters.



Area with Fraction Side Lengths · 5

Find the area of the rectangle in square centimeters.

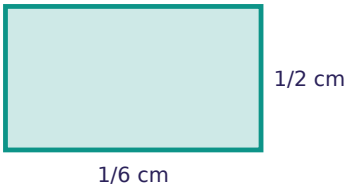

Area with Fraction Side Lengths · 6

The large square is 1 unit long and 1 unit wide. What is the area of the shaded rectangle in square units?

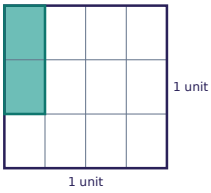

Area with Fraction Side Lengths · 7

Find the area of the rectangle in square centimeters.



Area with Fraction Side Lengths · 8

A garden bed is $\frac{3}{4}$ yard long and $\frac{3}{5}$ yard wide. What is its area in square yards?

Area with Fraction Side Lengths · 2

ANSWER

$\frac{1}{5}$

Area with Fraction Side Lengths · 1

ANSWER

$\frac{1}{2}$

Area with Fraction Side Lengths · 4

ANSWER

$\frac{1}{3}$

Area with Fraction Side Lengths · 3

ANSWER

$\frac{1}{9}$

Area with Fraction Side Lengths · 6

ANSWER

$\frac{1}{6}$

Area with Fraction Side Lengths · 5

ANSWER

$\frac{1}{12}$

Area with Fraction Side Lengths · 8

ANSWER

$\frac{9}{20}$

Area with Fraction Side Lengths · 7

ANSWER

$\frac{1}{10}$

Area with Fraction Side Lengths · 9

The large square is 1 unit long and 1 unit wide. What is the area of the shaded rectangle in square units?

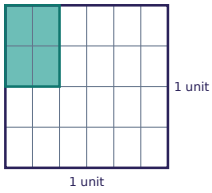

Area with Fraction Side Lengths · 10

Find the area of the rectangle in square yards.



Area with Fraction Side Lengths · 11

The large square is 1 unit long and 1 unit wide. What is the area of the shaded rectangle in square units?

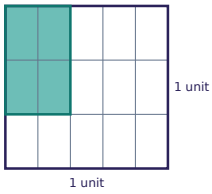

Area with Fraction Side Lengths · 12

Find the area of the rectangle in square centimeters.



Area with Fraction Side Lengths · 13

Find the area of the rectangle in square centimeters.

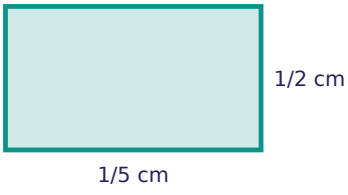

Area with Fraction Side Lengths · 14

The large square is 1 unit long and 1 unit wide. What is the area of the shaded rectangle in square units?

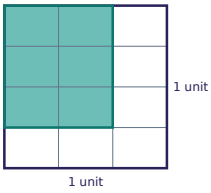

Area with Fraction Side Lengths · 15

Find the area of the rectangle in square inches.



Area with Fraction Side Lengths · 16

A poster is $\frac{4}{5}$ foot long and $\frac{5}{6}$ foot wide. What is its area in square feet?

Area with Fraction Side Lengths · 10

ANSWER

$\frac{5}{56}$

Area with Fraction Side Lengths · 9

ANSWER

$\frac{1}{6}$

Area with Fraction Side Lengths · 12

ANSWER

$\frac{1}{48}$

Area with Fraction Side Lengths · 11

ANSWER

$\frac{4}{15}$

Area with Fraction Side Lengths · 14

ANSWER

$\frac{1}{2}$

Area with Fraction Side Lengths · 13

ANSWER

$\frac{1}{10}$

Area with Fraction Side Lengths · 16

ANSWER

$\frac{2}{3}$

Area with Fraction Side Lengths · 15

ANSWER

$\frac{1}{48}$

Area with Fraction Side Lengths · 17

The large square is 1 unit long and 1 unit wide. What is the area of the shaded rectangle in square units?

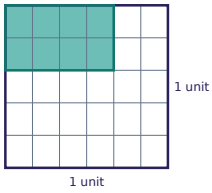

Area with Fraction Side Lengths · 18

Find the area of the rectangle in square inches.

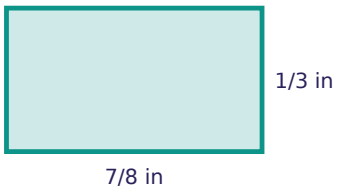

Area with Fraction Side Lengths · 19

The large square is 1 unit long and 1 unit wide. What is the area of the shaded rectangle in square units?



Area with Fraction Side Lengths · 20

Find the area of the rectangle in square meters.



Area with Fraction Side Lengths · 21

Find the area of the rectangle in square meters.



Area with Fraction Side Lengths · 22

The large square is 1 unit long and 1 unit wide. What is the area of the shaded rectangle in square units?

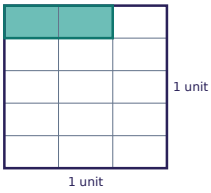

Area with Fraction Side Lengths · 23

Find the area of the rectangle in square yards.



Area with Fraction Side Lengths · 24

A garden bed is $\frac{1}{2}$ yard long and $\frac{1}{2}$ yard wide. What is its area in square yards?

Area with Fraction Side Lengths · 18

ANSWER

$\frac{7}{24}$

Area with Fraction Side Lengths · 17

ANSWER

$\frac{4}{15}$

Area with Fraction Side Lengths · 20

ANSWER

$\frac{5}{16}$

Area with Fraction Side Lengths · 19

ANSWER

$\frac{1}{4}$

Area with Fraction Side Lengths · 22

ANSWER

$\frac{2}{15}$

Area with Fraction Side Lengths · 21

ANSWER

$\frac{5}{16}$

Area with Fraction Side Lengths · 24

ANSWER

$\frac{1}{4}$

Area with Fraction Side Lengths · 23

ANSWER

$\frac{5}{24}$