Task card 1 Easter Math

One batch of a recipe uses $\frac{3}{4}$ cup of shredded carrot. Leo makes 3 batches. How many cups of shredded carrot does Leo use?

Task card 2 Easter Math

Zoe buys a chocolate bunny for $5.95 and pays with a $10 bill. How much change does Zoe get?

Task card 3 Easter Math

One batch of a recipe uses $\frac{1}{4}$ cup of shredded carrot. Omar makes 5 batches. How many cups of shredded carrot does Omar use?

Task card 4 Easter Math

One bag of jelly beans costs $4.10. Leo buys 7 bags of jelly beans. How much does Leo spend?

Task card 5 Easter Math

One chocolate bunny costs $5.75. Lily buys 3 chocolate bunnies. How much does Lily spend?

Task card 6 Easter Math

A gift box is 7 inches long, 6 inches wide and 2 inches tall. What is its volume in cubic inches?

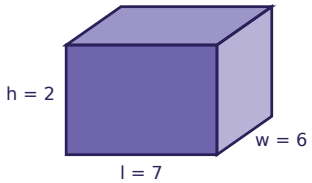

Task card 7 Easter Math

A gift box is 8 inches long, 7 inches wide and 6 inches tall. What is its volume in cubic inches?

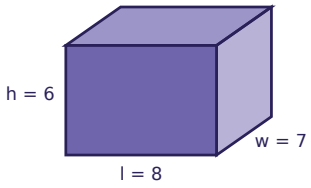

Task card 8 Easter Math

Sam buys a chocolate bunny for $6.15 and pays with a $10 bill. How much change does Sam get?

Task card 9 Easter Math

A gift box is 11 inches long, 3 inches wide and 8 inches tall. What is its volume in cubic inches?

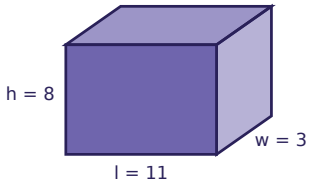

Task card 10 Easter Math

A gift box is 9 inches long, 3 inches wide and 7 inches tall. What is its volume in cubic inches?

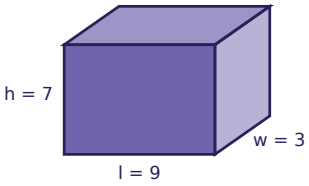

Task card 11 Easter Math

Ella buys a bag of jelly beans for $2.34 and pays with a $10 bill. How much change does Ella get?

Task card 12 Easter Math

One batch of a recipe uses $\frac{2}{3}$ cup of shredded carrot. Ava makes 3 batches. How many cups of shredded carrot does Ava use?

Task card 13 Easter Math

One chocolate bunny costs $7.65. Zoe buys 2 chocolate bunnies. How much does Zoe spend?

Task card 14 Easter Math

One batch of a recipe uses $\frac{2}{3}$ cup of shredded carrot. Leo makes 2 batches. How many cups of shredded carrot does Leo use?

Task card 15 Easter Math

One bag of jelly beans costs $3.55. Ella buys 6 bags of jelly beans. How much does Ella spend?

Task card 16 Easter Math

Mia buys a chocolate bunny for $3.44 and pays with a $10 bill. How much change does Mia get?

Task card 17 Easter Math

A gift box is 9 inches long, 8 inches wide and 3 inches tall. What is its volume in cubic inches?

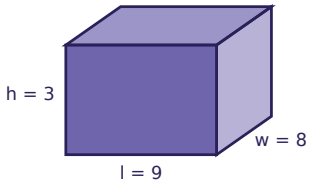

Task card 18 Easter Math

One batch of a recipe uses $\frac{5}{8}$ cup of shredded carrot. Zoe makes 2 batches. How many cups of shredded carrot does Zoe use?

Task card 19 Easter Math

Lily buys a pot of tulips for $7.48 and pays with a $10 bill. How much change does Lily get?

Task card 20 Easter Math

Ava buys a pot of tulips for $10.59 and pays with a $20 bill. How much change does Ava get?

Task card 21 Easter Math

One pot of tulips costs $7.55. Ella buys 4 pots of tulips. How much does Ella spend?

Task card 22 Easter Math

A gift box is 9 inches long, 3 inches wide and 5 inches tall. What is its volume in cubic inches?

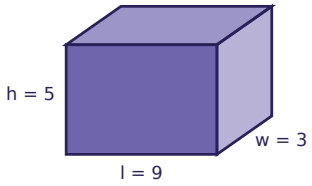

Task card 23 Easter Math

One batch of a recipe uses $\frac{3}{4}$ cup of shredded carrot. Sam makes 2 batches. How many cups of shredded carrot does Sam use?

Task card 24 Easter Math

One pot of tulips costs $11.30. Sam buys 6 pots of tulips. How much does Sam spend?

Easter Math Task Cards

Recording sheet · Grade 5 · Read each story and solve. Write money like $4.50 and fractions like 1 1/2.

Name: _____ Date: _____

Scan to check your answers

1	2	3	4
5	6	7	8
9	10	11	12
13	14	15	16
17	18	19	20
21	22	23	24

Easter Math Task Cards: Answer Key

Grade 5 · Medium

The answers online

1. $2\frac{1}{4}$	**2.** $4.05	**3.** $1\frac{1}{4}$
4. $28.70	**5.** $17.25	**6.** 84
7. 336	**8.** $3.85	**9.** 264
10. 189	**11.** $7.66	**12.** 2
13. $15.30	**14.** $1\frac{1}{3}$	**15.** $21.30
16. $6.56	**17.** 216	**18.** $1\frac{1}{4}$
19. $2.52	**20.** $9.41	**21.** $30.20
22. 135	**23.** $1\frac{1}{2}$	**24.** $67.80