Task card 1 Easter Math

A gift box is 10 inches long, 6 inches wide and 3 inches tall. What is its volume in cubic inches?

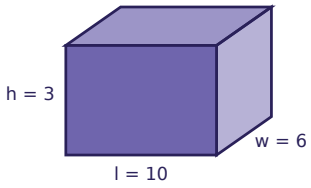

Task card 2 Easter Math

One batch of a recipe uses $\frac{3}{8}$ cup of shredded carrot. Zoe makes 6 batches. How many cups of shredded carrot does Zoe use?

Task card 3 Easter Math

A gift box is 8 inches long, 3 inches wide and 7 inches tall. What is its volume in cubic inches?

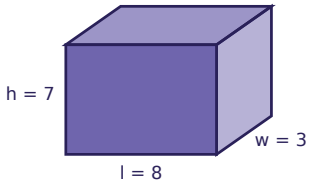

Task card 4 Easter Math

Mia buys a pot of tulips for $5.41 and pays with a $10 bill. How much change does Mia get?

Task card 5 Easter Math

One batch of a recipe uses $\frac{3}{4}$ cup of shredded carrot. Ella makes 2 batches. How many cups of shredded carrot does Ella use?

Task card 6 Easter Math

One bag of jelly beans costs $3.05. Ben buys 4 bags of jelly beans. How much does Ben spend?

Task card 7 Easter Math

One pot of tulips costs $9.55. Leo buys 3 pots of tulips. How much does Leo spend?

Task card 8 Easter Math

Leo buys a pot of tulips for $9.31 and pays with a $10 bill. How much change does Leo get?

Task card 9 Easter Math

Ava buys a pot of tulips for $5.96 and pays with a $10 bill. How much change does Ava get?

Task card 10 Easter Math

One bag of jelly beans costs $4.35. Leo buys 2 bags of jelly beans. How much does Leo spend?

Task card 11 Easter Math

One batch of a recipe uses $\frac{3}{4}$ cup of shredded carrot. Leo makes 5 batches. How many cups of shredded carrot does Leo use?

Task card 12 Easter Math

Leo buys a bag of jelly beans for $2.26 and pays with a $10 bill. How much change does Leo get?

Task card 13 Easter Math

One bag of jelly beans costs $4.45. Lily buys 6 bags of jelly beans. How much does Lily spend?

Task card 14 Easter Math

A gift box is 14 inches long, 4 inches wide and 5 inches tall. What is its volume in cubic inches?

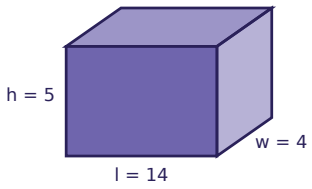

Task card 15 Easter Math

One batch of a recipe uses $\frac{2}{3}$ cup of shredded carrot. Noah makes 3 batches. How many cups of shredded carrot does Noah use?

Task card 16 Easter Math

A gift box is 11 inches long, 4 inches wide and 7 inches tall. What is its volume in cubic inches?

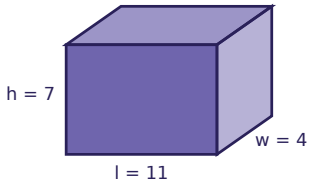

Task card 17 Easter Math

Ava buys a chocolate bunny for $4.69 and pays with a $10 bill. How much change does Ava get?

Task card 18 Easter Math

One batch of a recipe uses $\frac{5}{8}$ cup of shredded carrot. Noah makes 3 batches. How many cups of shredded carrot does Noah use?

Task card 19 Easter Math

One chocolate bunny costs $7.80. Omar buys 2 chocolate bunnies. How much does Omar spend?

Task card 20 Easter Math

One batch of a recipe uses $\frac{5}{8}$ cup of shredded carrot. Ava makes 4 batches. How many cups of shredded carrot does Ava use?

Task card 21 Easter Math

One pot of tulips costs $10.35. Ava buys 4 pots of tulips. How much does Ava spend?

Task card 22 Easter Math

Ava buys a bag of jelly beans for $4.51 and pays with a $10 bill. How much change does Ava get?

Task card 23 Easter Math

A gift box is 12 inches long, 4 inches wide and 8 inches tall. What is its volume in cubic inches?

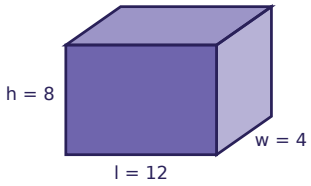

Task card 24 Easter Math

A gift box is 4 inches long, 3 inches wide and 8 inches tall. What is its volume in cubic inches?

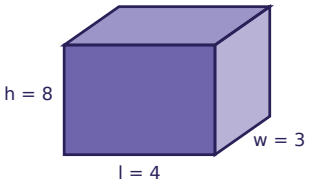

Easter Math Task Cards

Recording sheet · Grade 5 · Read each story and solve. Write money like $4.50 and fractions like 1 1/2.

Name: _____ Date: _____

Scan to check your answers

1	2	3	4
5	6	7	8
9	10	11	12
13	14	15	16
17	18	19	20
21	22	23	24

Easter Math Task Cards: Answer Key

Grade 5 · Hard

The answers online

1. 180	**2.** $2\frac{1}{4}$	**3.** 168
4. $4.59	**5.** $1\frac{1}{2}$	**6.** $12.20
7. $28.65	**8.** $0.69	**9.** $4.04
10. $8.70	**11.** $3\frac{3}{4}$	**12.** $7.74
13. $26.70	**14.** 280	**15.** 2
16. 308	**17.** $5.31	**18.** $1\frac{7}{8}$
19. $15.60	**20.** $2\frac{1}{2}$	**21.** $41.40
22. $5.49	**23.** 384	**24.** 96