**Task card 1** Easter Math

One batch of a recipe uses $\frac{3}{4}$ cup of shredded carrot. Leo makes 3 batches. How many cups of shredded carrot does Leo use?

**Task card 2** Easter Math

Zoe buys a chocolate bunny for $5.95 and pays with a $10 bill. How much change does Zoe get?

**Task card 3** Easter Math

One batch of a recipe uses $\frac{1}{4}$ cup of shredded carrot. Omar makes 5 batches. How many cups of shredded carrot does Omar use?

**Task card 4** Easter Math

One bag of jelly beans costs $4.10. Leo buys 7 bags of jelly beans. How much does Leo spend?

**Task card 5** Easter Math

One chocolate bunny costs $5.75. Lily buys 3 chocolate bunnies. How much does Lily spend?

**Task card 6** Easter Math

A gift box is 7 inches long, 6 inches wide and 2 inches tall. What is its volume in cubic inches?

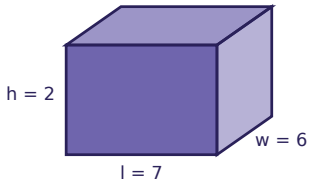

**Task card 7** Easter Math

A gift box is 8 inches long, 7 inches wide and 6 inches tall. What is its volume in cubic inches?

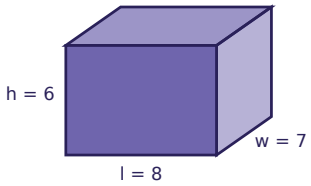


**Task card 8** Easter Math

Sam buys a chocolate bunny for $6.15 and pays with a $10 bill. How much change does Sam get?

**Task card 9** Easter Math

A gift box is 11 inches long, 3 inches wide and 8 inches tall. What is its volume in cubic inches?

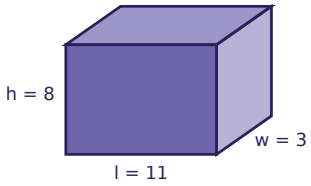


**Task card 10** Easter Math

A gift box is 9 inches long, 3 inches wide and 7 inches tall. What is its volume in cubic inches?

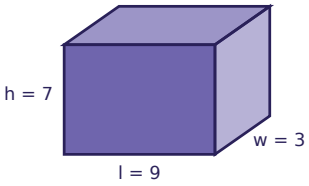


**Task card 11** Easter Math

Ella buys a bag of jelly beans for $2.34 and pays with a $10 bill. How much change does Ella get?

**Task card 12** Easter Math

One batch of a recipe uses $\frac{2}{3}$ cup of shredded carrot. Ava makes 3 batches. How many cups of shredded carrot does Ava use?

**Task card 13** Easter Math

One chocolate bunny costs $7.65. Zoe buys 2 chocolate bunnies. How much does Zoe spend?

**Task card 14** Easter Math

One batch of a recipe uses $\frac{2}{3}$ cup of shredded carrot. Leo makes 2 batches. How many cups of shredded carrot does Leo use?

**Task card 15** Easter Math

One bag of jelly beans costs $3.55. Ella buys 6 bags of jelly beans. How much does Ella spend?

**Task card 16** Easter Math

Mia buys a chocolate bunny for $3.44 and pays with a $10 bill. How much change does Mia get?

**Task card 17** Easter Math

A gift box is 9 inches long, 8 inches wide and 3 inches tall. What is its volume in cubic inches?

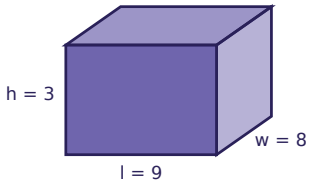


**Task card 18** Easter Math

One batch of a recipe uses $\frac{5}{8}$ cup of shredded carrot. Zoe makes 2 batches. How many cups of shredded carrot does Zoe use?

**Task card 19** Easter Math

Lily buys a pot of tulips for $7.48 and pays with a $10 bill. How much change does Lily get?

**Task card 20** Easter Math

Ava buys a pot of tulips for $10.59 and pays with a $20 bill. How much change does Ava get?

**Task card 21** Easter Math

One pot of tulips costs $7.55. Ella buys 4 pots of tulips. How much does Ella spend?

**Task card 22** Easter Math

A gift box is 9 inches long, 3 inches wide and 5 inches tall. What is its volume in cubic inches?

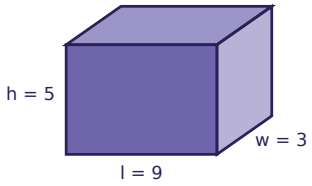


**Task card 23** Easter Math

One batch of a recipe uses $\frac{3}{4}$ cup of shredded carrot. Sam makes 2 batches. How many cups of shredded carrot does Sam use?

**Task card 24** Easter Math

One pot of tulips costs $11.30. Sam buys 6 pots of tulips. How much does Sam spend?

# Easter Math Task Cards

Recording sheet · Grade 5 · Read each story and solve. Write money like $4.50 and fractions like 1 1/2.

Name: _____ Date: _____

Scan to check your answers

| | | | |
|---|---|---|---|
| 1 | 2 | 3 | 4 |
| 5 | 6 | 7 | 8 |
| 9 | 10 | 11 | 12 |
| 13 | 14 | 15 | 16 |
| 17 | 18 | 19 | 20 |
| 21 | 22 | 23 | 24 |

# Easter Math Task Cards: Answer Key

Grade 5 · Medium

The answers online

| | | |
|---|---|---|
| **1.** $2\frac{1}{4}$ | **2.** $4.05 | **3.** $1\frac{1}{4}$ |
| **4.** $28.70 | **5.** $17.25 | **6.** 84 |
| **7.** 336 | **8.** $3.85 | **9.** 264 |
| **10.** 189 | **11.** $7.66 | **12.** 2 |
| **13.** $15.30 | **14.** $1\frac{1}{3}$ | **15.** $21.30 |
| **16.** $6.56 | **17.** 216 | **18.** $1\frac{1}{4}$ |
| **19.** $2.52 | **20.** $9.41 | **21.** $30.20 |
| **22.** 135 | **23.** $1\frac{1}{2}$ | **24.** $67.80 |