Task card 1 Easter Math

One batch of a recipe uses $\frac{1}{2}$ cup of shredded carrot. Mia makes 3 batches. How many cups of shredded carrot does Mia use?

Task card 2 Easter Math

One pot of tulips costs $5.90. Mia buys 2 pots of tulips. How much does Mia spend?

Task card 3 Easter Math

A gift box is 6 inches long, 5 inches wide and 2 inches tall. What is its volume in cubic inches?

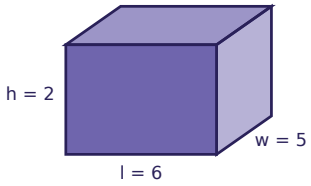

Task card 4 Easter Math

One batch of a recipe uses $\frac{1}{3}$ cup of shredded carrot. Mia makes 3 batches. How many cups of shredded carrot does Mia use?

Task card 5 Easter Math

One bag of jelly beans costs $3.70. Leo buys 2 bags of jelly beans. How much does Leo spend?

Task card 6 Easter Math

Leo buys a bag of jelly beans for $3.30 and pays with a $10 bill. How much change does Leo get?

Task card 7 Easter Math

Noah buys a bag of jelly beans for $3.40 and pays with a $10 bill. How much change does Noah get?

Task card 8 Easter Math

A gift box is 6 inches long, 3 inches wide and 3 inches tall. What is its volume in cubic inches?

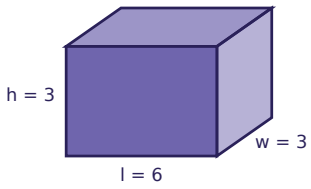

Task card 9 Easter Math

One batch of a recipe uses $\frac{1}{4}$ cup of shredded carrot. Noah makes 4 batches. How many cups of shredded carrot does Noah use?

Task card 10 Easter Math

One chocolate bunny costs $5.25. Ella buys 4 chocolate bunnies. How much does Ella spend?

Task card 11 Easter Math

One bag of jelly beans costs $3.60. Zoe buys 5 bags of jelly beans. How much does Zoe spend?

Task card 12 Easter Math

Leo buys a pot of tulips for $8.05 and pays with a $10 bill. How much change does Leo get?

Task card 13 Easter Math

A gift box is 6 inches long, 3 inches wide and 4 inches tall. What is its volume in cubic inches?

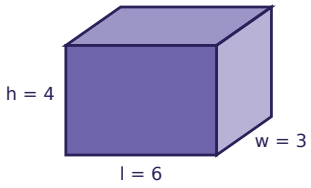

Task card 14 Easter Math

One batch of a recipe uses $\frac{1}{3}$ cup of shredded carrot. Leo makes 4 batches. How many cups of shredded carrot does Leo use?

Task card 15 Easter Math

A gift box is 4 inches long, 5 inches wide and 5 inches tall. What is its volume in cubic inches?

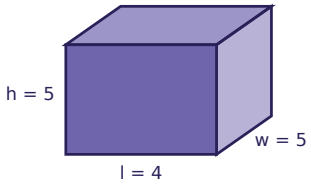

Task card 16 Easter Math

Noah buys a pot of tulips for $6.80 and pays with a $10 bill. How much change does Noah get?

Task card 17 Easter Math

A gift box is 7 inches long, 5 inches wide and 2 inches tall. What is its volume in cubic inches?

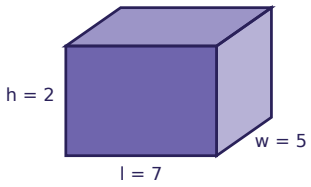

Task card 18 Easter Math

Leo buys a bag of jelly beans for $2.75 and pays with a $10 bill. How much change does Leo get?

Task card 19 Easter Math

Mia buys a bag of jelly beans for $2.30 and pays with a $10 bill. How much change does Mia get?

Task card 20 Easter Math

One pot of tulips costs $8.75. Noah buys 2 pots of tulips. How much does Noah spend?

Task card 21 Easter Math

One pot of tulips costs $5.80. Zoe buys 4 pots of tulips. How much does Zoe spend?

Task card 22 Easter Math

A gift box is 7 inches long, 6 inches wide and 4 inches tall. What is its volume in cubic inches?

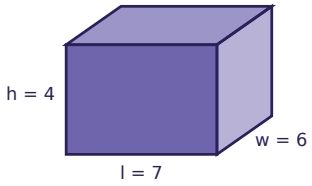

Task card 23 Easter Math

One batch of a recipe uses $\frac{3}{4}$ cup of shredded carrot. Leo makes 2 batches. How many cups of shredded carrot does Leo use?

Task card 24 Easter Math

Sam buys a bag of jelly beans for $4.35 and pays with a $10 bill. How much change does Sam get?

Easter Math Task Cards

Recording sheet · Grade 5 · Read each story and solve. Write money like $4.50 and fractions like 1 1/2.

Name: _____ Date: _____

Scan to check your answers

1	2	3	4
5	6	7	8
9	10	11	12
13	14	15	16
17	18	19	20
21	22	23	24

Easter Math Task Cards: Answer Key

Grade 5 · Easy

The answers online

1. $1\frac{1}{2}$	**2.** $11.80	**3.** 60
4. 1	**5.** $7.40	**6.** $6.70
7. $6.60	**8.** 54	**9.** 1
10. $21.00	**11.** $18.00	**12.** $1.95
13. 72	**14.** $1\frac{1}{3}$	**15.** 100
16. $3.20	**17.** 70	**18.** $7.25
19. $7.70	**20.** $17.50	**21.** $23.20
22. 168	**23.** $1\frac{1}{2}$	**24.** $5.65