Easter Math · 1

One batch of a recipe uses $\frac{3}{4}$ cup of shredded carrot. Leo makes 3 batches. How many cups of shredded carrot does Leo use?

Easter Math · 2

Zoe buys a chocolate bunny for $5.95 and pays with a $10 bill. How much change does Zoe get?

Easter Math · 3

One batch of a recipe uses $\frac{1}{4}$ cup of shredded carrot. Omar makes 5 batches. How many cups of shredded carrot does Omar use?

Easter Math · 4

One bag of jelly beans costs $4.10. Leo buys 7 bags of jelly beans. How much does Leo spend?

Easter Math · 5

One chocolate bunny costs $5.75. Lily buys 3 chocolate bunnies. How much does Lily spend?

Easter Math · 6

A gift box is 7 inches long, 6 inches wide and 2 inches tall. What is its volume in cubic inches?

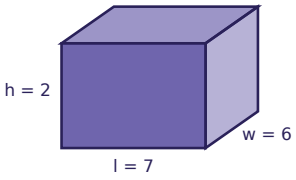

Easter Math · 7

A gift box is 8 inches long, 7 inches wide and 6 inches tall. What is its volume in cubic inches?

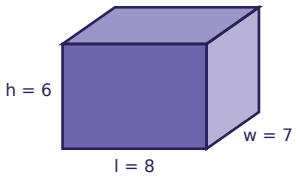

Easter Math · 8

Sam buys a chocolate bunny for $6.15 and pays with a $10 bill. How much change does Sam get?

Easter Math · 2

ANSWER

$4.05

Easter Math · 1

ANSWER

$2\frac{1}{4}$

Easter Math · 4

ANSWER

$28.70

Easter Math · 3

ANSWER

$1\frac{1}{4}$

Easter Math · 6

ANSWER

84

Easter Math · 5

ANSWER

$17.25

Easter Math · 8

ANSWER

$3.85

Easter Math · 7

ANSWER

336

Easter Math · 9

A gift box is 11 inches long, 3 inches wide and 8 inches tall. What is its volume in cubic inches?

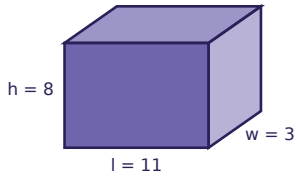

Easter Math · 10

A gift box is 9 inches long, 3 inches wide and 7 inches tall. What is its volume in cubic inches?

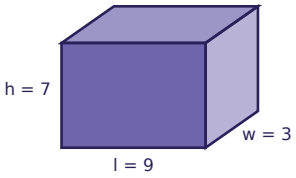

Easter Math · 11

Ella buys a bag of jelly beans for $2.34 and pays with a $10 bill. How much change does Ella get?

Easter Math · 12

One batch of a recipe uses $\frac{2}{3}$ cup of shredded carrot. Ava makes 3 batches. How many cups of shredded carrot does Ava use?

Easter Math · 13

One chocolate bunny costs $7.65. Zoe buys 2 chocolate bunnies. How much does Zoe spend?

Easter Math · 14

One batch of a recipe uses $\frac{2}{3}$ cup of shredded carrot. Leo makes 2 batches. How many cups of shredded carrot does Leo use?

Easter Math · 15

One bag of jelly beans costs $3.55. Ella buys 6 bags of jelly beans. How much does Ella spend?

Easter Math · 16

Mia buys a chocolate bunny for $3.44 and pays with a $10 bill. How much change does Mia get?

Easter Math · 10

ANSWER

189

Easter Math · 9

ANSWER

264

Easter Math · 12

ANSWER

2

Easter Math · 11

ANSWER

$7.66

Easter Math · 14

ANSWER

$$1\frac{1}{3}$$

Easter Math · 13

ANSWER

$15.30

Easter Math · 16

ANSWER

$6.56

Easter Math · 15

ANSWER

$21.30

Easter Math · 17

A gift box is 9 inches long, 8 inches wide and 3 inches tall. What is its volume in cubic inches?

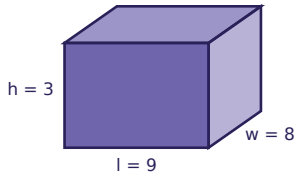

Easter Math · 18

One batch of a recipe uses $\frac{5}{8}$ cup of shredded carrot. Zoe makes 2 batches. How many cups of shredded carrot does Zoe use?

Easter Math · 19

Lily buys a pot of tulips for $7.48 and pays with a $10 bill. How much change does Lily get?

Easter Math · 20

Ava buys a pot of tulips for $10.59 and pays with a $20 bill. How much change does Ava get?

Easter Math · 21

One pot of tulips costs $7.55. Ella buys 4 pots of tulips. How much does Ella spend?

Easter Math · 22

A gift box is 9 inches long, 3 inches wide and 5 inches tall. What is its volume in cubic inches?

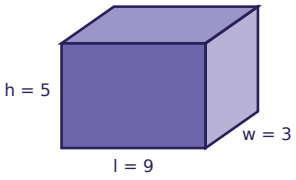

Easter Math · 23

One batch of a recipe uses $\frac{3}{4}$ cup of shredded carrot. Sam makes 2 batches. How many cups of shredded carrot does Sam use?

Easter Math · 24

One pot of tulips costs $11.30. Sam buys 6 pots of tulips. How much does Sam spend?

Easter Math · 18

ANSWER

$1\frac{1}{4}$

Easter Math · 17

ANSWER

216

Easter Math · 20

ANSWER

$9.41

Easter Math · 19

ANSWER

$2.52

Easter Math · 22

ANSWER

135

Easter Math · 21

ANSWER

$30.20

Easter Math · 24

ANSWER

$67.80

Easter Math · 23

ANSWER

$1\frac{1}{2}$