Easter Math · 1

A gift box is 10 inches long, 6 inches wide and 3 inches tall. What is its volume in cubic inches?

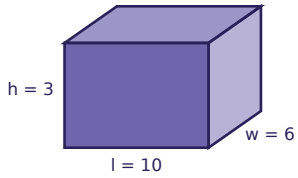

Easter Math · 2

One batch of a recipe uses $\frac{3}{8}$ cup of shredded carrot. Zoe makes 6 batches. How many cups of shredded carrot does Zoe use?

Easter Math · 3

A gift box is 8 inches long, 3 inches wide and 7 inches tall. What is its volume in cubic inches?

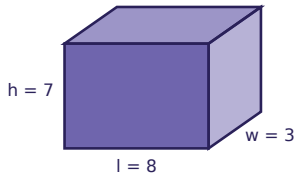

Easter Math · 4

Mia buys a pot of tulips for $5.41 and pays with a $10 bill. How much change does Mia get?

Easter Math · 5

One batch of a recipe uses $\frac{3}{4}$ cup of shredded carrot. Ella makes 2 batches. How many cups of shredded carrot does Ella use?

Easter Math · 6

One bag of jelly beans costs $3.05. Ben buys 4 bags of jelly beans. How much does Ben spend?

Easter Math · 7

One pot of tulips costs $9.55. Leo buys 3 pots of tulips. How much does Leo spend?

Easter Math · 8

Leo buys a pot of tulips for $9.31 and pays with a $10 bill. How much change does Leo get?

Easter Math · 2

ANSWER

$2\frac{1}{4}$

Easter Math · 1

ANSWER

180

Easter Math · 4

ANSWER

$4.59

Easter Math · 3

ANSWER

168

Easter Math · 6

ANSWER

$12.20

Easter Math · 5

ANSWER

$1\frac{1}{2}$

Easter Math · 8

ANSWER

$0.69

Easter Math · 7

ANSWER

$28.65

Easter Math · 9

Ava buys a pot of tulips for $5.96 and pays with a $10 bill. How much change does Ava get?

Easter Math · 10

One bag of jelly beans costs $4.35. Leo buys 2 bags of jelly beans. How much does Leo spend?

Easter Math · 11

One batch of a recipe uses $\frac{3}{4}$ cup of shredded carrot. Leo makes 5 batches. How many cups of shredded carrot does Leo use?

Easter Math · 12

Leo buys a bag of jelly beans for $2.26 and pays with a $10 bill. How much change does Leo get?

Easter Math · 13

One bag of jelly beans costs $4.45. Lily buys 6 bags of jelly beans. How much does Lily spend?

Easter Math · 14

A gift box is 14 inches long, 4 inches wide and 5 inches tall. What is its volume in cubic inches?

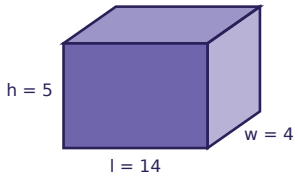

Easter Math · 15

One batch of a recipe uses $\frac{2}{3}$ cup of shredded carrot. Noah makes 3 batches. How many cups of shredded carrot does Noah use?

Easter Math · 16

A gift box is 11 inches long, 4 inches wide and 7 inches tall. What is its volume in cubic inches?

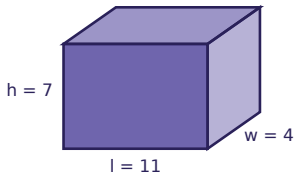

Easter Math · 10

ANSWER

$8.70

Easter Math · 9

ANSWER

$4.04

Easter Math · 12

ANSWER

$7.74

Easter Math · 11

ANSWER

$$3\frac{3}{4}$$

Easter Math · 14

ANSWER

280

Easter Math · 13

ANSWER

$26.70

Easter Math · 16

ANSWER

308

Easter Math · 15

ANSWER

2

Easter Math · 17

Ava buys a chocolate bunny for $4.69 and pays with a $10 bill. How much change does Ava get?

Easter Math · 18

One batch of a recipe uses $\frac{5}{8}$ cup of shredded carrot. Noah makes 3 batches. How many cups of shredded carrot does Noah use?

Easter Math · 19

One chocolate bunny costs $7.80. Omar buys 2 chocolate bunnies. How much does Omar spend?

Easter Math · 20

One batch of a recipe uses $\frac{5}{8}$ cup of shredded carrot. Ava makes 4 batches. How many cups of shredded carrot does Ava use?

Easter Math · 21

One pot of tulips costs $10.35. Ava buys 4 pots of tulips. How much does Ava spend?

Easter Math · 22

Ava buys a bag of jelly beans for $4.51 and pays with a $10 bill. How much change does Ava get?

Easter Math · 23

A gift box is 12 inches long, 4 inches wide and 8 inches tall. What is its volume in cubic inches?

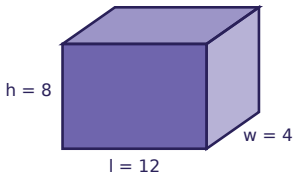

Easter Math · 24

A gift box is 4 inches long, 3 inches wide and 8 inches tall. What is its volume in cubic inches?

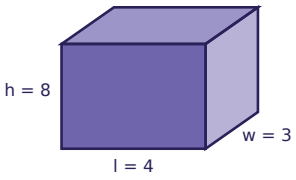

Easter Math · 18

ANSWER

$1\frac{7}{8}$

Easter Math · 17

ANSWER

$5.31

Easter Math · 20

ANSWER

$2\frac{1}{2}$

Easter Math · 19

ANSWER

$15.60

Easter Math · 22

ANSWER

$5.49

Easter Math · 21

ANSWER

$41.40

Easter Math · 24

ANSWER

96

Easter Math · 23

ANSWER

384