Easter Math · 1

One batch of a recipe uses $\frac{1}{2}$ cup of shredded carrot. Mia makes 3 batches. How many cups of shredded carrot does Mia use?

Easter Math · 2

One pot of tulips costs $5.90. Mia buys 2 pots of tulips. How much does Mia spend?

Easter Math · 3

A gift box is 6 inches long, 5 inches wide and 2 inches tall. What is its volume in cubic inches?

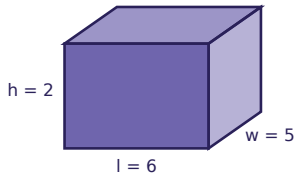

Easter Math · 4

One batch of a recipe uses $\frac{1}{3}$ cup of shredded carrot. Mia makes 3 batches. How many cups of shredded carrot does Mia use?

Easter Math · 5

One bag of jelly beans costs $3.70. Leo buys 2 bags of jelly beans. How much does Leo spend?

Easter Math · 6

Leo buys a bag of jelly beans for $3.30 and pays with a $10 bill. How much change does Leo get?

Easter Math · 7

Noah buys a bag of jelly beans for $3.40 and pays with a $10 bill. How much change does Noah get?

Easter Math · 8

A gift box is 6 inches long, 3 inches wide and 3 inches tall. What is its volume in cubic inches?

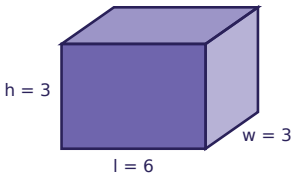

Easter Math · 2

ANSWER

$11.80

Easter Math · 1

ANSWER

$$1\frac{1}{2}$$

Easter Math · 4

ANSWER

1

Easter Math · 3

ANSWER

60

Easter Math · 6

ANSWER

$6.70

Easter Math · 5

ANSWER

$7.40

Easter Math · 8

ANSWER

54

Easter Math · 7

ANSWER

$6.60

Easter Math · 9

One batch of a recipe uses $\frac{1}{4}$ cup of shredded carrot. Noah makes 4 batches. How many cups of shredded carrot does Noah use?

Easter Math · 10

One chocolate bunny costs $5.25. Ella buys 4 chocolate bunnies. How much does Ella spend?

Easter Math · 11

One bag of jelly beans costs $3.60. Zoe buys 5 bags of jelly beans. How much does Zoe spend?

Easter Math · 12

Leo buys a pot of tulips for $8.05 and pays with a $10 bill. How much change does Leo get?

Easter Math · 13

A gift box is 6 inches long, 3 inches wide and 4 inches tall. What is its volume in cubic inches?

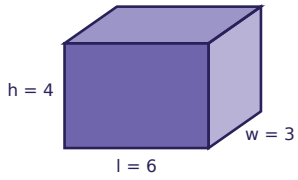

Easter Math · 14

One batch of a recipe uses $\frac{1}{3}$ cup of shredded carrot. Leo makes 4 batches. How many cups of shredded carrot does Leo use?

Easter Math · 15

A gift box is 4 inches long, 5 inches wide and 5 inches tall. What is its volume in cubic inches?

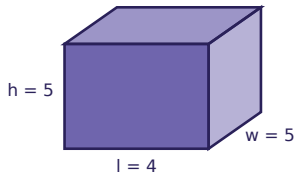

Easter Math · 16

Noah buys a pot of tulips for $6.80 and pays with a $10 bill. How much change does Noah get?

Easter Math · 10

ANSWER

$21.00

Easter Math · 9

ANSWER

1

Easter Math · 12

ANSWER

$1.95

Easter Math · 11

ANSWER

$18.00

Easter Math · 14

ANSWER

$$1\frac{1}{3}$$

Easter Math · 13

ANSWER

72

Easter Math · 16

ANSWER

$3.20

Easter Math · 15

ANSWER

100

Easter Math · 17

A gift box is 7 inches long, 5 inches wide and 2 inches tall. What is its volume in cubic inches?

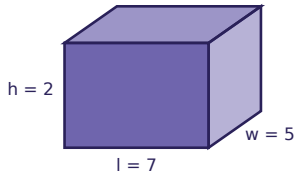

Easter Math · 18

Leo buys a bag of jelly beans for $2.75 and pays with a $10 bill. How much change does Leo get?

Easter Math · 19

Mia buys a bag of jelly beans for $2.30 and pays with a $10 bill. How much change does Mia get?

Easter Math · 20

One pot of tulips costs $8.75. Noah buys 2 pots of tulips. How much does Noah spend?

Easter Math · 21

One pot of tulips costs $5.80. Zoe buys 4 pots of tulips. How much does Zoe spend?

Easter Math · 22

A gift box is 7 inches long, 6 inches wide and 4 inches tall. What is its volume in cubic inches?

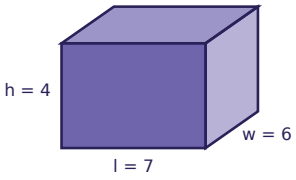

Easter Math · 23

One batch of a recipe uses $\frac{3}{4}$ cup of shredded carrot. Leo makes 2 batches. How many cups of shredded carrot does Leo use?

Easter Math · 24

Sam buys a bag of jelly beans for $4.35 and pays with a $10 bill. How much change does Sam get?

Easter Math · 18

ANSWER

$7.25

Easter Math · 17

ANSWER

70

Easter Math · 20

ANSWER

$17.50

Easter Math · 19

ANSWER

$7.70

Easter Math · 22

ANSWER

168

Easter Math · 21

ANSWER

$23.20

Easter Math · 24

ANSWER

$5.65

Easter Math · 23

ANSWER

$$1\frac{1}{2}$$