Task card 1 Dividing Unit Fractions & Whole Nu...

$$\frac{1}{6} \div 4 = ___$$



Task card 2 Dividing Unit Fractions & Whole Nu...

$$\frac{1}{3} \div 6 = ___$$

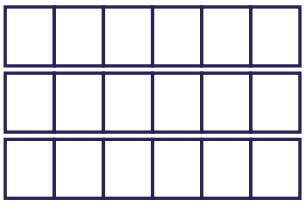

Task card 3 Dividing Unit Fractions & Whole Nu...

Each lap around a path is $\frac{1}{6}$ mile. How many laps make 3 miles?

Task card 4 Dividing Unit Fractions & Whole Nu...

$\frac{1}{2}$ pound of trail mix is split equally into 2 bags. How many pounds of trail mix are in each bag?

Task card 5 Dividing Unit Fractions & Whole Nu...

$$\frac{1}{3} \div 4 = ___$$



Task card 6 Dividing Unit Fractions & Whole Nu...

$$\frac{1}{4} \div 3 = ___$$

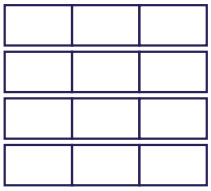

Task card 7 Dividing Unit Fractions & Whole Nu...

4 pounds of cheese are cut into $\frac{1}{5}$-pound blocks. How many blocks are there?

Task card 8 Dividing Unit Fractions & Whole Nu...

$\frac{1}{2}$ pound of trail mix is split equally into 4 bags. How many pounds of trail mix are in each bag?

Task card 9 Dividing Unit Fractions & Whole Nu...

$$\frac{1}{4} \div 3 = ___$$



Task card 10 Dividing Unit Fractions & Whole Nu...

$$\frac{1}{4} \div 6 = ___$$

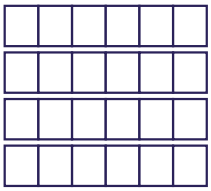

Task card 11 Dividing Unit Fractions & Whole Nu...

4 pounds of cheese are cut into $\frac{1}{6}$-pound blocks. How many blocks are there?

Task card 12 Dividing Unit Fractions & Whole Nu...

2 friends share $\frac{1}{3}$ of a pan of brownies equally. What fraction of the whole pan does each friend get?

Task card 13 Dividing Unit Fractions & Whole Nu...

$\frac{1}{2} \div 4 = ___$



Task card 14 Dividing Unit Fractions & Whole Nu...

$\frac{1}{4} \div 2 = ___$



Task card 15 Dividing Unit Fractions & Whole Nu...

A 2-yard ribbon is cut into pieces that are each $\frac{1}{3}$ yard long. How many pieces are there?

Task card 16 Dividing Unit Fractions & Whole Nu...

2 students share $\frac{1}{2}$ of a pizza equally. What fraction of the whole pizza does each student get?

Task card 17 Dividing Unit Fractions & Whole Nu...

$\frac{1}{4} \div 2 = ___$



Task card 18 Dividing Unit Fractions & Whole Nu...

$\frac{1}{2} \div 4 = ___$

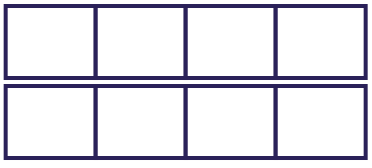

Task card 19 Dividing Unit Fractions & Whole Nu...

A 2-yard ribbon is cut into pieces that are each $\frac{1}{4}$ yard long. How many pieces are there?

Task card 20 Dividing Unit Fractions & Whole Nu...

$\frac{1}{4}$ pound of trail mix is split equally into 2 bags. How many pounds of trail mix are in each bag?

Task card 21 Dividing Unit Fractions & Whole Nu...

$\frac{1}{2} \div 3 = ___$



Task card 22 Dividing Unit Fractions & Whole Nu...

$\frac{1}{3} \div 5 = ___$



Task card 23 Dividing Unit Fractions & Whole Nu...

4 pounds of cheese are cut into $\frac{1}{4}$-pound blocks. How many blocks are there?

Task card 24 Dividing Unit Fractions & Whole Nu...

$\frac{1}{3}$ of a pizza is shared equally by 3 students. What fraction of the whole pizza does each student get?

Dividing Unit Fractions & Whole Numbers Task Cards

Recording sheet · Grade 5 · Divide. Write fractions in simplest form.

Scan to check your answers

Name: _____ Date: _____

1	2	3	4
5	6	7	8
9	10	11	12
13	14	15	16
17	18	19	20
21	22	23	24

Dividing Unit Fractions & Whole Numbers Task Cards: Answer Key

Grade 5 · Easy

The answers online

1. $\frac{1}{24}$	**2.** 18	**3.** 18
4. $\frac{1}{4}$	**5.** $\frac{1}{12}$	**6.** 12
7. 20	**8.** $\frac{1}{8}$	**9.** $\frac{1}{12}$
10. 24	**11.** 24	**12.** $\frac{1}{6}$
13. $\frac{1}{8}$	**14.** 8	**15.** 6
16. $\frac{1}{4}$	**17.** $\frac{1}{8}$	**18.** 8
19. 8	**20.** $\frac{1}{8}$	**21.** $\frac{1}{6}$
22. 15	**23.** 16	**24.** $\frac{1}{9}$