Dividing Unit Fractions & Whole Numbers · 1

$\frac{1}{6} \div 4 = ___$



Dividing Unit Fractions & Whole Numbers · 2

$3 \div \frac{1}{6} = ___$

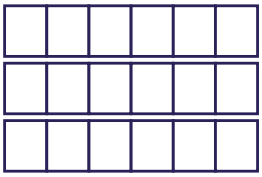

Dividing Unit Fractions & Whole Numbers · 3

Each lap around a path is $\frac{1}{6}$ mile. How many laps make 3 miles?

Dividing Unit Fractions & Whole Numbers · 4

$\frac{1}{2}$ pound of trail mix is split equally into 2 bags. How many pounds of trail mix are in each bag?

Dividing Unit Fractions & Whole Numbers · 5

$\frac{1}{3} \div 4 = ___$



Dividing Unit Fractions & Whole Numbers · 6

$4 \div \frac{1}{3} = ___$

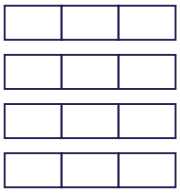

Dividing Unit Fractions & Whole Numbers · 7

4 pounds of cheese are cut into $\frac{1}{5}$-pound blocks. How many blocks are there?

Dividing Unit Fractions & Whole Numbers · 8

$\frac{1}{2}$ pound of trail mix is split equally into 4 bags. How many pounds of trail mix are in each bag?

Dividing Unit Fractions & Whole Numbers · 2

ANSWER

$$18$$

Dividing Unit Fractions & Whole Numbers · 1

ANSWER

$$\frac{1}{24}$$

Dividing Unit Fractions & Whole Numbers · 4

ANSWER

$$\frac{1}{4}$$

Dividing Unit Fractions & Whole Numbers · 3

ANSWER

$$18$$

Dividing Unit Fractions & Whole Numbers · 6

ANSWER

$$12$$

Dividing Unit Fractions & Whole Numbers · 5

ANSWER

$$\frac{1}{12}$$

Dividing Unit Fractions & Whole Numbers · 8

ANSWER

$$\frac{1}{8}$$

Dividing Unit Fractions & Whole Numbers · 7

ANSWER

$$20$$

$\frac{1}{4} \div 3 = ___$



$\frac{1}{4} \div 6 = ___$



4 pounds of cheese are cut into $\frac{1}{6}$-pound blocks. How many blocks are there?

2 friends share $\frac{1}{3}$ of a pan of brownies equally. What fraction of the whole pan does each friend get?

$\frac{1}{2} \div 4 = ___$



$\frac{1}{4} \div 2 = ___$



A 2-yard ribbon is cut into pieces that are each $\frac{1}{3}$ yard long. How many pieces are there?

2 students share $\frac{1}{2}$ of a pizza equally. What fraction of the whole pizza does each student get?

Dividing Unit Fractions & Whole Numbers · 10

ANSWER

24

Dividing Unit Fractions & Whole Numbers · 9

ANSWER

$\frac{1}{12}$

Dividing Unit Fractions & Whole Numbers · 12

ANSWER

$\frac{1}{6}$

Dividing Unit Fractions & Whole Numbers · 11

ANSWER

24

Dividing Unit Fractions & Whole Numbers · 14

ANSWER

8

Dividing Unit Fractions & Whole Numbers · 13

ANSWER

$\frac{1}{8}$

Dividing Unit Fractions & Whole Numbers · 16

ANSWER

$\frac{1}{4}$

Dividing Unit Fractions & Whole Numbers · 15

ANSWER

6

Dividing Unit Fractions & Whole Numbers · 17

$\frac{1}{4} \div 2 = ___$



Dividing Unit Fractions & Whole Numbers · 18

$2 \div \frac{1}{4} = ___$



Dividing Unit Fractions & Whole Numbers · 19

A 2-yard ribbon is cut into pieces that are each $\frac{1}{4}$ yard long. How many pieces are there?

Dividing Unit Fractions & Whole Numbers · 20

$\frac{1}{4}$ pound of trail mix is split equally into 2 bags. How many pounds of trail mix are in each bag?

Dividing Unit Fractions & Whole Numbers · 21

$\frac{1}{2} \div 3 = ___$



Dividing Unit Fractions & Whole Numbers · 22

$3 \div \frac{1}{5} = ___$



Dividing Unit Fractions & Whole Numbers · 23

4 pounds of cheese are cut into $\frac{1}{4}$-pound blocks. How many blocks are there?

Dividing Unit Fractions & Whole Numbers · 24

3 students share $\frac{1}{3}$ of a pizza equally. What fraction of the whole pizza does each student get?

Dividing Unit Fractions & Whole Numbers · 18

ANSWER

8

Dividing Unit Fractions & Whole Numbers · 17

ANSWER

$\frac{1}{8}$

Dividing Unit Fractions & Whole Numbers · 20

ANSWER

$\frac{1}{8}$

Dividing Unit Fractions & Whole Numbers · 19

ANSWER

8

Dividing Unit Fractions & Whole Numbers · 22

ANSWER

15

Dividing Unit Fractions & Whole Numbers · 21

ANSWER

$\frac{1}{6}$

Dividing Unit Fractions & Whole Numbers · 24

ANSWER

$\frac{1}{9}$

Dividing Unit Fractions & Whole Numbers · 23

ANSWER

16