Task card 1 Coordinate Plane (Quadrant I)

Point P is 1 unit right and 10 units up from the origin. What are its coordinates?

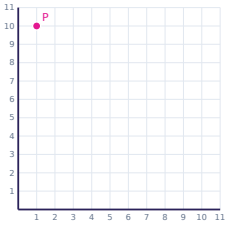

Task card 2 Coordinate Plane (Quadrant I)

What is the x-coordinate of point P?

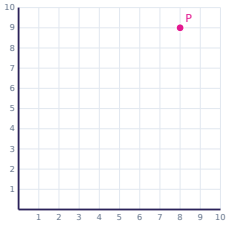

Task card 3 Coordinate Plane (Quadrant I)

What is the y-coordinate of point P?

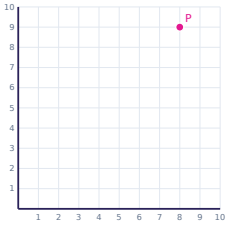

Task card 4 Coordinate Plane (Quadrant I)

Point P is 6 units right and 5 units up from the origin. What are its coordinates?

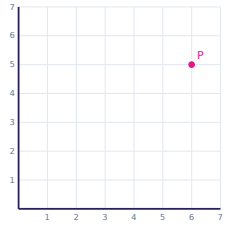

Task card 5 Coordinate Plane (Quadrant I)

What is the x-coordinate of point P?

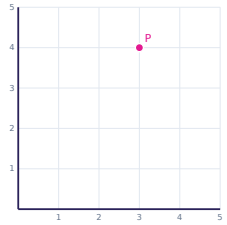

Task card 6 Coordinate Plane (Quadrant I)

What is the y-coordinate of point P?

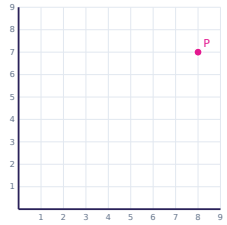

Task card 7 Coordinate Plane (Quadrant I)

Point P is 2 units right and 7 units up from the origin. What are its coordinates?

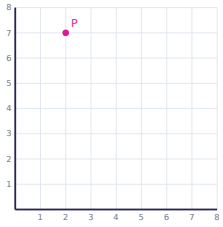

Task card 8 Coordinate Plane (Quadrant I)

What is the x-coordinate of point P?

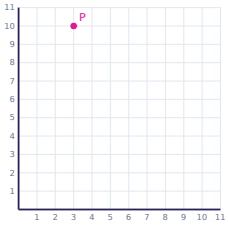

Task card 9 Coordinate Plane (Quadrant I)

Point P is 3 units right and 3 units up from the origin. What are its coordinates?

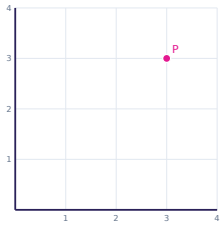

Task card 10 Coordinate Plane (Quadrant I)

What is the x-coordinate of point P?

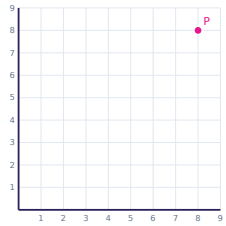

Task card 11 Coordinate Plane (Quadrant I)

What is the y-coordinate of point P?

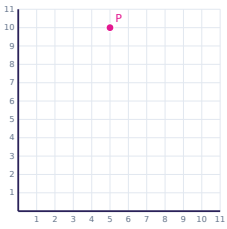

Task card 12 Coordinate Plane (Quadrant I)

Point P is 7 units right and 3 units up from the origin. What are its coordinates?

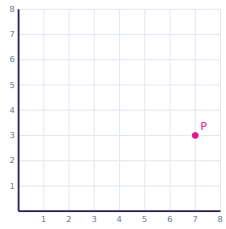

Task card 13 Coordinate Plane (Quadrant I)

What is the x-coordinate of point P?

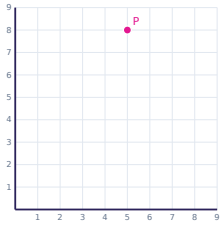

Task card 14 Coordinate Plane (Quadrant I)

What is the y-coordinate of point P?

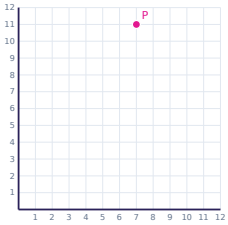

Task card 15 Coordinate Plane (Quadrant I)

Point P is 2 units right and 3 units up from the origin. What are its coordinates?

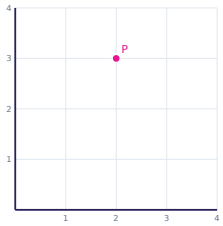

Task card 16 Coordinate Plane (Quadrant I)

What is the x-coordinate of point P?

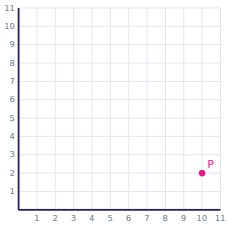

Task card 17 Coordinate Plane (Quadrant I)

Point P is 7 units right and 8 units up from the origin. What are its coordinates?

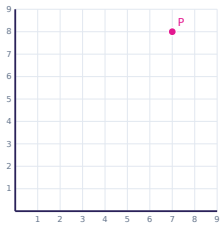

Task card 18 Coordinate Plane (Quadrant I)

What is the x-coordinate of point P?

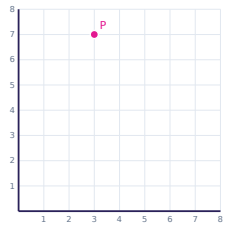

Task card 19 Coordinate Plane (Quadrant I)

What is the y-coordinate of point P?

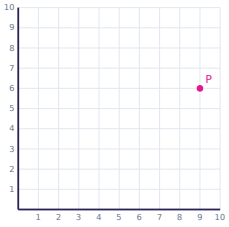

Task card 20 Coordinate Plane (Quadrant I)

Point P is 7 units right and 10 units up from the origin. What are its coordinates?

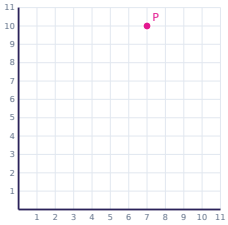

Task card 21 Coordinate Plane (Quadrant I)

What is the x-coordinate of point P?

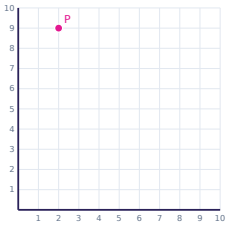

Task card 22 Coordinate Plane (Quadrant I)

What is the y-coordinate of point P?

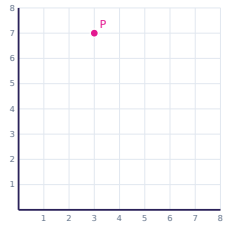

Task card 23 Coordinate Plane (Quadrant I)

Point P is 6 units right and 7 units up from the origin. What are its coordinates?

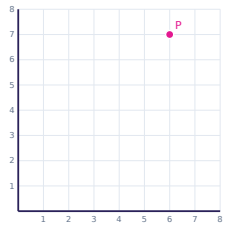

Task card 24 Coordinate Plane (Quadrant I)

Point P is 8 units right and 2 units up from the origin. What are its coordinates?

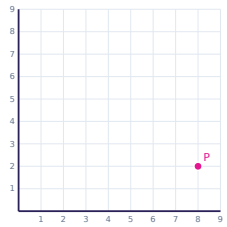

Coordinate Plane (Quadrant I) Task Cards

Recording sheet · Grade 5 · Answer each question.

Name: _____ Date: _____

Scan to check your answers

1	2	3	4
5	6	7	8
9	10	11	12
13	14	15	16
17	18	19	20
21	22	23	24

Coordinate Plane (Quadrant I) Task Cards: Answer Key

Grade 5 · Hard

The answers online

1. (1, 10)	**2.** 8	**3.** 9
4. (6, 5)	**5.** 3	**6.** 7
7. (2, 7)	**8.** 3	**9.** (3, 3)
10. 8	**11.** 10	**12.** (7, 3)
13. 5	**14.** 11	**15.** (2, 3)
16. 10	**17.** (7, 8)	**18.** 3
19. 6	**20.** (7, 10)	**21.** 2
22. 7	**23.** (6, 7)	**24.** (8, 2)