Task card 1 Coordinate Plane (Quadrant I)

Point P is 3 units right and 3 units up from the origin. What are its coordinates?

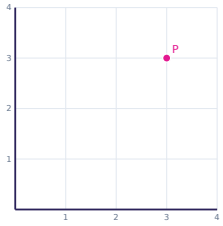

Task card 2 Coordinate Plane (Quadrant I)

What is the x-coordinate of point P?

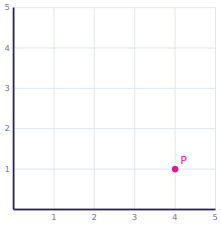

Task card 3 Coordinate Plane (Quadrant I)

What is the y-coordinate of point P?

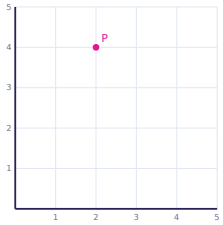

Task card 4 Coordinate Plane (Quadrant I)

Point P is 3 units right and 4 units up from the origin. What are its coordinates?

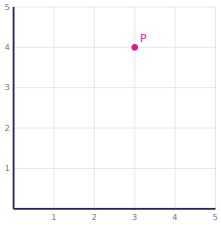

Task card 5 Coordinate Plane (Quadrant I)

What is the x-coordinate of point P?

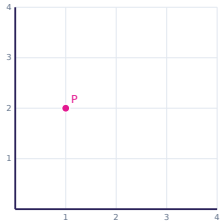

Task card 6 Coordinate Plane (Quadrant I)

What is the y-coordinate of point P?

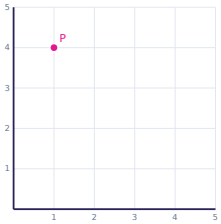

Task card 7 Coordinate Plane (Quadrant I)

Point P is 2 units right and 2 units up from the origin. What are its coordinates?

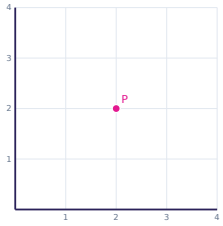

Task card 8 Coordinate Plane (Quadrant I)

What is the x-coordinate of point P?

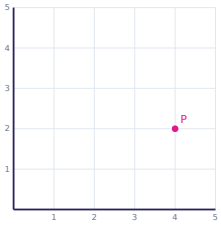

Task card 9 Coordinate Plane (Quadrant I)

Point P is 5 units right and 1 unit up from the origin. What are its coordinates?

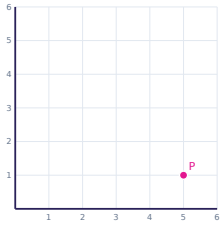

Task card 10 Coordinate Plane (Quadrant I)

What is the x-coordinate of point P?

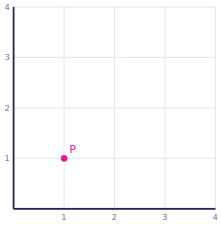

Task card 11 Coordinate Plane (Quadrant I)

Point P is 1 unit right and 3 units up from the origin. What are its coordinates?

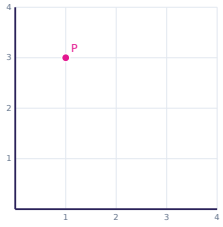

Task card 12 Coordinate Plane (Quadrant I)

What is the x-coordinate of point P?

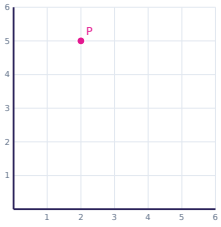

Task card 13 Coordinate Plane (Quadrant I)

What is the y-coordinate of point P?

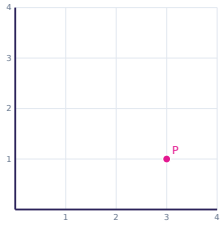

Task card 14 Coordinate Plane (Quadrant I)

Point P is 5 units right and 3 units up from the origin. What are its coordinates?

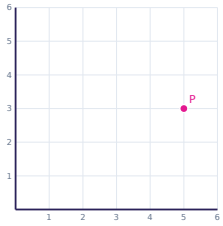

Task card 15 Coordinate Plane (Quadrant I)

What is the x-coordinate of point P?

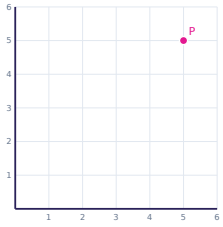

Task card 16 Coordinate Plane (Quadrant I)

Point P is 5 units right and 4 units up from the origin. What are its coordinates?

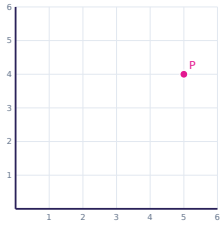

Task card 17 Coordinate Plane (Quadrant I)

What is the x-coordinate of point P?

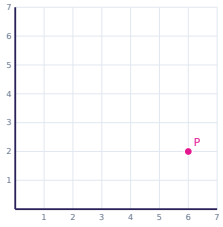

Task card 18 Coordinate Plane (Quadrant I)

What is the y-coordinate of point P?

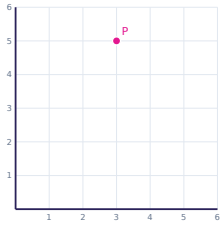

Task card 19 Coordinate Plane (Quadrant I)

Point P is 5 units right and 5 units up from the origin. What are its coordinates?

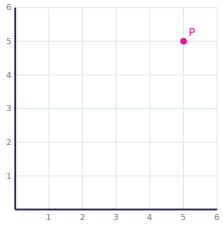

Task card 20 Coordinate Plane (Quadrant I)

What is the x-coordinate of point P?

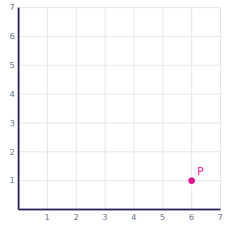

Task card 21 Coordinate Plane (Quadrant I)

What is the y-coordinate of point P?

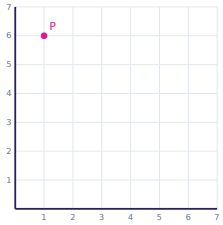

Task card 22 Coordinate Plane (Quadrant I)

Point P is 6 units right and 2 units up from the origin. What are its coordinates?

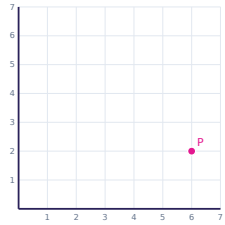

Task card 23 Coordinate Plane (Quadrant I)

What is the x-coordinate of point P?

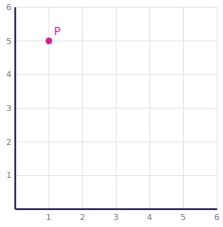

Task card 24 Coordinate Plane (Quadrant I)

Point P is 3 units right and 2 units up from the origin. What are its coordinates?

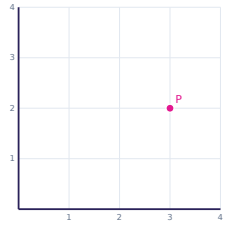

Coordinate Plane (Quadrant I) Task Cards

Recording sheet · Grade 5 · Answer each question.

Name: _____ Date: _____

Scan to check your answers

1	2	3	4
5	6	7	8
9	10	11	12
13	14	15	16
17	18	19	20
21	22	23	24

Coordinate Plane (Quadrant I) Task Cards: Answer Key

Grade 5 · Easy

The answers online

1. (3, 3)	**2.** 4	**3.** 4
4. (3, 4)	**5.** 1	**6.** 4
7. (2, 2)	**8.** 4	**9.** (5, 1)
10. 1	**11.** (1, 3)	**12.** 2
13. 1	**14.** (5, 3)	**15.** 5
16. (5, 4)	**17.** 6	**18.** 5
19. (5, 5)	**20.** 6	**21.** 6
22. (6, 2)	**23.** 1	**24.** (3, 2)