Coordinate Plane (Quadrant I) · 1

Point P is 1 unit right and 10 units up from the origin. What are its coordinates?

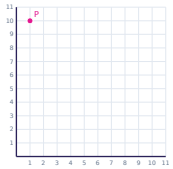

Coordinate Plane (Quadrant I) · 2

What is the x-coordinate of point P?

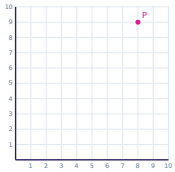

Coordinate Plane (Quadrant I) · 3

What is the y-coordinate of point P?

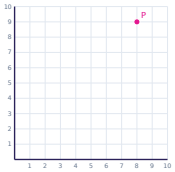

Coordinate Plane (Quadrant I) · 4

Point P is 6 units right and 5 units up from the origin. What are its coordinates?

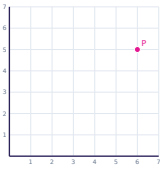

Coordinate Plane (Quadrant I) · 5

What is the x-coordinate of point P?

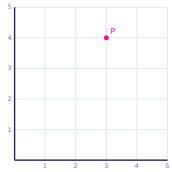

Coordinate Plane (Quadrant I) · 6

What is the y-coordinate of point P?

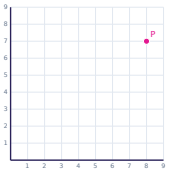

Coordinate Plane (Quadrant I) · 7

Point P is 2 units right and 7 units up from the origin. What are its coordinates?

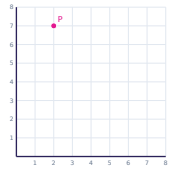

Coordinate Plane (Quadrant I) · 8

What is the x-coordinate of point P?

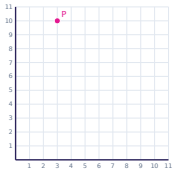

Coordinate Plane (Quadrant I) · 2

ANSWER

8

Coordinate Plane (Quadrant I) · 1

ANSWER

(1, 10)

Coordinate Plane (Quadrant I) · 4

ANSWER

(6, 5)

Coordinate Plane (Quadrant I) · 3

ANSWER

9

Coordinate Plane (Quadrant I) · 6

ANSWER

7

Coordinate Plane (Quadrant I) · 5

ANSWER

3

Coordinate Plane (Quadrant I) · 8

ANSWER

3

Coordinate Plane (Quadrant I) · 7

ANSWER

(2, 7)

Coordinate Plane (Quadrant I) · 9

Point P is 3 units right and 3 units up from the origin. What are its coordinates?

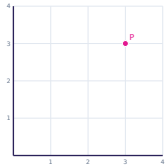

Coordinate Plane (Quadrant I) · 10

What is the x-coordinate of point P?

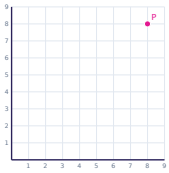

Coordinate Plane (Quadrant I) · 11

What is the y-coordinate of point P?

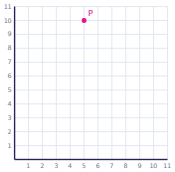

Coordinate Plane (Quadrant I) · 12

Point P is 7 units right and 3 units up from the origin. What are its coordinates?

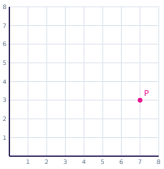

Coordinate Plane (Quadrant I) · 13

What is the x-coordinate of point P?

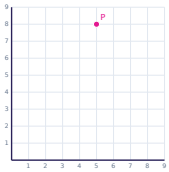

Coordinate Plane (Quadrant I) · 14

What is the y-coordinate of point P?

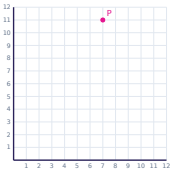

Coordinate Plane (Quadrant I) · 15

Point P is 2 units right and 3 units up from the origin. What are its coordinates?

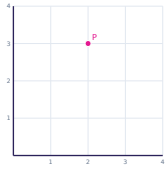

Coordinate Plane (Quadrant I) · 16

What is the x-coordinate of point P?

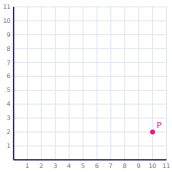

Coordinate Plane (Quadrant I) · 10

ANSWER

8

Coordinate Plane (Quadrant I) · 9

ANSWER

(3, 3)

Coordinate Plane (Quadrant I) · 12

ANSWER

(7, 3)

Coordinate Plane (Quadrant I) · 11

ANSWER

10

Coordinate Plane (Quadrant I) · 14

ANSWER

11

Coordinate Plane (Quadrant I) · 13

ANSWER

5

Coordinate Plane (Quadrant I) · 16

ANSWER

10

Coordinate Plane (Quadrant I) · 15

ANSWER

(2, 3)

Coordinate Plane (Quadrant I) · 17

Point P is 7 units right and 8 units up from the origin. What are its coordinates?

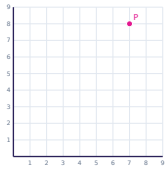

Coordinate Plane (Quadrant I) · 18

What is the x-coordinate of point P?

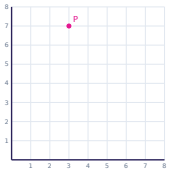

Coordinate Plane (Quadrant I) · 19

What is the y-coordinate of point P?

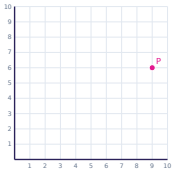

Coordinate Plane (Quadrant I) · 20

Point P is 7 units right and 10 units up from the origin. What are its coordinates?

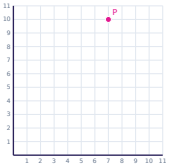

Coordinate Plane (Quadrant I) · 21

What is the x-coordinate of point P?

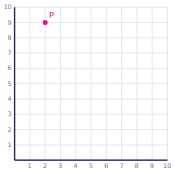

Coordinate Plane (Quadrant I) · 22

What is the y-coordinate of point P?

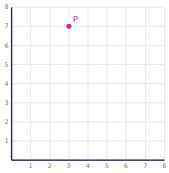

Coordinate Plane (Quadrant I) · 23

Point P is 6 units right and 7 units up from the origin. What are its coordinates?

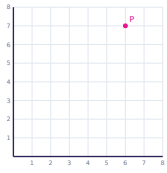

Coordinate Plane (Quadrant I) · 24

Point P is 8 units right and 2 units up from the origin. What are its coordinates?

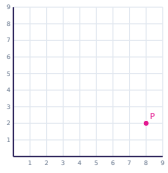

Coordinate Plane (Quadrant I) · 18

ANSWER

3

Coordinate Plane (Quadrant I) · 17

ANSWER

(7, 8)

Coordinate Plane (Quadrant I) · 20

ANSWER

(7, 10)

Coordinate Plane (Quadrant I) · 19

ANSWER

6

Coordinate Plane (Quadrant I) · 22

ANSWER

7

Coordinate Plane (Quadrant I) · 21

ANSWER

2

Coordinate Plane (Quadrant I) · 24

ANSWER

(8, 2)

Coordinate Plane (Quadrant I) · 23

ANSWER

(6, 7)