Task card 1 Christmas Math

A gift box is 7 inches long, 8 inches wide and 5 inches tall. What is its volume in cubic inches?

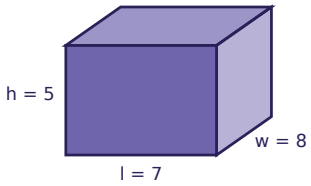

Task card 2 Christmas Math

Ben buys a box of candy canes for $2.05 and pays with a $10 bill. How much change does Ben get?

Task card 3 Christmas Math

One box of candy canes costs $3.75. Noah buys 3 boxes of candy canes. How much does Noah spend?

Task card 4 Christmas Math

Noah buys a roll of wrapping paper for $5.21 and pays with a $10 bill. How much change does Noah get?

Task card 5 Christmas Math

One batch of a recipe uses $\frac{3}{4}$ cup of chocolate chips. Ava makes 6 batches. How many cups of chocolate chips does Ava use?

Task card 6 Christmas Math

One batch of a recipe uses $\frac{3}{4}$ cup of chocolate chips. Ava makes 5 batches. How many cups of chocolate chips does Ava use?

Task card 7 Christmas Math

One roll of wrapping paper costs $5.30. Leo buys 4 rolls of wrapping paper. How much does Leo spend?

Task card 8 Christmas Math

A gift box is 9 inches long, 7 inches wide and 7 inches tall. What is its volume in cubic inches?

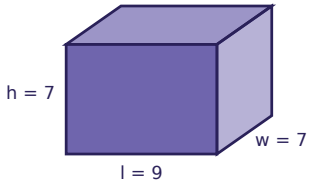

Task card 9 Christmas Math

One batch of a recipe uses $\frac{2}{3}$ cup of chocolate chips. Lily makes 2 batches. How many cups of chocolate chips does Lily use?

Task card 10 Christmas Math

One roll of wrapping paper costs $5.75. Ava buys 6 rolls of wrapping paper. How much does Ava spend?

Task card 11 Christmas Math

Noah buys a string of lights for $9.21 and pays with a $10 bill. How much change does Noah get?

Task card 12 Christmas Math

A gift box is 10 inches long, 7 inches wide and 2 inches tall. What is its volume in cubic inches?

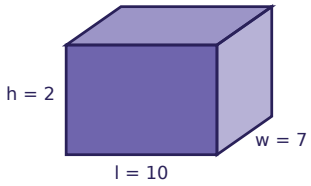

Task card 13 Christmas Math

Zoe buys a roll of wrapping paper for $4.72 and pays with a $10 bill. How much change does Zoe get?

Task card 14 Christmas Math

One roll of wrapping paper costs $4.70. Ava buys 9 rolls of wrapping paper. How much does Ava spend?

Task card 15 Christmas Math

A gift box is 12 inches long, 10 inches wide and 4 inches tall. What is its volume in cubic inches?

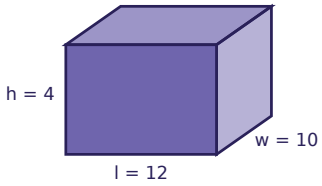

Task card 16 Christmas Math

One batch of a recipe uses $\frac{3}{8}$ cup of chocolate chips. Ella makes 4 batches. How many cups of chocolate chips does Ella use?

Task card 17 Christmas Math

One batch of a recipe uses $\frac{5}{6}$ cup of chocolate chips. Lily makes 3 batches. How many cups of chocolate chips does Lily use?

Task card 18 Christmas Math

A gift box is 10 inches long, 7 inches wide and 8 inches tall. What is its volume in cubic inches?

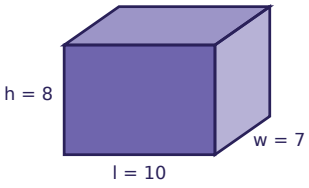

Task card 19 Christmas Math

Ava buys a string of lights for $7.04 and pays with a $10 bill. How much change does Ava get?

Task card 20 Christmas Math

One box of candy canes costs $3.70. Mia buys 7 boxes of candy canes. How much does Mia spend?

Task card 21 Christmas Math

One string of lights costs $7.00. Lily buys 6 strings of lights. How much does Lily spend?

Task card 22 Christmas Math

A gift box is 5 inches long, 8 inches wide and 3 inches tall. What is its volume in cubic inches?

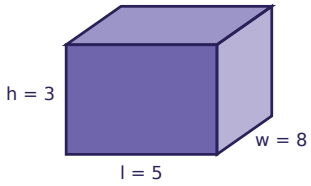

Task card 23 Christmas Math

Leo buys a string of lights for $10.54 and pays with a $20 bill. How much change does Leo get?

Task card 24 Christmas Math

One batch of a recipe uses $\frac{3}{4}$ cup of chocolate chips. Ella makes 3 batches. How many cups of chocolate chips does Ella use?

Christmas Math Task Cards

Recording sheet · Grade 5 · Read each story and solve. Write money like $4.50 and fractions like 1 1/2.

Scan to check your answers

Name: _____ Date: _____

1	2	3	4
5	6	7	8
9	10	11	12
13	14	15	16
17	18	19	20
21	22	23	24

Christmas Math Task Cards: Answer Key

Grade 5 · Hard

The answers online

1. 280	**2.** $7.95	**3.** $11.25
4. $4.79	**5.** $4\frac{1}{2}$	**6.** $3\frac{3}{4}$
7. $21.20	**8.** 441	**9.** $1\frac{1}{3}$
10. $34.50	**11.** $0.79	**12.** 140
13. $5.28	**14.** $42.30	**15.** 480
16. $1\frac{1}{2}$	**17.** $2\frac{1}{2}$	**18.** 560
19. $2.96	**20.** $25.90	**21.** $42.00
22. 120	**23.** $9.46	**24.** $2\frac{1}{4}$