Task card 1 Christmas Math

Ava buys a string of lights for $11.00 and pays with a $20 bill. How much change does Ava get?

Task card 2 Christmas Math

One box of candy canes costs $4.00. Noah buys 3 boxes of candy canes. How much does Noah spend?

Task card 3 Christmas Math

A gift box is 5 inches long, 4 inches wide and 3 inches tall. What is its volume in cubic inches?

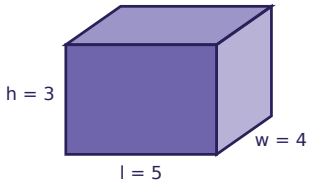

Task card 4 Christmas Math

One batch of a recipe uses $\frac{1}{4}$ cup of chocolate chips. Zoe makes 2 batches. How many cups of chocolate chips does Zoe use?

Task card 5 Christmas Math

A gift box is 5 inches long, 4 inches wide and 4 inches tall. What is its volume in cubic inches?

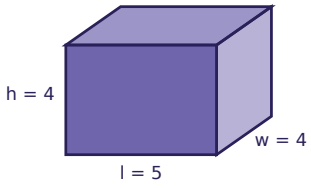

Task card 6 Christmas Math

One box of candy canes costs $3.45. Zoe buys 4 boxes of candy canes. How much does Zoe spend?

Task card 7 Christmas Math

One batch of a recipe uses $\frac{1}{3}$ cup of chocolate chips. Ben makes 2 batches. How many cups of chocolate chips does Ben use?

Task card 8 Christmas Math

Noah buys a roll of wrapping paper for $6.85 and pays with a $10 bill. How much change does Noah get?

Task card 9 Christmas Math

Noah buys a string of lights for $7.90 and pays with a $10 bill. How much change does Noah get?

Task card 10 Christmas Math

One string of lights costs $6.55. Ben buys 5 strings of lights. How much does Ben spend?

Task card 11 Christmas Math

One batch of a recipe uses $\frac{1}{4}$ cup of chocolate chips. Noah makes 2 batches. How many cups of chocolate chips does Noah use?

Task card 12 Christmas Math

One batch of a recipe uses $\frac{1}{4}$ cup of chocolate chips. Ben makes 2 batches. How many cups of chocolate chips does Ben use?

Task card 13 Christmas Math

Lily buys a string of lights for $9.10 and pays with a $10 bill. How much change does Lily get?

Task card 14 Christmas Math

A gift box is 6 inches long, 4 inches wide and 4 inches tall. What is its volume in cubic inches?

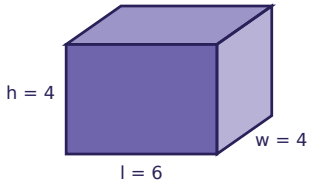

Task card 15 Christmas Math

A gift box is 4 inches long, 6 inches wide and 3 inches tall. What is its volume in cubic inches?

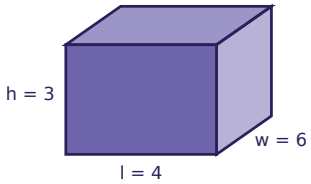

Task card 16 Christmas Math

One string of lights costs $10.65. Noah buys 4 strings of lights. How much does Noah spend?

Task card 17 Christmas Math

One roll of wrapping paper costs $6.55. Ben buys 4 rolls of wrapping paper. How much does Ben spend?

Task card 18 Christmas Math

Sam buys a string of lights for $7.55 and pays with a $10 bill. How much change does Sam get?

Task card 19 Christmas Math

Lily buys a string of lights for $6.90 and pays with a $10 bill. How much change does Lily get?

Task card 20 Christmas Math

One batch of a recipe uses $\frac{3}{4}$ cup of chocolate chips. Sam makes 2 batches. How many cups of chocolate chips does Sam use?

Task card 21 Christmas Math

One box of candy canes costs $4.15. Ava buys 4 boxes of candy canes. How much does Ava spend?

Task card 22 Christmas Math

A gift box is 7 inches long, 3 inches wide and 2 inches tall. What is its volume in cubic inches?

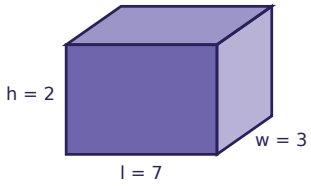

Task card 23 Christmas Math

A gift box is 9 inches long, 4 inches wide and 5 inches tall. What is its volume in cubic inches?

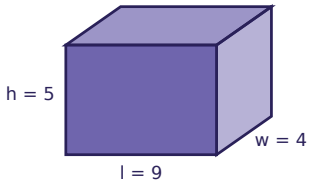

Task card 24 Christmas Math

One batch of a recipe uses $\frac{1}{2}$ cup of chocolate chips. Leo makes 2 batches. How many cups of chocolate chips does Leo use?

Christmas Math Task Cards

Recording sheet · Grade 5 · Read each story and solve. Write money like $4.50 and fractions like 1 1/2.

Name: _____ Date: _____

Scan to check your answers

1	2	3	4
5	6	7	8
9	10	11	12
13	14	15	16
17	18	19	20
21	22	23	24

Christmas Math Task Cards: Answer Key

Grade 5 · Easy

The answers online

1. $9.00	**2.** $12.00	**3.** 60
4. $\frac{1}{2}$	**5.** 80	**6.** $13.80
7. $\frac{2}{3}$	**8.** $3.15	**9.** $2.10
10. $32.75	**11.** $\frac{1}{2}$	**12.** $\frac{1}{2}$
13. $0.90	**14.** 96	**15.** 72
16. $42.60	**17.** $26.20	**18.** $2.45
19. $3.10	**20.** $1\frac{1}{2}$	**21.** $16.60
22. 42	**23.** 180	**24.** 1