Christmas Math · 1

One box of candy canes costs $4.85. Noah buys 6 boxes of candy canes. How much does Noah spend?

Christmas Math · 2

A gift box is 8 inches long, 5 inches wide and 2 inches tall. What is its volume in cubic inches?

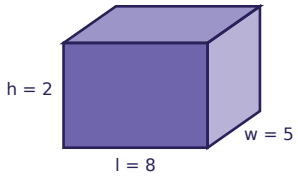

Christmas Math · 3

Ben buys a box of candy canes for $3.75 and pays with a $10 bill. How much change does Ben get?

Christmas Math · 4

A gift box is 10 inches long, 6 inches wide and 3 inches tall. What is its volume in cubic inches?

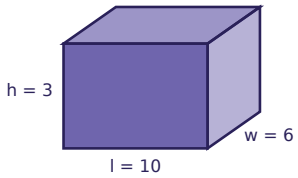

Christmas Math · 5

Lily buys a string of lights for $7.80 and pays with a $10 bill. How much change does Lily get?

Christmas Math · 6

One batch of a recipe uses $\frac{1}{4}$ cup of chocolate chips. Ava makes 2 batches. How many cups of chocolate chips does Ava use?

Christmas Math · 7

One batch of a recipe uses $\frac{1}{2}$ cup of chocolate chips. Leo makes 4 batches. How many cups of chocolate chips does Leo use?

Christmas Math · 8

One string of lights costs $6.95. Omar buys 6 strings of lights. How much does Omar spend?

Christmas Math · 2

ANSWER

80

Christmas Math · 1

ANSWER

$29.10

Christmas Math · 4

ANSWER

180

Christmas Math · 3

ANSWER

$6.25

Christmas Math · 6

ANSWER

$$\frac{1}{2}$$

Christmas Math · 5

ANSWER

$2.20

Christmas Math · 8

ANSWER

$41.70

Christmas Math · 7

ANSWER

2

Christmas Math · 9

Noah buys a box of candy canes for $3.30 and pays with a $10 bill. How much change does Noah get?

Christmas Math · 10

One box of candy canes costs $3.75. Leo buys 6 boxes of candy canes. How much does Leo spend?

Christmas Math · 11

One batch of a recipe uses $\frac{5}{6}$ cup of chocolate chips. Ben makes 2 batches. How many cups of chocolate chips does Ben use?

Christmas Math · 12

One batch of a recipe uses $\frac{3}{4}$ cup of chocolate chips. Noah makes 3 batches. How many cups of chocolate chips does Noah use?

Christmas Math · 13

A gift box is 7 inches long, 3 inches wide and 2 inches tall. What is its volume in cubic inches?

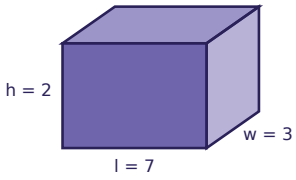

Christmas Math · 14

A gift box is 6 inches long, 5 inches wide and 5 inches tall. What is its volume in cubic inches?

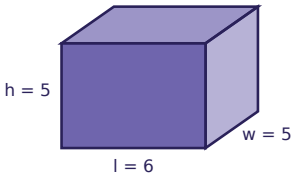

Christmas Math · 15

One box of candy canes costs $5.00. Ben buys 4 boxes of candy canes. How much does Ben spend?

Christmas Math · 16

Ella buys a string of lights for $11.84 and pays with a $20 bill. How much change does Ella get?

Christmas Math · 10

ANSWER

$22.50

Christmas Math · 9

ANSWER

$6.70

Christmas Math · 12

ANSWER

$2\frac{1}{4}$

Christmas Math · 11

ANSWER

$1\frac{2}{3}$

Christmas Math · 14

ANSWER

150

Christmas Math · 13

ANSWER

42

Christmas Math · 16

ANSWER

$8.16

Christmas Math · 15

ANSWER

$20.00

Christmas Math · 17

A gift box is 8 inches long, 5 inches wide and 3 inches tall. What is its volume in cubic inches?

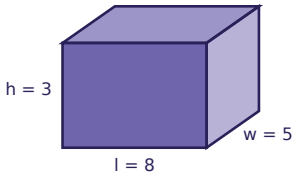

Christmas Math · 18

One roll of wrapping paper costs $4.20. Omar buys 8 rolls of wrapping paper. How much does Omar spend?

Christmas Math · 19

One batch of a recipe uses $\frac{2}{3}$ cup of chocolate chips. Leo makes 2 batches. How many cups of chocolate chips does Leo use?

Christmas Math · 20

A gift box is 11 inches long, 6 inches wide and 7 inches tall. What is its volume in cubic inches?

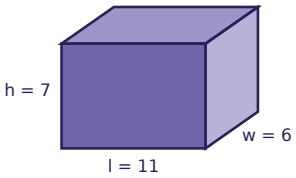

Christmas Math · 21

One batch of a recipe uses $\frac{2}{3}$ cup of chocolate chips. Ella makes 5 batches. How many cups of chocolate chips does Ella use?

Christmas Math · 22

Noah buys a roll of wrapping paper for $4.02 and pays with a $10 bill. How much change does Noah get?

Christmas Math · 23

Mia buys a string of lights for $6.29 and pays with a $10 bill. How much change does Mia get?

Christmas Math · 24

One roll of wrapping paper costs $6.40. Mia buys 8 rolls of wrapping paper. How much does Mia spend?

Christmas Math · 18

ANSWER

$33.60

Christmas Math · 17

ANSWER

120

Christmas Math · 20

ANSWER

462

Christmas Math · 19

ANSWER

$$1\frac{1}{3}$$

Christmas Math · 22

ANSWER

$5.98

Christmas Math · 21

ANSWER

$$3\frac{1}{3}$$

Christmas Math · 24

ANSWER

$51.20

Christmas Math · 23

ANSWER

$3.71