Christmas Math · 1

A gift box is 7 inches long, 8 inches wide and 5 inches tall. What is its volume in cubic inches?

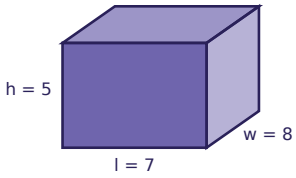

Christmas Math · 2

Ben buys a box of candy canes for $2.05 and pays with a $10 bill. How much change does Ben get?

Christmas Math · 3

One box of candy canes costs $3.75. Noah buys 3 boxes of candy canes. How much does Noah spend?

Christmas Math · 4

Noah buys a roll of wrapping paper for $5.21 and pays with a $10 bill. How much change does Noah get?

Christmas Math · 5

One batch of a recipe uses $\frac{3}{4}$ cup of chocolate chips. Ava makes 6 batches. How many cups of chocolate chips does Ava use?

Christmas Math · 6

One batch of a recipe uses $\frac{3}{4}$ cup of chocolate chips. Ava makes 5 batches. How many cups of chocolate chips does Ava use?

Christmas Math · 7

One roll of wrapping paper costs $5.30. Leo buys 4 rolls of wrapping paper. How much does Leo spend?

Christmas Math · 8

A gift box is 9 inches long, 7 inches wide and 7 inches tall. What is its volume in cubic inches?

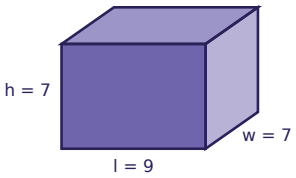

Christmas Math · 2

ANSWER

$7.95

Christmas Math · 1

ANSWER

280

Christmas Math · 4

ANSWER

$4.79

Christmas Math · 3

ANSWER

$11.25

Christmas Math · 6

ANSWER

$3\frac{3}{4}$

Christmas Math · 5

ANSWER

$4\frac{1}{2}$

Christmas Math · 8

ANSWER

441

Christmas Math · 7

ANSWER

$21.20

Christmas Math · 9

One batch of a recipe uses $\frac{2}{3}$ cup of chocolate chips. Lily makes 2 batches. How many cups of chocolate chips does Lily use?

Christmas Math · 10

One roll of wrapping paper costs $5.75. Ava buys 6 rolls of wrapping paper. How much does Ava spend?

Christmas Math · 11

Noah buys a string of lights for $9.21 and pays with a $10 bill. How much change does Noah get?

Christmas Math · 12

A gift box is 10 inches long, 7 inches wide and 2 inches tall. What is its volume in cubic inches?

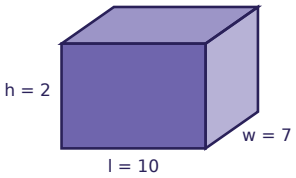

Christmas Math · 13

Zoe buys a roll of wrapping paper for $4.72 and pays with a $10 bill. How much change does Zoe get?

Christmas Math · 14

One roll of wrapping paper costs $4.70. Ava buys 9 rolls of wrapping paper. How much does Ava spend?

Christmas Math · 15

A gift box is 12 inches long, 10 inches wide and 4 inches tall. What is its volume in cubic inches?

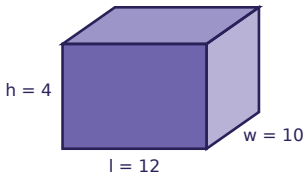

Christmas Math · 16

One batch of a recipe uses $\frac{3}{8}$ cup of chocolate chips. Ella makes 4 batches. How many cups of chocolate chips does Ella use?

Christmas Math · 10

ANSWER

$34.50

Christmas Math · 9

ANSWER

$1\frac{1}{3}$

Christmas Math · 12

ANSWER

140

Christmas Math · 11

ANSWER

$0.79

Christmas Math · 14

ANSWER

$42.30

Christmas Math · 13

ANSWER

$5.28

Christmas Math · 16

ANSWER

$1\frac{1}{2}$

Christmas Math · 15

ANSWER

480

Christmas Math · 17

One batch of a recipe uses $\frac{5}{6}$ cup of chocolate chips. Lily makes 3 batches. How many cups of chocolate chips does Lily use?

Christmas Math · 18

A gift box is 10 inches long, 7 inches wide and 8 inches tall. What is its volume in cubic inches?

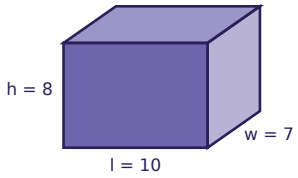

Christmas Math · 19

Ava buys a string of lights for $7.04 and pays with a $10 bill. How much change does Ava get?

Christmas Math · 20

One box of candy canes costs $3.70. Mia buys 7 boxes of candy canes. How much does Mia spend?

Christmas Math · 21

One string of lights costs $7.00. Lily buys 6 strings of lights. How much does Lily spend?

Christmas Math · 22

A gift box is 5 inches long, 8 inches wide and 3 inches tall. What is its volume in cubic inches?

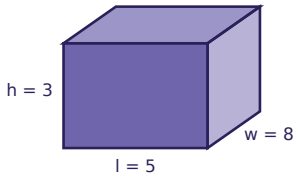

Christmas Math · 23

Leo buys a string of lights for $10.54 and pays with a $20 bill. How much change does Leo get?

Christmas Math · 24

One batch of a recipe uses $\frac{3}{4}$ cup of chocolate chips. Ella makes 3 batches. How many cups of chocolate chips does Ella use?

Christmas Math · 18

ANSWER

560

Christmas Math · 17

ANSWER

$2\frac{1}{2}$

Christmas Math · 20

ANSWER

$25.90

Christmas Math · 19

ANSWER

$2.96

Christmas Math · 22

ANSWER

120

Christmas Math · 21

ANSWER

$42.00

Christmas Math · 24

ANSWER

$2\frac{1}{4}$

Christmas Math · 23

ANSWER

$9.46