Christmas Math · 1

Ava buys a string of lights for $11.00 and pays with a $20 bill. How much change does Ava get?

Christmas Math · 2

One box of candy canes costs $4.00. Noah buys 3 boxes of candy canes. How much does Noah spend?

Christmas Math · 3

A gift box is 5 inches long, 4 inches wide and 3 inches tall. What is its volume in cubic inches?

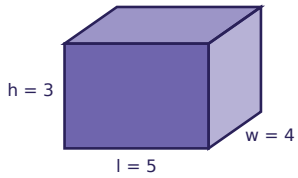

Christmas Math · 4

One batch of a recipe uses $\frac{1}{4}$ cup of chocolate chips. Zoe makes 2 batches. How many cups of chocolate chips does Zoe use?

Christmas Math · 5

A gift box is 5 inches long, 4 inches wide and 4 inches tall. What is its volume in cubic inches?

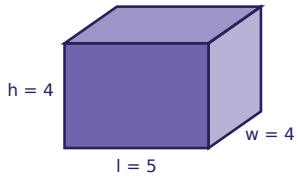

Christmas Math · 6

One box of candy canes costs $3.45. Zoe buys 4 boxes of candy canes. How much does Zoe spend?

Christmas Math · 7

One batch of a recipe uses $\frac{1}{3}$ cup of chocolate chips. Ben makes 2 batches. How many cups of chocolate chips does Ben use?

Christmas Math · 8

Noah buys a roll of wrapping paper for $6.85 and pays with a $10 bill. How much change does Noah get?

Christmas Math · 2

ANSWER

$12.00

Christmas Math · 1

ANSWER

$9.00

Christmas Math · 4

ANSWER

$$\frac{1}{2}$$

Christmas Math · 3

ANSWER

60

Christmas Math · 6

ANSWER

$13.80

Christmas Math · 5

ANSWER

80

Christmas Math · 8

ANSWER

$3.15

Christmas Math · 7

ANSWER

$$\frac{2}{3}$$

Christmas Math · 9

Noah buys a string of lights for $7.90 and pays with a $10 bill. How much change does Noah get?

Christmas Math · 10

One string of lights costs $6.55. Ben buys 5 strings of lights. How much does Ben spend?

Christmas Math · 11

One batch of a recipe uses $\frac{1}{4}$ cup of chocolate chips. Noah makes 2 batches. How many cups of chocolate chips does Noah use?

Christmas Math · 12

One batch of a recipe uses $\frac{1}{4}$ cup of chocolate chips. Ben makes 2 batches. How many cups of chocolate chips does Ben use?

Christmas Math · 13

Lily buys a string of lights for $9.10 and pays with a $10 bill. How much change does Lily get?

Christmas Math · 14

A gift box is 6 inches long, 4 inches wide and 4 inches tall. What is its volume in cubic inches?

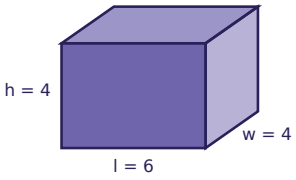

Christmas Math · 15

A gift box is 4 inches long, 6 inches wide and 3 inches tall. What is its volume in cubic inches?

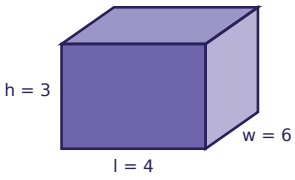

Christmas Math · 16

One string of lights costs $10.65. Noah buys 4 strings of lights. How much does Noah spend?

Christmas Math · 10

ANSWER

$32.75

Christmas Math · 9

ANSWER

$2.10

Christmas Math · 12

ANSWER

$$\frac{1}{2}$$

Christmas Math · 11

ANSWER

$$\frac{1}{2}$$

Christmas Math · 14

ANSWER

96

Christmas Math · 13

ANSWER

$0.90

Christmas Math · 16

ANSWER

$42.60

Christmas Math · 15

ANSWER

72

Christmas Math · 17

One roll of wrapping paper costs $6.55. Ben buys 4 rolls of wrapping paper. How much does Ben spend?

Christmas Math · 18

Sam buys a string of lights for $7.55 and pays with a $10 bill. How much change does Sam get?

Christmas Math · 19

Lily buys a string of lights for $6.90 and pays with a $10 bill. How much change does Lily get?

Christmas Math · 20

One batch of a recipe uses $\frac{3}{4}$ cup of chocolate chips. Sam makes 2 batches. How many cups of chocolate chips does Sam use?

Christmas Math · 21

One box of candy canes costs $4.15. Ava buys 4 boxes of candy canes. How much does Ava spend?

Christmas Math · 22

A gift box is 7 inches long, 3 inches wide and 2 inches tall. What is its volume in cubic inches?

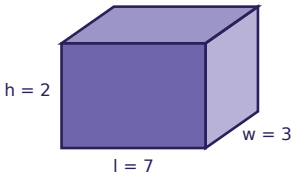

Christmas Math · 23

A gift box is 9 inches long, 4 inches wide and 5 inches tall. What is its volume in cubic inches?

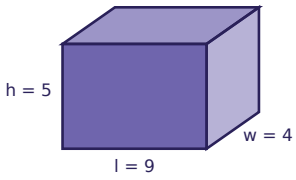

Christmas Math · 24

One batch of a recipe uses $\frac{1}{2}$ cup of chocolate chips. Leo makes 2 batches. How many cups of chocolate chips does Leo use?

Christmas Math · 18

ANSWER

$2.45

Christmas Math · 17

ANSWER

$26.20

Christmas Math · 20

ANSWER

$$1\frac{1}{2}$$

Christmas Math · 19

ANSWER

$3.10

Christmas Math · 22

ANSWER

42

Christmas Math · 21

ANSWER

$16.60

Christmas Math · 24

ANSWER

1

Christmas Math · 23

ANSWER

180