Task card 1 Back to School Math

A pencil box is 8 inches long, 10 inches wide and 4 inches tall. What is its volume in cubic inches?

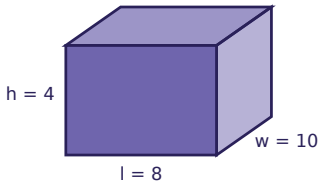

Task card 2 Back to School Math

Lily buys a box of crayons for $3.60 and pays with a $10 bill. How much change does Lily get?

Task card 3 Back to School Math

One notebook costs $1.35. Omar buys 3 notebooks. How much does Omar spend?

Task card 4 Back to School Math

One box of crayons costs $4.95. Noah buys 4 boxes of crayons. How much does Noah spend?

Task card 5 Back to School Math

A pencil box is 12 inches long, 9 inches wide and 8 inches tall. What is its volume in cubic inches?

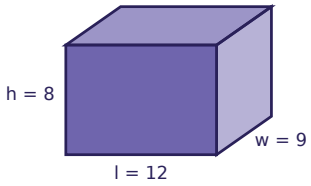

Task card 6 Back to School Math

One batch of a recipe uses $\frac{5}{8}$ cup of oats. Noah makes 5 batches. How many cups of oats does Noah use?

Task card 7 Back to School Math

Leo buys a notebook for $3.16 and pays with a $10 bill. How much change does Leo get?

Task card 8 Back to School Math

One batch of a recipe uses $\frac{2}{3}$ cup of oats. Sam makes 3 batches. How many cups of oats does Sam use?

Task card 9 Back to School Math

Omar buys a notebook for $1.72 and pays with a $10 bill. How much change does Omar get?

Task card 10 Back to School Math

One backpack costs $18.20. Ella buys 5 backpacks. How much does Ella spend?

Task card 11 Back to School Math

One batch of a recipe uses $\frac{5}{8}$ cup of oats. Sam makes 3 batches. How many cups of oats does Sam use?

Task card 12 Back to School Math

A pencil box is 12 inches long, 7 inches wide and 2 inches tall. What is its volume in cubic inches?

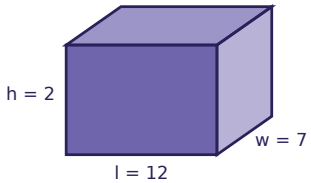

Task card 13 Back to School Math

One batch of a recipe uses $\frac{2}{3}$ cup of oats. Sam makes 5 batches. How many cups of oats does Sam use?

Task card 14 Back to School Math

One notebook costs $3.75. Ella buys 3 notebooks. How much does Ella spend?

Task card 15 Back to School Math

Lily buys a backpack for $16.87 and pays with a $20 bill. How much change does Lily get?

Task card 16 Back to School Math

A pencil box is 10 inches long, 4 inches wide and 7 inches tall. What is its volume in cubic inches?

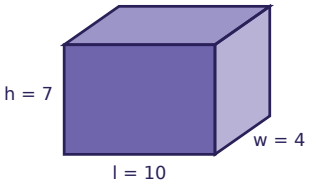

Task card 17 Back to School Math

A pencil box is 9 inches long, 3 inches wide and 4 inches tall. What is its volume in cubic inches?

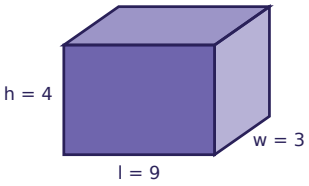

Task card 18 Back to School Math

One batch of a recipe uses $\frac{2}{3}$ cup of oats. Zoe makes 4 batches. How many cups of oats does Zoe use?

Task card 19 Back to School Math

One batch of a recipe uses $\frac{3}{8}$ cup of oats. Leo makes 3 batches. How many cups of oats does Leo use?

Task card 20 Back to School Math

A pencil box is 5 inches long, 7 inches wide and 3 inches tall. What is its volume in cubic inches?

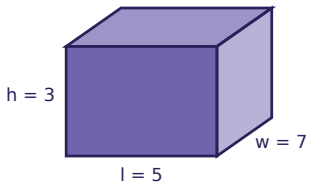

Task card 21 Back to School Math

One box of crayons costs $3.90. Lily buys 6 boxes of crayons. How much does Lily spend?

Task card 22 Back to School Math

Omar buys a notebook for $1.66 and pays with a $10 bill. How much change does Omar get?

Task card 23 Back to School Math

One box of crayons costs $2.95. Zoe buys 9 boxes of crayons. How much does Zoe spend?

Task card 24 Back to School Math

Ava buys a notebook for $3.74 and pays with a $10 bill. How much change does Ava get?

Back to School Math Task Cards

Recording sheet · Grade 5 · Read each story and solve. Write money like $4.50 and fractions like 1 1/2.

Name: _____ Date: _____

Scan to check your answers

1	2	3	4
5	6	7	8
9	10	11	12
13	14	15	16
17	18	19	20
21	22	23	24

Back to School Math Task Cards: Answer Key

Grade 5 · Hard

The answers online

1. 320	**2.** $6.40	**3.** $4.05
4. $19.80	**5.** 864	**6.** $3\frac{1}{8}$
7. $6.84	**8.** 2	**9.** $8.28
10. $91.00	**11.** $1\frac{7}{8}$	**12.** 168
13. $3\frac{1}{3}$	**14.** $11.25	**15.** $3.13
16. 280	**17.** 108	**18.** $2\frac{2}{3}$
19. $1\frac{1}{8}$	**20.** 105	**21.** $23.40
22. $8.34	**23.** $26.55	**24.** $6.26