Task card 1 Back to School Math

Ava buys a notebook for $3.35 and pays with a $10 bill. How much change does Ava get?

Task card 2 Back to School Math

One backpack costs $18.25. Noah buys 4 backpacks. How much does Noah spend?

Task card 3 Back to School Math

A pencil box is 8 inches long, 4 inches wide and 3 inches tall. What is its volume in cubic inches?

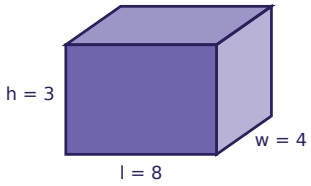

Task card 4 Back to School Math

One backpack costs $13.50. Ava buys 2 backpacks. How much does Ava spend?

Task card 5 Back to School Math

A pencil box is 5 inches long, 8 inches wide and 7 inches tall. What is its volume in cubic inches?

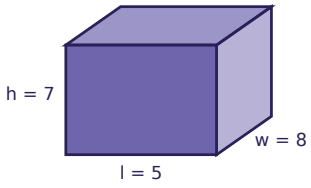

Task card 6 Back to School Math

One batch of a recipe uses $\frac{3}{4}$ cup of oats. Mia makes 3 batches. How many cups of oats does Mia use?

Task card 7 Back to School Math

One batch of a recipe uses $\frac{1}{3}$ cup of oats. Ella makes 3 batches. How many cups of oats does Ella use?

Task card 8 Back to School Math

Leo buys a box of crayons for $2.55 and pays with a $10 bill. How much change does Leo get?

Task card 9 Back to School Math

Ben buys a backpack for $14.41 and pays with a $20 bill. How much change does Ben get?

Task card 10 Back to School Math

Leo buys a box of crayons for $4.23 and pays with a $10 bill. How much change does Leo get?

Task card 11 Back to School Math

One notebook costs $1.70. Ben buys 5 notebooks. How much does Ben spend?

Task card 12 Back to School Math

One batch of a recipe uses $\frac{2}{3}$ cup of oats. Leo makes 2 batches. How many cups of oats does Leo use?

Task card 13 Back to School Math

A pencil box is 9 inches long, 3 inches wide and 8 inches tall. What is its volume in cubic inches?

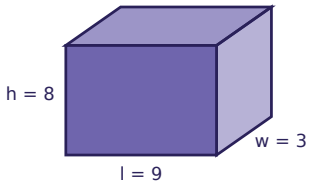

Task card 14 Back to School Math

One box of crayons costs $2.15. Leo buys 6 boxes of crayons. How much does Leo spend?

Task card 15 Back to School Math

One batch of a recipe uses $\frac{3}{8}$ cup of oats. Ella makes 4 batches. How many cups of oats does Ella use?

Task card 16 Back to School Math

A pencil box is 4 inches long, 3 inches wide and 6 inches tall. What is its volume in cubic inches?

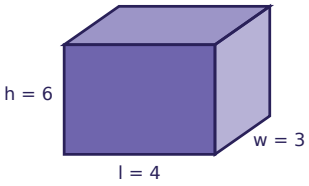

Task card 17 Back to School Math

One batch of a recipe uses $\frac{3}{4}$ cup of oats. Ava makes 5 batches. How many cups of oats does Ava use?

Task card 18 Back to School Math

Leo buys a notebook for $2.78 and pays with a $10 bill. How much change does Leo get?

Task card 19 Back to School Math

A pencil box is 10 inches long, 7 inches wide and 5 inches tall. What is its volume in cubic inches?

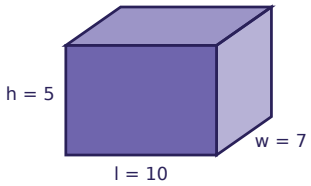

Task card 20 Back to School Math

A pencil box is 5 inches long, 8 inches wide and 8 inches tall. What is its volume in cubic inches?

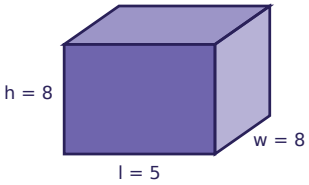

Task card 21 Back to School Math

One backpack costs $12.35. Zoe buys 9 backpacks. How much does Zoe spend?

Task card 22 Back to School Math

One batch of a recipe uses $\frac{5}{8}$ cup of oats. Mia makes 3 batches. How many cups of oats does Mia use?

Task card 23 Back to School Math

One backpack costs $17.20. Omar buys 4 backpacks. How much does Omar spend?

Task card 24 Back to School Math

Noah buys a backpack for $16.30 and pays with a $20 bill. How much change does Noah get?

Back to School Math Task Cards

Recording sheet · Grade 5 · Read each story and solve. Write money like $4.50 and fractions like 1 1/2.

Name: _____ Date: _____

Scan to check your answers

1	2	3	4
5	6	7	8
9	10	11	12
13	14	15	16
17	18	19	20
21	22	23	24

Back to School Math Task Cards: Answer Key

Grade 5 · Medium

The answers online

1. $6.65	**2.** $73.00	**3.** 96
4. $27.00	**5.** 280	**6.** $2\frac{1}{4}$
7. 1	**8.** $7.45	**9.** $5.59
10. $5.77	**11.** $8.50	**12.** $1\frac{1}{3}$
13. 216	**14.** $12.90	**15.** $1\frac{1}{2}$
16. 72	**17.** $3\frac{3}{4}$	**18.** $7.22
19. 350	**20.** 320	**21.** $111.15
22. $1\frac{7}{8}$	**23.** $68.80	**24.** $3.70