Task card 1 Back to School Math

One box of crayons costs $3.70. Omar buys 2 boxes of crayons. How much does Omar spend?

Task card 2 Back to School Math

Noah buys a backpack for $18.30 and pays with a $20 bill. How much change does Noah get?

Task card 3 Back to School Math

One batch of a recipe uses $\frac{3}{4}$ cup of oats. Ava makes 3 batches. How many cups of oats does Ava use?

Task card 4 Back to School Math

A pencil box is 4 inches long, 4 inches wide and 2 inches tall. What is its volume in cubic inches?

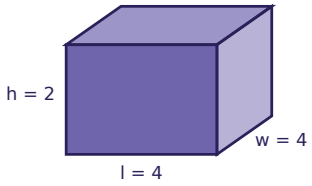

Task card 5 Back to School Math

Noah buys a box of crayons for $2.65 and pays with a $10 bill. How much change does Noah get?

Task card 6 Back to School Math

A pencil box is 7 inches long, 3 inches wide and 4 inches tall. What is its volume in cubic inches?

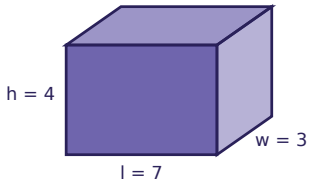

Task card 7 Back to School Math

One backpack costs $15.85. Zoe buys 2 backpacks. How much does Zoe spend?

Task card 8 Back to School Math

One batch of a recipe uses $\frac{3}{4}$ cup of oats. Lily makes 3 batches. How many cups of oats does Lily use?

Task card 9 Back to School Math

One backpack costs $17.65. Omar buys 3 backpacks. How much does Omar spend?

Task card 10 Back to School Math

One backpack costs $16.25. Omar buys 3 backpacks. How much does Omar spend?

Task card 11 Back to School Math

Noah buys a box of crayons for $3.05 and pays with a $10 bill. How much change does Noah get?

Task card 12 Back to School Math

A pencil box is 6 inches long, 5 inches wide and 5 inches tall. What is its volume in cubic inches?

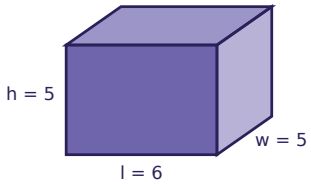

Task card 13 Back to School Math

A pencil box is 7 inches long, 4 inches wide and 2 inches tall. What is its volume in cubic inches?

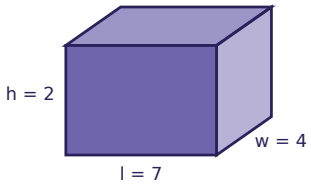

Task card 14 Back to School Math

One batch of a recipe uses $\frac{1}{3}$ cup of oats. Omar makes 3 batches. How many cups of oats does Omar use?

Task card 15 Back to School Math

One batch of a recipe uses $\frac{3}{4}$ cup of oats. Leo makes 4 batches. How many cups of oats does Leo use?

Task card 16 Back to School Math

Sam buys a backpack for $17.15 and pays with a $20 bill. How much change does Sam get?

Task card 17 Back to School Math

A pencil box is 9 inches long, 6 inches wide and 2 inches tall. What is its volume in cubic inches?

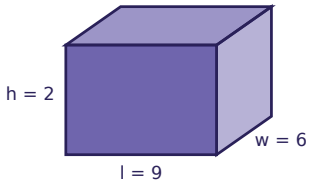

Task card 18 Back to School Math

A pencil box is 5 inches long, 4 inches wide and 4 inches tall. What is its volume in cubic inches?

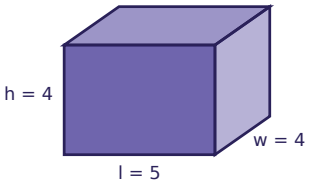

Task card 19 Back to School Math

Lily buys a backpack for $14.90 and pays with a $20 bill. How much change does Lily get?

Task card 20 Back to School Math

Sam buys a backpack for $12.20 and pays with a $20 bill. How much change does Sam get?

Task card 21 Back to School Math

One batch of a recipe uses $\frac{1}{2}$ cup of oats. Ben makes 4 batches. How many cups of oats does Ben use?

Task card 22 Back to School Math

One backpack costs $17.85. Ella buys 3 backpacks. How much does Ella spend?

Task card 23 Back to School Math

One batch of a recipe uses $\frac{1}{4}$ cup of oats. Sam makes 4 batches. How many cups of oats does Sam use?

Task card 24 Back to School Math

One backpack costs $16.50. Ava buys 6 backpacks. How much does Ava spend?

Back to School Math Task Cards

Recording sheet · Grade 5 · Read each story and solve. Write money like $4.50 and fractions like 1 1/2.

Name: _____ Date: _____

Scan to check your answers

1	2	3	4
5	6	7	8
9	10	11	12
13	14	15	16
17	18	19	20
21	22	23	24

Back to School Math Task Cards: Answer Key

Grade 5 · Easy

The answers online

1. $7.40	**2.** $1.70	**3.** $2\frac{1}{4}$
4. 32	**5.** $7.35	**6.** 84
7. $31.70	**8.** $2\frac{1}{4}$	**9.** $52.95
10. $48.75	**11.** $6.95	**12.** 150
13. 56	**14.** 1	**15.** 3
16. $2.85	**17.** 108	**18.** 80
19. $5.10	**20.** $7.80	**21.** 2
22. $53.55	**23.** 1	**24.** $99.00