Back to School Math · 1

Ava buys a notebook for $3.35 and pays with a $10 bill. How much change does Ava get?

Back to School Math · 2

One backpack costs $18.25. Noah buys 4 backpacks. How much does Noah spend?

Back to School Math · 3

A pencil box is 8 inches long, 4 inches wide and 3 inches tall. What is its volume in cubic inches?

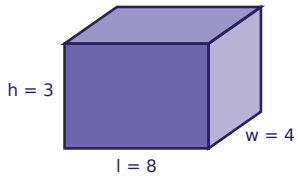

Back to School Math · 4

One backpack costs $13.50. Ava buys 2 backpacks. How much does Ava spend?

Back to School Math · 5

A pencil box is 5 inches long, 8 inches wide and 7 inches tall. What is its volume in cubic inches?

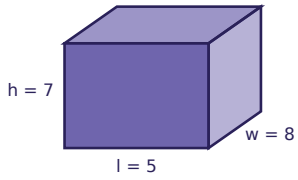

Back to School Math · 6

One batch of a recipe uses $\frac{3}{4}$ cup of oats. Mia makes 3 batches. How many cups of oats does Mia use?

Back to School Math · 7

One batch of a recipe uses $\frac{1}{3}$ cup of oats. Ella makes 3 batches. How many cups of oats does Ella use?

Back to School Math · 8

Leo buys a box of crayons for $2.55 and pays with a $10 bill. How much change does Leo get?

Back to School Math · 2

ANSWER

$73.00

Back to School Math · 1

ANSWER

$6.65

Back to School Math · 4

ANSWER

$27.00

Back to School Math · 3

ANSWER

96

Back to School Math · 6

ANSWER

$$2\frac{1}{4}$$

Back to School Math · 5

ANSWER

280

Back to School Math · 8

ANSWER

$7.45

Back to School Math · 7

ANSWER

1

Back to School Math · 9

Ben buys a backpack for $14.41 and pays with a $20 bill. How much change does Ben get?

Back to School Math · 10

Leo buys a box of crayons for $4.23 and pays with a $10 bill. How much change does Leo get?

Back to School Math · 11

One notebook costs $1.70. Ben buys 5 notebooks. How much does Ben spend?

Back to School Math · 12

One batch of a recipe uses $\frac{2}{3}$ cup of oats. Leo makes 2 batches. How many cups of oats does Leo use?

Back to School Math · 13

A pencil box is 9 inches long, 3 inches wide and 8 inches tall. What is its volume in cubic inches?

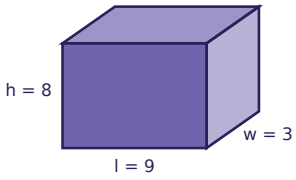

Back to School Math · 14

One box of crayons costs $2.15. Leo buys 6 boxes of crayons. How much does Leo spend?

Back to School Math · 15

One batch of a recipe uses $\frac{3}{8}$ cup of oats. Ella makes 4 batches. How many cups of oats does Ella use?

Back to School Math · 16

A pencil box is 4 inches long, 3 inches wide and 6 inches tall. What is its volume in cubic inches?

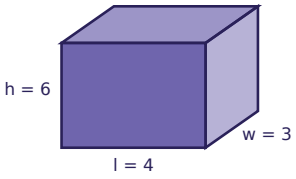

Back to School Math · 10

ANSWER

$5.77

Back to School Math · 9

ANSWER

$5.59

Back to School Math · 12

ANSWER

$1\frac{1}{3}$

Back to School Math · 11

ANSWER

$8.50

Back to School Math · 14

ANSWER

$12.90

Back to School Math · 13

ANSWER

216

Back to School Math · 16

ANSWER

72

Back to School Math · 15

ANSWER

$1\frac{1}{2}$

One batch of a recipe uses $\frac{3}{4}$ cup of oats. Ava makes 5 batches. How many cups of oats does Ava use?

Leo buys a notebook for $2.78 and pays with a $10 bill. How much change does Leo get?

A pencil box is 10 inches long, 7 inches wide and 5 inches tall. What is its volume in cubic inches?

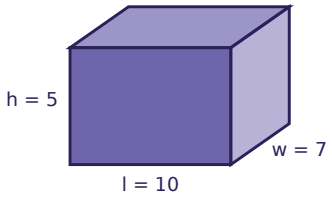

A pencil box is 5 inches long, 8 inches wide and 8 inches tall. What is its volume in cubic inches?

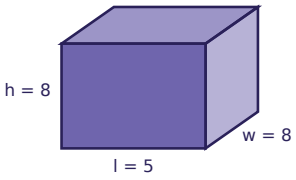

One backpack costs $12.35. Zoe buys 9 backpacks. How much does Zoe spend?

One batch of a recipe uses $\frac{5}{8}$ cup of oats. Mia makes 3 batches. How many cups of oats does Mia use?

One backpack costs $17.20. Omar buys 4 backpacks. How much does Omar spend?

Noah buys a backpack for $16.30 and pays with a $20 bill. How much change does Noah get?

Back to School Math · 18

ANSWER

$7.22

Back to School Math · 17

ANSWER

$$3\frac{3}{4}$$

Back to School Math · 20

ANSWER

320

Back to School Math · 19

ANSWER

350

Back to School Math · 22

ANSWER

$$1\frac{7}{8}$$

Back to School Math · 21

ANSWER

$111.15

Back to School Math · 24

ANSWER

$3.70

Back to School Math · 23

ANSWER

$68.80