Back to School Math · 1

A pencil box is 8 inches long, 10 inches wide and 4 inches tall. What is its volume in cubic inches?

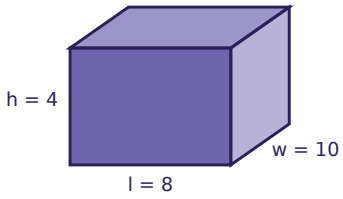

Back to School Math · 2

Lily buys a box of crayons for $3.60 and pays with a $10 bill. How much change does Lily get?

Back to School Math · 3

One notebook costs $1.35. Omar buys 3 notebooks. How much does Omar spend?

Back to School Math · 4

One box of crayons costs $4.95. Noah buys 4 boxes of crayons. How much does Noah spend?

Back to School Math · 5

A pencil box is 12 inches long, 9 inches wide and 8 inches tall. What is its volume in cubic inches?

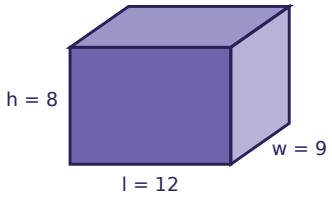

Back to School Math · 6

One batch of a recipe uses $\frac{5}{8}$ cup of oats. Noah makes 5 batches. How many cups of oats does Noah use?

Back to School Math · 7

Leo buys a notebook for $3.16 and pays with a $10 bill. How much change does Leo get?

Back to School Math · 8

One batch of a recipe uses $\frac{2}{3}$ cup of oats. Sam makes 3 batches. How many cups of oats does Sam use?

Back to School Math · 2

ANSWER

$6.40

Back to School Math · 1

ANSWER

320

Back to School Math · 4

ANSWER

$19.80

Back to School Math · 3

ANSWER

$4.05

Back to School Math · 6

ANSWER

$3\frac{1}{8}$

Back to School Math · 5

ANSWER

864

Back to School Math · 8

ANSWER

2

Back to School Math · 7

ANSWER

$6.84

Back to School Math · 9

Omar buys a notebook for $1.72 and pays with a $10 bill. How much change does Omar get?

Back to School Math · 10

One backpack costs $18.20. Ella buys 5 backpacks. How much does Ella spend?

Back to School Math · 11

One batch of a recipe uses $\frac{5}{8}$ cup of oats. Sam makes 3 batches. How many cups of oats does Sam use?

Back to School Math · 12

A pencil box is 12 inches long, 7 inches wide and 2 inches tall. What is its volume in cubic inches?

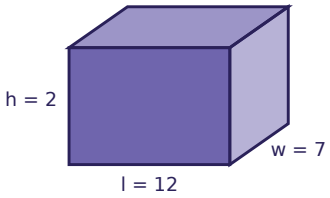

Back to School Math · 13

One batch of a recipe uses $\frac{2}{3}$ cup of oats. Sam makes 5 batches. How many cups of oats does Sam use?

Back to School Math · 14

One notebook costs $3.75. Ella buys 3 notebooks. How much does Ella spend?

Back to School Math · 15

Lily buys a backpack for $16.87 and pays with a $20 bill. How much change does Lily get?

Back to School Math · 16

A pencil box is 10 inches long, 4 inches wide and 7 inches tall. What is its volume in cubic inches?

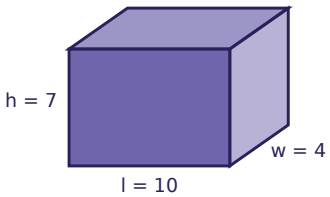

Back to School Math · 10

ANSWER

$91.00

Back to School Math · 9

ANSWER

$8.28

Back to School Math · 12

ANSWER

168

Back to School Math · 11

ANSWER

$$1\frac{7}{8}$$

Back to School Math · 14

ANSWER

$11.25

Back to School Math · 13

ANSWER

$$3\frac{1}{3}$$

Back to School Math · 16

ANSWER

280

Back to School Math · 15

ANSWER

$3.13

Back to School Math · 17

A pencil box is 9 inches long, 3 inches wide and 4 inches tall. What is its volume in cubic inches?

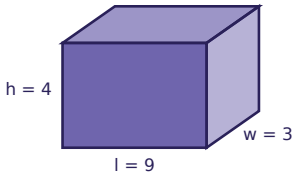

Back to School Math · 18

One batch of a recipe uses $\frac{2}{3}$ cup of oats. Zoe makes 4 batches. How many cups of oats does Zoe use?

Back to School Math · 19

One batch of a recipe uses $\frac{3}{8}$ cup of oats. Leo makes 3 batches. How many cups of oats does Leo use?

Back to School Math · 20

A pencil box is 5 inches long, 7 inches wide and 3 inches tall. What is its volume in cubic inches?

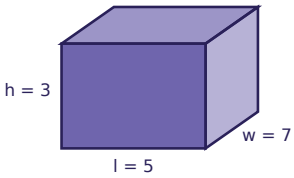

Back to School Math · 21

One box of crayons costs $3.90. Lily buys 6 boxes of crayons. How much does Lily spend?

Back to School Math · 22

Omar buys a notebook for $1.66 and pays with a $10 bill. How much change does Omar get?

Back to School Math · 23

One box of crayons costs $2.95. Zoe buys 9 boxes of crayons. How much does Zoe spend?

Back to School Math · 24

Ava buys a notebook for $3.74 and pays with a $10 bill. How much change does Ava get?

Back to School Math · 18

ANSWER

$2\frac{2}{3}$

Back to School Math · 17

ANSWER

108

Back to School Math · 20

ANSWER

105

Back to School Math · 19

ANSWER

$1\frac{1}{8}$

Back to School Math · 22

ANSWER

$8.34

Back to School Math · 21

ANSWER

$23.40

Back to School Math · 24

ANSWER

$6.26

Back to School Math · 23

ANSWER

$26.55