Back to School Math · 1

One box of crayons costs $3.70. Omar buys 2 boxes of crayons. How much does Omar spend?

Back to School Math · 2

Noah buys a backpack for $18.30 and pays with a $20 bill. How much change does Noah get?

Back to School Math · 3

One batch of a recipe uses $\frac{3}{4}$ cup of oats. Ava makes 3 batches. How many cups of oats does Ava use?

Back to School Math · 4

A pencil box is 4 inches long, 4 inches wide and 2 inches tall. What is its volume in cubic inches?

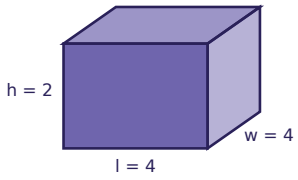

Back to School Math · 5

Noah buys a box of crayons for $2.65 and pays with a $10 bill. How much change does Noah get?

Back to School Math · 6

A pencil box is 7 inches long, 3 inches wide and 4 inches tall. What is its volume in cubic inches?

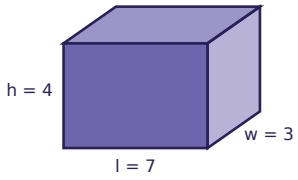

Back to School Math · 7

One backpack costs $15.85. Zoe buys 2 backpacks. How much does Zoe spend?

Back to School Math · 8

One batch of a recipe uses $\frac{3}{4}$ cup of oats. Lily makes 3 batches. How many cups of oats does Lily use?

Back to School Math · 2

ANSWER

$1.70

Back to School Math · 1

ANSWER

$7.40

Back to School Math · 4

ANSWER

32

Back to School Math · 3

ANSWER

$$2\frac{1}{4}$$

Back to School Math · 6

ANSWER

84

Back to School Math · 5

ANSWER

$7.35

Back to School Math · 8

ANSWER

$$2\frac{1}{4}$$

Back to School Math · 7

ANSWER

$31.70

One backpack costs $17.65. Omar buys 3 backpacks. How much does Omar spend?

One backpack costs $16.25. Omar buys 3 backpacks. How much does Omar spend?

Noah buys a box of crayons for $3.05 and pays with a $10 bill. How much change does Noah get?

A pencil box is 6 inches long, 5 inches wide and 5 inches tall. What is its volume in cubic inches?

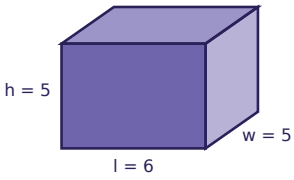

A pencil box is 7 inches long, 4 inches wide and 2 inches tall. What is its volume in cubic inches?

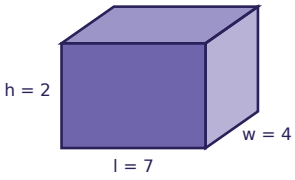

One batch of a recipe uses $\frac{1}{3}$ cup of oats. Omar makes 3 batches. How many cups of oats does Omar use?

One batch of a recipe uses $\frac{3}{4}$ cup of oats. Leo makes 4 batches. How many cups of oats does Leo use?

Sam buys a backpack for $17.15 and pays with a $20 bill. How much change does Sam get?

Back to School Math · 10

ANSWER

$48.75

Back to School Math · 9

ANSWER

$52.95

Back to School Math · 12

ANSWER

150

Back to School Math · 11

ANSWER

$6.95

Back to School Math · 14

ANSWER

1

Back to School Math · 13

ANSWER

56

Back to School Math · 16

ANSWER

$2.85

Back to School Math · 15

ANSWER

3

Back to School Math · 17

A pencil box is 9 inches long, 6 inches wide and 2 inches tall. What is its volume in cubic inches?

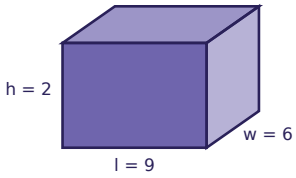

Back to School Math · 18

A pencil box is 5 inches long, 4 inches wide and 4 inches tall. What is its volume in cubic inches?

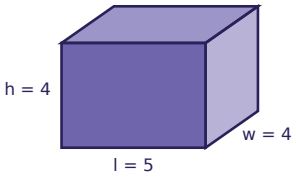

Back to School Math · 19

Lily buys a backpack for $14.90 and pays with a $20 bill. How much change does Lily get?

Back to School Math · 20

Sam buys a backpack for $12.20 and pays with a $20 bill. How much change does Sam get?

Back to School Math · 21

One batch of a recipe uses $\frac{1}{2}$ cup of oats. Ben makes 4 batches. How many cups of oats does Ben use?

Back to School Math · 22

One backpack costs $17.85. Ella buys 3 backpacks. How much does Ella spend?

Back to School Math · 23

One batch of a recipe uses $\frac{1}{4}$ cup of oats. Sam makes 4 batches. How many cups of oats does Sam use?

Back to School Math · 24

One backpack costs $16.50. Ava buys 6 backpacks. How much does Ava spend?

Back to School Math · 18

ANSWER

80

Back to School Math · 17

ANSWER

108

Back to School Math · 20

ANSWER

$7.80

Back to School Math · 19

ANSWER

$5.10

Back to School Math · 22

ANSWER

$53.55

Back to School Math · 21

ANSWER

2

Back to School Math · 24

ANSWER

$99.00

Back to School Math · 23

ANSWER

1