Task card 1 Adding Fractions with Unlike Denom...

$$\frac{2}{5} + \frac{1}{2} = ___$$

Task card 2 Adding Fractions with Unlike Denom...

$$\frac{1}{6} + \frac{2}{5} = ___$$

Task card 3 Adding Fractions with Unlike Denom...

Each bar shows one of the fractions.

$\frac{1}{6} + \frac{1}{5} = ___$

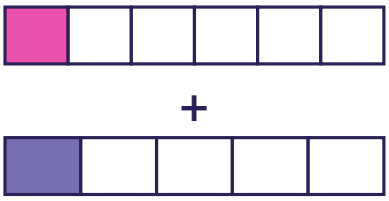

Task card 4 Adding Fractions with Unlike Denom...

What is the least common denominator (LCD) of $\frac{1}{3}$ and $\frac{3}{5}$?

Task card 5 Adding Fractions with Unlike Denom...

$$\frac{1}{5} + \frac{1}{4} = \frac{4}{20} + \frac{5}{20} = ___$$

Task card 6 Adding Fractions with Unlike Denom...

Mia says $\frac{1}{2} + \frac{2}{5} = \frac{3}{10}$. Is Mia right? Write yes or no.

Task card 7 Adding Fractions with Unlike Denom...

Lily walked $\frac{1}{3}$ mile to school and then $\frac{1}{5}$ mile to the library. How many miles did Lily walk in all?

Task card 8 Adding Fractions with Unlike Denom...

$$\frac{1}{2} + \underline{\quad} = \frac{7}{10}$$

Task card 9 Adding Fractions with Unlike Denom...

$$\frac{7}{9} + \frac{1}{6} = \underline{\quad}$$

Task card 10 Adding Fractions with Unlike Denom...

$$\frac{1}{12} + \frac{7}{8} = \underline{\quad}$$

Task card 11 Adding Fractions with Unlike Denom...

Each bar shows one of the fractions.

$$\frac{1}{4} + \frac{7}{10} = \underline{\quad}$$

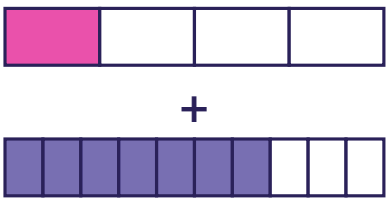

Task card 12 Adding Fractions with Unlike Denom...

What is the least common denominator (LCD) of $\frac{1}{8}$ and $\frac{5}{12}$?

Task card 13 Adding Fractions with Unlike Denom...

$\frac{5}{8} + \frac{1}{6} = \frac{15}{24} + \frac{4}{24} =$ ___

Task card 14 Adding Fractions with Unlike Denom...

Mia says $\frac{1}{6} + \frac{1}{4} = \frac{1}{6}$. Is Mia right? Write yes or no.

Task card 15 Adding Fractions with Unlike Denom...

A recipe uses $\frac{5}{8}$ cup of flour and $\frac{1}{6}$ cup of sugar. How many cups is that in all?

Task card 16 Adding Fractions with Unlike Denom...

$\frac{3}{10} + ___ = \frac{11}{20}$

Task card 17 Adding Fractions with Unlike Denom...

$\frac{7}{10} + \frac{3}{4} =$ ___

Task card 18 Adding Fractions with Unlike Denom...

$\frac{4}{5} + \frac{2}{3} =$ ___

Task card 19 Adding Fractions with Unlike Denom...

Each bar shows one of the fractions.

$\frac{5}{9} + \frac{2}{3} = ___$

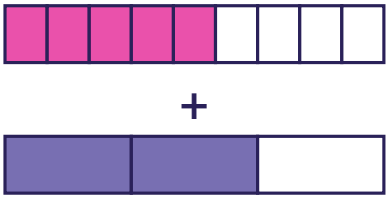

Task card 20 Adding Fractions with Unlike Denom...

What is the least common denominator (LCD) of $\frac{3}{5}$ and $\frac{3}{4}$?

Task card 21 Adding Fractions with Unlike Denom...

$\frac{7}{10} + \frac{8}{9} = \frac{63}{90} + \frac{80}{90} = ___$

Task card 22 Adding Fractions with Unlike Denom...

Nora says $\frac{7}{8} + \frac{2}{9} = \frac{1}{8}$. Is Nora right? Write yes or no.

Task card 23 Adding Fractions with Unlike Denom...

Nora walked $\frac{3}{4}$ mile to school and then $\frac{8}{9}$ mile to the library. How many miles did Nora walk in all?

Task card 24 Adding Fractions with Unlike Denom...

$\frac{8}{9} + ___ = 1\frac{19}{72}$

Adding Fractions with Unlike Denominators Task Cards

Recording sheet · Grade 5 · Answer each question. The same kind of sum comes in different shapes. Write fractions in simplest form, as a mixed number if greater than 1.

Scan to check your answers

Name: _____ Date: _____

1	2	3	4
5	6	7	8
9	10	11	12
13	14	15	16
17	18	19	20
21	22	23	24

Adding Fractions with Unlike Denominators Task Cards: Answer Key

Grade 5 · Medium

The answers online

1. $\frac{9}{10}$	**2.** $\frac{17}{30}$	**3.** $\frac{11}{30}$
4. 15	**5.** $\frac{9}{20}$	**6.** no
7. $\frac{8}{15}$	**8.** $\frac{1}{5}$	**9.** $\frac{17}{18}$
10. $\frac{23}{24}$	**11.** $\frac{19}{20}$	**12.** 24
13. $\frac{19}{24}$	**14.** no	**15.** $\frac{19}{24}$
16. $\frac{1}{4}$	**17.** $1\frac{9}{20}$	**18.** $1\frac{7}{15}$
19. $1\frac{2}{9}$	**20.** 20	**21.** $1\frac{53}{90}$
22. no	**23.** $1\frac{23}{36}$	**24.** $\frac{3}{8}$