**Task card 1** Adding Fractions with Unlike Denom...

$$\frac{2}{5} + \frac{1}{2} = ___$$

**Task card 2** Adding Fractions with Unlike Denom...

$$\frac{1}{6} + \frac{2}{5} = ___$$

**Task card 3** Adding Fractions with Unlike Denom...

Each bar shows one of the fractions.

$\frac{1}{6} + \frac{1}{5} = ___$

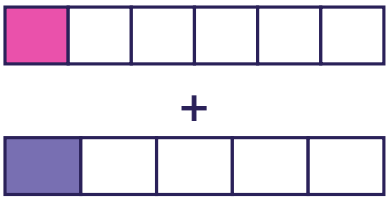

**Task card 4** Adding Fractions with Unlike Denom...

What is the least common denominator (LCD) of $\frac{1}{3}$ and $\frac{3}{5}$?

**Task card 5** Adding Fractions with Unlike Denom...

$$\frac{1}{5} + \frac{1}{4} = \frac{4}{20} + \frac{5}{20} = ___$$

**Task card 6** Adding Fractions with Unlike Denom...

Mia says $\frac{1}{2} + \frac{2}{5} = \frac{3}{10}$. Is Mia right? Write yes or no.

**Task card 7** Adding Fractions with Unlike Denom...

Lily walked $\frac{1}{3}$ mile to school and then $\frac{1}{5}$ mile to the library. How many miles did Lily walk in all?

**Task card 8** Adding Fractions with Unlike Denom...

$$\frac{1}{2} + \underline{\quad} = \frac{7}{10}$$

**Task card 9** Adding Fractions with Unlike Denom...

$$\frac{7}{9} + \frac{1}{6} = \underline{\quad}$$

**Task card 10** Adding Fractions with Unlike Denom...

$$\frac{1}{12} + \frac{7}{8} = \underline{\quad}$$

**Task card 11** Adding Fractions with Unlike Denom...

Each bar shows one of the fractions.

$$\frac{1}{4} + \frac{7}{10} = \underline{\quad}$$

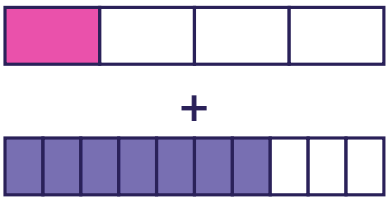

**Task card 12** Adding Fractions with Unlike Denom...

What is the least common denominator (LCD) of $\frac{1}{8}$ and $\frac{5}{12}$?

**Task card 13** Adding Fractions with Unlike Denom...

$$\frac{5}{8} + \frac{1}{6} = \frac{15}{24} + \frac{4}{24} = ___$$

**Task card 14** Adding Fractions with Unlike Denom...

Mia says $\frac{1}{6} + \frac{1}{4} = \frac{1}{6}$. Is Mia right? Write yes or no.

**Task card 15** Adding Fractions with Unlike Denom...

A recipe uses $\frac{5}{8}$ cup of flour and $\frac{1}{6}$ cup of sugar. How many cups is that in all?

**Task card 16** Adding Fractions with Unlike Denom...

$$\frac{3}{10} + ___ = \frac{11}{20}$$

**Task card 17** Adding Fractions with Unlike Denom...

$$\frac{7}{10} + \frac{3}{4} = ___$$

**Task card 18** Adding Fractions with Unlike Denom...

$$\frac{4}{5} + \frac{2}{3} = ___$$

**Task card 19** Adding Fractions with Unlike Denom...

Each bar shows one of the fractions.

$\frac{5}{9} + \frac{2}{3} = ___$

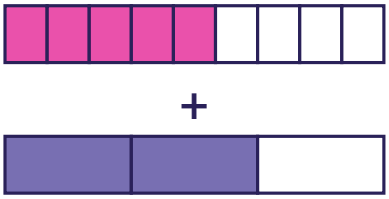

**Task card 20** Adding Fractions with Unlike Denom...

What is the least common denominator (LCD) of $\frac{3}{5}$ and $\frac{3}{4}$?

**Task card 21** Adding Fractions with Unlike Denom...

$\frac{7}{10} + \frac{8}{9} = \frac{63}{90} + \frac{80}{90} = ___$

**Task card 22** Adding Fractions with Unlike Denom...

Nora says $\frac{7}{8} + \frac{2}{9} = \frac{1}{8}$. Is Nora right? Write yes or no.

**Task card 23** Adding Fractions with Unlike Denom...

Nora walked $\frac{3}{4}$ mile to school and then $\frac{8}{9}$ mile to the library. How many miles did Nora walk in all?

**Task card 24** Adding Fractions with Unlike Denom...

$\frac{8}{9} + ___ = 1\frac{19}{72}$

# Adding Fractions with Unlike Denominators Task Cards

Recording sheet · Grade 5 · Answer each question. The same kind of sum comes in different shapes. Write fractions in simplest form, as a mixed number if greater than 1.

Scan to check your answers

Name: _____ Date: _____

| | | | |
|---|---|---|---|
| 1 | 2 | 3 | 4 |
| 5 | 6 | 7 | 8 |
| 9 | 10 | 11 | 12 |
| 13 | 14 | 15 | 16 |
| 17 | 18 | 19 | 20 |
| 21 | 22 | 23 | 24 |

# Adding Fractions with Unlike Denominators Task Cards: Answer Key

Grade 5 · Medium

The answers online

| | | |
|---|---|---|
| **1.** $\frac{9}{10}$ | **2.** $\frac{17}{30}$ | **3.** $\frac{11}{30}$ |
| **4.** 15 | **5.** $\frac{9}{20}$ | **6.** no |
| **7.** $\frac{8}{15}$ | **8.** $\frac{1}{5}$ | **9.** $\frac{17}{18}$ |
| **10.** $\frac{23}{24}$ | **11.** $\frac{19}{20}$ | **12.** 24 |
| **13.** $\frac{19}{24}$ | **14.** no | **15.** $\frac{19}{24}$ |
| **16.** $\frac{1}{4}$ | **17.** $1\frac{9}{20}$ | **18.** $1\frac{7}{15}$ |
| **19.** $1\frac{2}{9}$ | **20.** 20 | **21.** $1\frac{53}{90}$ |
| **22.** no | **23.** $1\frac{23}{36}$ | **24.** $\frac{3}{8}$ |