Task card 1 Adding Fractions with Unlike Denom...

$$\frac{1}{4} + \frac{1}{2} = ___$$

Task card 2 Adding Fractions with Unlike Denom...

$$\frac{1}{6} + \frac{2}{3} = ___$$

Task card 3 Adding Fractions with Unlike Denom...

Each bar shows one of the fractions.

$\frac{1}{4} + \frac{1}{2} = ___$

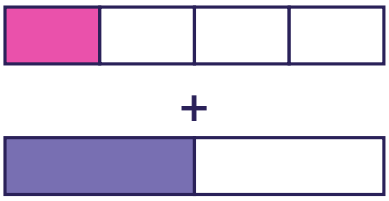

Task card 4 Adding Fractions with Unlike Denom...

What is the least common denominator (LCD) of $\frac{1}{4}$ and $\frac{5}{8}$?

Task card 5 Adding Fractions with Unlike Denom...

$$\frac{1}{4} + \frac{1}{2} = \frac{1}{4} + \frac{2}{4} = ___$$

Task card 6 Adding Fractions with Unlike Denom...

Eli says $\frac{2}{3} + \frac{1}{6} = \frac{5}{6}$. Is Eli right?

Write yes or no.

Task card 7 Adding Fractions with Unlike Denom...

Sam walked $\frac{1}{4}$ mile to school and then $\frac{5}{8}$ mile to the library. How many miles did Sam walk in all?

Task card 8 Adding Fractions with Unlike Denom...

$$\frac{1}{12} + \underline{\quad} = \frac{11}{12}$$

Task card 9 Adding Fractions with Unlike Denom...

$$\frac{4}{9} + \frac{1}{3} = \underline{\quad}$$

Task card 10 Adding Fractions with Unlike Denom...

$$\frac{2}{9} + \frac{1}{3} = \underline{\quad}$$

Task card 11 Adding Fractions with Unlike Denom...

Each bar shows one of the fractions.

$$\frac{1}{4} + \frac{1}{12} = \underline{\quad}$$

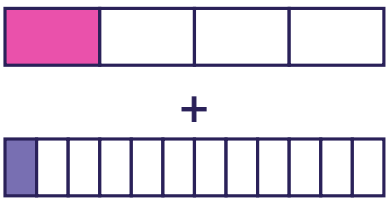

Task card 12 Adding Fractions with Unlike Denom...

What is the least common denominator (LCD) of $\frac{1}{2}$ and $\frac{1}{8}$?

Task card 13 Adding Fractions with Unlike Denom...

$\frac{1}{6} + \frac{1}{2} = \frac{1}{6} + \frac{3}{6} = ___$

Task card 14 Adding Fractions with Unlike Denom...

Mia says $\frac{1}{2} + \frac{1}{6} = \frac{2}{3}$. Is Mia right? Write yes or no.

Task card 15 Adding Fractions with Unlike Denom...

A bucket holds $\frac{1}{4}$ liter of water. Eli pours in $\frac{7}{12}$ liter more. How many liters of water are in the bucket now?

Task card 16 Adding Fractions with Unlike Denom...

$\frac{1}{8} + ___ = \frac{5}{8}$

Task card 17 Adding Fractions with Unlike Denom...

$\frac{1}{4} + \frac{2}{5} = ___$

Task card 18 Adding Fractions with Unlike Denom...

$\frac{1}{5} + \frac{2}{3} = ___$

Task card 19 Adding Fractions with Unlike Denom...

Each bar shows one of the fractions.

$\frac{1}{5} + \frac{1}{2} = ___$

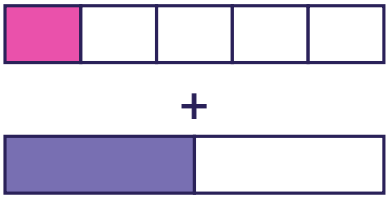

Task card 20 Adding Fractions with Unlike Denom...

What is the least common denominator (LCD) of $\frac{1}{5}$ and $\frac{1}{3}$?

Task card 21 Adding Fractions with Unlike Denom...

$$\frac{1}{2} + \frac{2}{5} = \frac{5}{10} + \frac{4}{10} = \frac{\quad}{\quad}$$

Task card 22 Adding Fractions with Unlike Denom...

Lily says $\frac{1}{4} + \frac{1}{3} = \frac{1}{6}$. Is Lily right? Write yes or no.

Task card 23 Adding Fractions with Unlike Denom...

Lily read for $\frac{1}{3}$ hour on Saturday and $\frac{1}{2}$ hour on Sunday. How many hours did Lily read in all?

Task card 24 Adding Fractions with Unlike Denom...

$$\frac{1}{2} + \frac{\quad}{\quad} = \frac{9}{10}$$

Adding Fractions with Unlike Denominators Task Cards

Recording sheet · Grade 5 · Answer each question. The same kind of sum comes in different shapes. Write fractions in simplest form, as a mixed number if greater than 1.

Scan to check your answers

Name: _____ Date: _____

1	2	3	4
5	6	7	8
9	10	11	12
13	14	15	16
17	18	19	20
21	22	23	24

Adding Fractions with Unlike Denominators Task Cards: Answer Key

Grade 5 · Easy

The answers online

1. $\frac{3}{4}$	**2.** $\frac{5}{6}$	**3.** $\frac{3}{4}$
4. 8	**5.** $\frac{3}{4}$	**6.** yes
7. $\frac{7}{8}$	**8.** $\frac{5}{6}$	**9.** $\frac{7}{9}$
10. $\frac{5}{9}$	**11.** $\frac{1}{3}$	**12.** 8
13. $\frac{2}{3}$	**14.** yes	**15.** $\frac{5}{6}$
16. $\frac{1}{2}$	**17.** $\frac{13}{20}$	**18.** $\frac{13}{15}$
19. $\frac{7}{10}$	**20.** 15	**21.** $\frac{9}{10}$
22. no	**23.** $\frac{5}{6}$	**24.** $\frac{2}{5}$