Adding Fractions with Unlike Denominators · 1

$\frac{2}{5} + \frac{1}{2} = ___$

Adding Fractions with Unlike Denominators · 2

$\frac{1}{6} + \frac{2}{5} = ___$

Adding Fractions with Unlike Denominators · 3

Each bar shows one of the fractions. $\frac{1}{6} + \frac{1}{5} = ___$

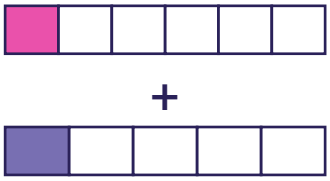

Adding Fractions with Unlike Denominators · 4

What is the least common denominator (LCD) of $\frac{1}{3}$ and $\frac{3}{5}$?

Adding Fractions with Unlike Denominators · 5

$\frac{1}{5} + \frac{1}{4} = \frac{4}{20} + \frac{5}{20} = ___$

Adding Fractions with Unlike Denominators · 6

Mia says $\frac{1}{2} + \frac{2}{5} = \frac{3}{10}$. Is Mia right?

Write yes or no.

Adding Fractions with Unlike Denominators · 7

Lily walked $\frac{1}{3}$ mile to school and then $\frac{1}{5}$ mile to the library. How many miles did Lily walk in all?

Adding Fractions with Unlike Denominators · 8

$\frac{1}{2} + ___ = \frac{7}{10}$

Adding Fractions with Unlike Denominators · 2

ANSWER

$\frac{17}{30}$

Adding Fractions with Unlike Denominators · 1

ANSWER

$\frac{9}{10}$

Adding Fractions with Unlike Denominators · 4

ANSWER

15

Adding Fractions with Unlike Denominators · 3

ANSWER

$\frac{11}{30}$

Adding Fractions with Unlike Denominators · 6

ANSWER

no

Adding Fractions with Unlike Denominators · 5

ANSWER

$\frac{9}{20}$

Adding Fractions with Unlike Denominators · 8

ANSWER

$\frac{1}{5}$

Adding Fractions with Unlike Denominators · 7

ANSWER

$\frac{8}{15}$

Adding Fractions with Unlike Denominators · 9

$$\frac{7}{9} + \frac{1}{6} = ___$$

Adding Fractions with Unlike Denominators · 10

$$\frac{1}{12} + \frac{7}{8} = ___$$

Adding Fractions with Unlike Denominators · 11

Each bar shows one of the fractions. $\frac{1}{4} + \frac{7}{10} = ___$

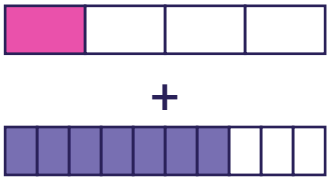

Adding Fractions with Unlike Denominators · 12

What is the least common denominator (LCD) of $\frac{1}{8}$ and $\frac{5}{12}$?

Adding Fractions with Unlike Denominators · 13

$$\frac{5}{8} + \frac{1}{6} = \frac{15}{24} + \frac{4}{24} = ___$$

Adding Fractions with Unlike Denominators · 14

Mia says $\frac{1}{6} + \frac{1}{4} = \frac{1}{6}$. Is Mia right?

Write yes or no.

Adding Fractions with Unlike Denominators · 15

A recipe uses $\frac{5}{8}$ cup of flour and $\frac{1}{6}$ cup of sugar. How many cups is that in all?

Adding Fractions with Unlike Denominators · 16

$$\frac{3}{10} + ___ = \frac{11}{20}$$

Adding Fractions with Unlike Denominators · 10

ANSWER

$\frac{23}{24}$

Adding Fractions with Unlike Denominators · 9

ANSWER

$\frac{17}{18}$

Adding Fractions with Unlike Denominators · 12

ANSWER

24

Adding Fractions with Unlike Denominators · 11

ANSWER

$\frac{19}{20}$

Adding Fractions with Unlike Denominators · 14

ANSWER

no

Adding Fractions with Unlike Denominators · 13

ANSWER

$\frac{19}{24}$

Adding Fractions with Unlike Denominators · 16

ANSWER

$\frac{1}{4}$

Adding Fractions with Unlike Denominators · 15

ANSWER

$\frac{19}{24}$

Adding Fractions with Unlike Denominators · 17

$\frac{7}{10} + \frac{3}{4} = ___$

Adding Fractions with Unlike Denominators · 18

$\frac{4}{5} + \frac{2}{3} = ___$

Adding Fractions with Unlike Denominators · 19

Each bar shows one of the fractions. $\frac{5}{9} + \frac{2}{3} = ___$

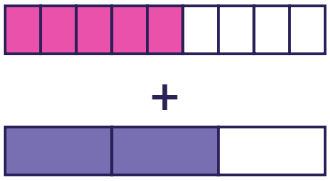

Adding Fractions with Unlike Denominators · 20

What is the least common denominator (LCD) of $\frac{3}{5}$ and $\frac{3}{4}$?

Adding Fractions with Unlike Denominators · 21

$\frac{7}{10} + \frac{8}{9} = \frac{63}{90} + \frac{80}{90} = ___$

Adding Fractions with Unlike Denominators · 22

Nora says $\frac{7}{8} + \frac{2}{9} = \frac{1}{8}$. Is Nora right?

Write yes or no.

Adding Fractions with Unlike Denominators · 23

Nora walked $\frac{3}{4}$ mile to school and then $\frac{8}{9}$ mile to the library. How many miles did Nora walk in all?

Adding Fractions with Unlike Denominators · 24

$\frac{8}{9} + ___ = 1\frac{19}{72}$

Adding Fractions with Unlike Denominators · 18

ANSWER

$$1\frac{7}{15}$$

Adding Fractions with Unlike Denominators · 17

ANSWER

$$1\frac{9}{20}$$

Adding Fractions with Unlike Denominators · 20

ANSWER

20

Adding Fractions with Unlike Denominators · 19

ANSWER

$$1\frac{2}{9}$$

Adding Fractions with Unlike Denominators · 22

ANSWER

no

Adding Fractions with Unlike Denominators · 21

ANSWER

$$1\frac{53}{90}$$

Adding Fractions with Unlike Denominators · 24

ANSWER

$$\frac{3}{8}$$

Adding Fractions with Unlike Denominators · 23

ANSWER

$$1\frac{23}{36}$$