Adding Fractions with Unlike Denominators · 1

$\frac{1}{4} + \frac{1}{2} = ___$

Adding Fractions with Unlike Denominators · 2

$\frac{1}{6} + \frac{2}{3} = ___$

Adding Fractions with Unlike Denominators · 3

Each bar shows one of the fractions. $\frac{1}{4} + \frac{1}{2} = ___$

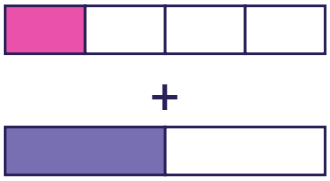

Adding Fractions with Unlike Denominators · 4

What is the least common denominator (LCD) of $\frac{1}{4}$ and $\frac{5}{8}$?

Adding Fractions with Unlike Denominators · 5

$\frac{1}{4} + \frac{1}{2} = \frac{1}{4} + \frac{2}{4} = ___$

Adding Fractions with Unlike Denominators · 6

Eli says $\frac{2}{3} + \frac{1}{6} = \frac{5}{6}$. Is Eli right? Write yes or no.

Adding Fractions with Unlike Denominators · 7

Sam walked $\frac{1}{4}$ mile to school and then $\frac{5}{8}$ mile to the library. How many miles did Sam walk in all?

Adding Fractions with Unlike Denominators · 8

$\frac{1}{12} + ___ = \frac{11}{12}$

Adding Fractions with Unlike Denominators · 2

ANSWER

$\frac{5}{6}$

Adding Fractions with Unlike Denominators · 1

ANSWER

$\frac{3}{4}$

Adding Fractions with Unlike Denominators · 4

ANSWER

8

Adding Fractions with Unlike Denominators · 3

ANSWER

$\frac{3}{4}$

Adding Fractions with Unlike Denominators · 6

ANSWER

yes

Adding Fractions with Unlike Denominators · 5

ANSWER

$\frac{3}{4}$

Adding Fractions with Unlike Denominators · 8

ANSWER

$\frac{5}{6}$

Adding Fractions with Unlike Denominators · 7

ANSWER

$\frac{7}{8}$

Adding Fractions with Unlike Denominators · 9

$\frac{4}{9} + \frac{1}{3} = ___$

Adding Fractions with Unlike Denominators · 10

$\frac{2}{9} + \frac{1}{3} = ___$

Adding Fractions with Unlike Denominators · 11

Each bar shows one of the fractions. $\frac{1}{4} + \frac{1}{12} = ___$

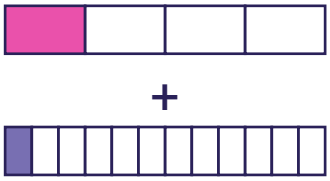

Adding Fractions with Unlike Denominators · 12

What is the least common denominator (LCD) of $\frac{1}{2}$ and $\frac{1}{8}$?

Adding Fractions with Unlike Denominators · 13

$\frac{1}{6} + \frac{1}{2} = \frac{1}{6} + \frac{3}{6} = ___$

Adding Fractions with Unlike Denominators · 14

Mia says $\frac{1}{2} + \frac{1}{6} = \frac{2}{3}$. Is Mia right?

Write yes or no.

Adding Fractions with Unlike Denominators · 15

A bucket holds $\frac{1}{4}$ liter of water. Eli pours in $\frac{7}{12}$ liter more. How many liters of water are in the bucket now?

Adding Fractions with Unlike Denominators · 16

$\frac{1}{8} + ___ = \frac{5}{8}$

Adding Fractions with Unlike Denominators · 10

ANSWER

$\frac{5}{9}$

Adding Fractions with Unlike Denominators · 9

ANSWER

$\frac{7}{9}$

Adding Fractions with Unlike Denominators · 12

ANSWER

8

Adding Fractions with Unlike Denominators · 11

ANSWER

$\frac{1}{3}$

Adding Fractions with Unlike Denominators · 14

ANSWER

yes

Adding Fractions with Unlike Denominators · 13

ANSWER

$\frac{2}{3}$

Adding Fractions with Unlike Denominators · 16

ANSWER

$\frac{1}{2}$

Adding Fractions with Unlike Denominators · 15

ANSWER

$\frac{5}{6}$

Adding Fractions with Unlike Denominators · 17

$\frac{1}{4} + \frac{2}{5} = ___$

Adding Fractions with Unlike Denominators · 18

$\frac{1}{5} + \frac{2}{3} = ___$

Adding Fractions with Unlike Denominators · 19

Each bar shows one of the fractions. $\frac{1}{5} + \frac{1}{2} = ___$

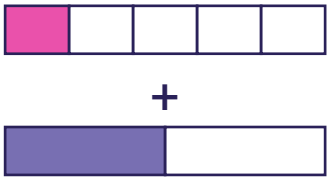

Adding Fractions with Unlike Denominators · 20

What is the least common denominator (LCD) of $\frac{1}{5}$ and $\frac{1}{3}$?

Adding Fractions with Unlike Denominators · 21

$\frac{1}{2} + \frac{2}{5} = \frac{5}{10} + \frac{4}{10} = ___$

Adding Fractions with Unlike Denominators · 22

Lily says $\frac{1}{4} + \frac{1}{3} = \frac{1}{6}$. Is Lily right?

Write yes or no.

Adding Fractions with Unlike Denominators · 23

Lily read for $\frac{1}{3}$ hour on Saturday and $\frac{1}{2}$ hour on Sunday. How many hours did Lily read in all?

Adding Fractions with Unlike Denominators · 24

$\frac{1}{2} + ___ = \frac{9}{10}$

Adding Fractions with Unlike Denominators · 18

ANSWER

$$\frac{13}{15}$$

Adding Fractions with Unlike Denominators · 17

ANSWER

$$\frac{13}{20}$$

Adding Fractions with Unlike Denominators · 20

ANSWER

15

Adding Fractions with Unlike Denominators · 19

ANSWER

$$\frac{7}{10}$$

Adding Fractions with Unlike Denominators · 22

ANSWER

no

Adding Fractions with Unlike Denominators · 21

ANSWER

$$\frac{9}{10}$$

Adding Fractions with Unlike Denominators · 24

ANSWER

$$\frac{2}{5}$$

Adding Fractions with Unlike Denominators · 23

ANSWER

$$\frac{5}{6}$$