Task card 1 Adding Decimals with Hundredths Gr...

The grids show 2.38 in pink and 0.17 in blue. Count all the shaded squares:

2.38 + 0.17 = ___



Task card 2 Adding Decimals with Hundredths Gr...

The pink squares show 1.35. Pink and blue together show 2.81. What number do the blue squares show? 1.35 + ___ = 2.81



Task card 3 Adding Decimals with Hundredths Gr...

The grids show 2.09 in pink and 0.22 in blue. Count all the shaded squares:

2.09 + 0.22 = ___



Task card 4 Adding Decimals with Hundredths Gr...

The pink squares show 0.36. Pink and blue together show 2.31. What number do the blue squares show? 0.36 + ___ = 2.31



Task card 5 Adding Decimals with Hundredths Gr...

The grids show 0.26 in pink and 1.89 in blue. Count all the shaded squares:

0.26 + 1.89 = ___



Task card 6 Adding Decimals with Hundredths Gr...

The pink squares show 0.78. Pink and blue together show 2.41. What number do the blue squares show? 0.78 + ___ = 2.41



Task card 7 Adding Decimals with Hundredths Gr...

The grids show 1.17 in pink and 1.19 in blue. Count all the shaded squares:

1.17 + 1.19 = ___

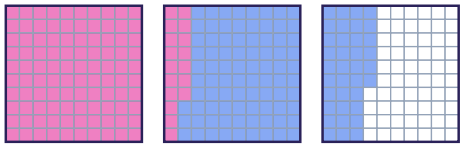

Task card 8 Adding Decimals with Hundredths Gr...

The pink squares show 1.99. Pink and blue together show 2.20. What number do the blue squares show? 1.99 + ___ = 2.20



Task card 9 Adding Decimals with Hundredths Gr...

The grids show 0.17 in pink and 1.97 in blue. Count all the shaded squares:

0.17 + 1.97 = ___



Task card 10 Adding Decimals with Hundredths Gr...

The pink squares show 0.23. Pink and blue together show 2.31. What number do the blue squares show? 0.23 + ___ = 2.31



Task card 11 Adding Decimals with Hundredths Gr...

The grids show 0.59 in pink and 1.78 in blue. Count all the shaded squares:

0.59 + 1.78 = ___



Task card 12 Adding Decimals with Hundredths Gr...

The pink squares show 1.99. Pink and blue together show 2.74. What number do the blue squares show? 1.99 + ___ = 2.74



Task card 13 Adding Decimals with Hundredths Gr...

The grids show 1.79 in pink and 0.73 in blue. Count all the shaded squares:

1.79 + 0.73 = ___



Task card 14 Adding Decimals with Hundredths Gr...

The pink squares show 0.37. Pink and blue together show 2.52. What number do the blue squares show? 0.37 + ___ = 2.52



Task card 15 Adding Decimals with Hundredths Gr...

The grids show 2.54 in pink and 0.26 in blue. Count all the shaded squares:

2.54 + 0.26 = ___



Task card 16 Adding Decimals with Hundredths Gr...

The pink squares show 1.29. Pink and blue together show 2.11. What number do the blue squares show? 1.29 + ___ = 2.11

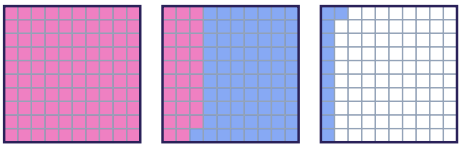

Task card 17 Adding Decimals with Hundredths Gr...

The grids show 0.25 in pink and 1.99 in blue. Count all the shaded squares:

0.25 + 1.99 = ___



Task card 18 Adding Decimals with Hundredths Gr...

The pink squares show 2.05. Pink and blue together show 2.20. What number do the blue squares show? 2.05 + ___ = 2.20



Task card 19 Adding Decimals with Hundredths Gr...

The grids show 0.69 in pink and 2.05 in blue. Count all the shaded squares:

0.69 + 2.05 = ___



Task card 20 Adding Decimals with Hundredths Gr...

The pink squares show 2.25. Pink and blue together show 2.74. What number do the blue squares show? 2.25 + ___ = 2.74



Task card 21 Adding Decimals with Hundredths Gr...

The grids show 0.45 in pink and 1.76 in blue. Count all the shaded squares:

0.45 + 1.76 = ___



Task card 22 Adding Decimals with Hundredths Gr...

The pink squares show 1.27. Pink and blue together show 2.44. What number do the blue squares show? 1.27 + ___ = 2.44

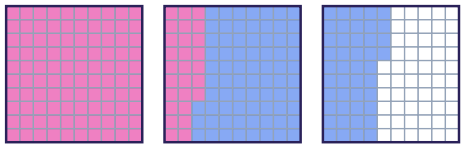

Task card 23 Adding Decimals with Hundredths Gr...

The grids show 0.24 in pink and 2.59 in blue. Count all the shaded squares:

0.24 + 2.59 = ___



Task card 24 Adding Decimals with Hundredths Gr...

The pink squares show 0.13. Pink and blue together show 2.52. What number do the blue squares show? 0.13 + ___ = 2.52



Adding Decimals with Hundredths Grids Task Cards

Recording sheet · Grade 5 · On blank grids, shade the first number in one color, then the second number right after it in another color, and count all the shaded squares. When the grids are already shaded, read the numbers from the picture. Check your work with the standard algorithm.

Scan to check your answers

Name: _____ Date: _____

1	2	3	4
5	6	7	8
9	10	11	12
13	14	15	16
17	18	19	20
21	22	23	24

Adding Decimals with Hundredths Grids Task Cards: Answer Key

Grade 5 · Hard

The answers online

1. 2.55	**2.** 1.46	**3.** 2.31
4. 1.95	**5.** 2.15	**6.** 1.63
7. 2.36	**8.** 0.21	**9.** 2.14
10. 2.08	**11.** 2.37	**12.** 0.75
13. 2.52	**14.** 2.15	**15.** 2.8
16. 0.82	**17.** 2.24	**18.** 0.15
19. 2.74	**20.** 0.49	**21.** 2.21
22. 1.17	**23.** 2.83	**24.** 2.39