Adding Decimals with Hundredths Grids · 1

The grids show 0.65 in pink and 0.66 in blue. Count all the shaded squares: 0.65 + 0.66 = ___

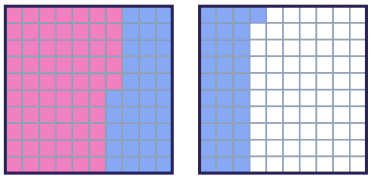

Adding Decimals with Hundredths Grids · 2

The pink squares show 1.19. Pink and blue together show 1.83. What number do the blue squares show? 1.19 + ___ = 1.83

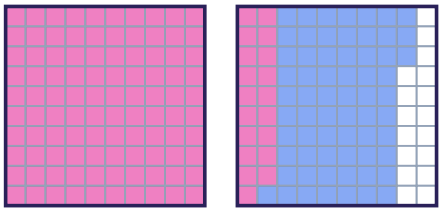

Adding Decimals with Hundredths Grids · 3

The grids show 1.17 in pink and 0.13 in blue. Count all the shaded squares: 1.17 + 0.13 = ___

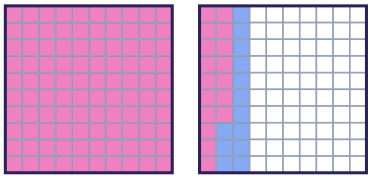

Adding Decimals with Hundredths Grids · 4

The pink squares show 1.09. Pink and blue together show 2.51. What number do the blue squares show? 1.09 + ___ = 2.51

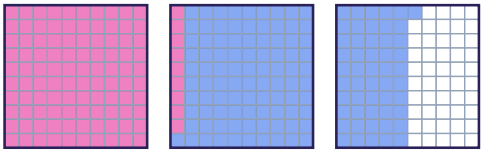

Adding Decimals with Hundredths Grids · 5

The grids show 0.38 in pink and 1.46 in blue. Count all the shaded squares: 0.38 + 1.46 = ___

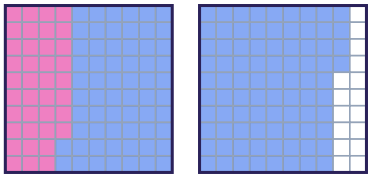

Adding Decimals with Hundredths Grids · 6

The pink squares show 1.07. Pink and blue together show 2.70. What number do the blue squares show? 1.07 + ___ = 2.70

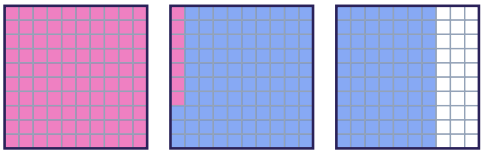

Adding Decimals with Hundredths Grids · 7

The grids show 1.36 in pink and 0.46 in blue. Count all the shaded squares: 1.36 + 0.46 = ___

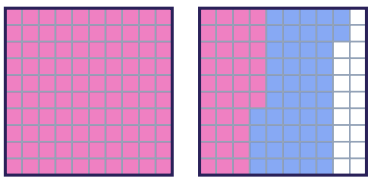

Adding Decimals with Hundredths Grids · 8

The pink squares show 0.97. Pink and blue together show 1.33. What number do the blue squares show? 0.97 + ___ = 1.33

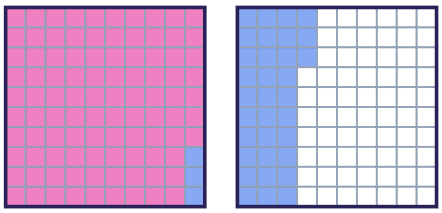

Adding Decimals with Hundredths Grids · 2

**ANSWER**

# 0.64

Adding Decimals with Hundredths Grids · 1

**ANSWER**

# 1.31

Adding Decimals with Hundredths Grids · 4

**ANSWER**

# 1.42

Adding Decimals with Hundredths Grids · 3

**ANSWER**

# 1.3

Adding Decimals with Hundredths Grids · 6

**ANSWER**

# 1.63

Adding Decimals with Hundredths Grids · 5

**ANSWER**

# 1.84

Adding Decimals with Hundredths Grids · 8

**ANSWER**

# 0.36

Adding Decimals with Hundredths Grids · 7

**ANSWER**

# 1.82

Adding Decimals with Hundredths Grids · 9

The grids show 1.59 in pink and 0.39 in blue. Count all the shaded squares: 1.59 + 0.39 = ___

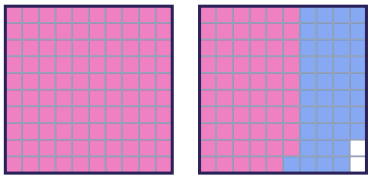

Adding Decimals with Hundredths Grids · 10

The pink squares show 1.98. Pink and blue together show 2.12. What number do the blue squares show? 1.98 + ___ = 2.12



Adding Decimals with Hundredths Grids · 11

The grids show 0.64 in pink and 0.99 in blue. Count all the shaded squares: 0.64 + 0.99 = ___

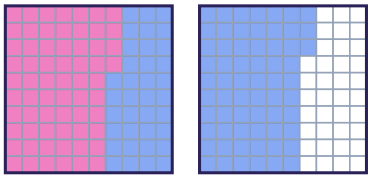

Adding Decimals with Hundredths Grids · 12

The pink squares show 1.64. Pink and blue together show 2.90. What number do the blue squares show? 1.64 + ___ = 2.90



Adding Decimals with Hundredths Grids · 13

The grids show 1.08 in pink and 0.53 in blue. Count all the shaded squares: 1.08 + 0.53 = ___

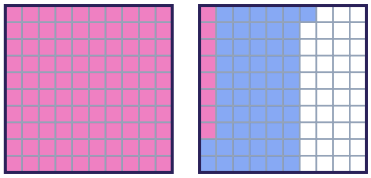

Adding Decimals with Hundredths Grids · 14

The pink squares show 0.86. Pink and blue together show 1.41. What number do the blue squares show? 0.86 + ___ = 1.41

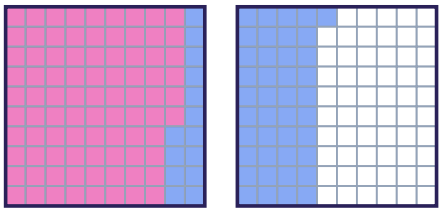

Adding Decimals with Hundredths Grids · 15

The grids show 0.27 in pink and 0.97 in blue. Count all the shaded squares: 0.27 + 0.97 = ___

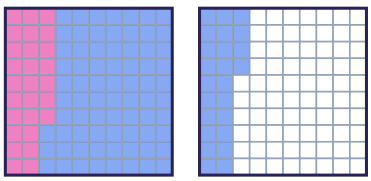

Adding Decimals with Hundredths Grids · 16

The pink squares show 1.43. Pink and blue together show 2.41. What number do the blue squares show? 1.43 + ___ = 2.41



Adding Decimals with Hundredths Grids · 10

**ANSWER**

**0.14**

Adding Decimals with Hundredths Grids · 9

**ANSWER**

**1.98**

Adding Decimals with Hundredths Grids · 12

**ANSWER**

**1.26**

Adding Decimals with Hundredths Grids · 11

**ANSWER**

**1.63**

Adding Decimals with Hundredths Grids · 14

**ANSWER**

**0.55**

Adding Decimals with Hundredths Grids · 13

**ANSWER**

**1.61**

Adding Decimals with Hundredths Grids · 16

**ANSWER**

**0.98**

Adding Decimals with Hundredths Grids · 15

**ANSWER**

**1.24**

Adding Decimals with Hundredths Grids · 17

The grids show 0.48 in pink and 1.04 in blue. Count all the shaded squares: 0.48 + 1.04 = ___

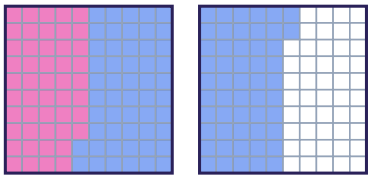

Adding Decimals with Hundredths Grids · 18

The pink squares show 2.59. Pink and blue together show 2.73. What number do the blue squares show? 2.59 + ___ = 2.73



Adding Decimals with Hundredths Grids · 19

The grids show 1.09 in pink and 0.35 in blue. Count all the shaded squares: 1.09 + 0.35 = ___

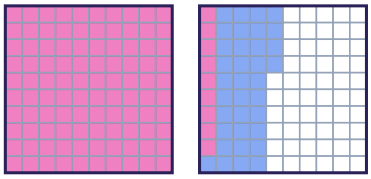

Adding Decimals with Hundredths Grids · 20

The pink squares show 0.49. Pink and blue together show 1.53. What number do the blue squares show? 0.49 + ___ = 1.53

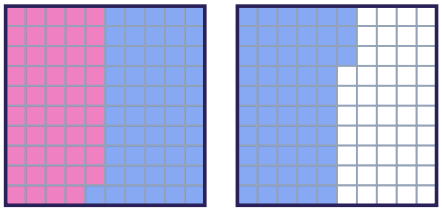

Adding Decimals with Hundredths Grids · 21

The grids show 0.67 in pink and 0.47 in blue. Count all the shaded squares: 0.67 + 0.47 = ___

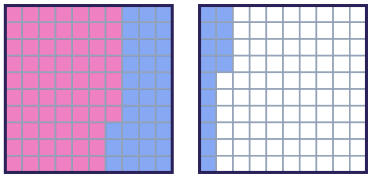

Adding Decimals with Hundredths Grids · 22

The pink squares show 0.18. Pink and blue together show 2.50. What number do the blue squares show? 0.18 + ___ = 2.50



Adding Decimals with Hundredths Grids · 23

The grids show 0.47 in pink and 0.89 in blue. Count all the shaded squares: 0.47 + 0.89 = ___

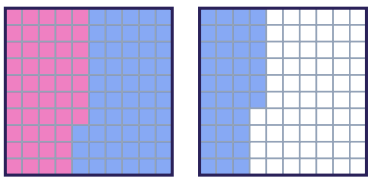

Adding Decimals with Hundredths Grids · 24

The pink squares show 1.48. Pink and blue together show 2.54. What number do the blue squares show? 1.48 + ___ = 2.54



Adding Decimals with Hundredths Grids · 18

**ANSWER**

**0.14**

Adding Decimals with Hundredths Grids · 17

**ANSWER**

**1.52**

Adding Decimals with Hundredths Grids · 20

**ANSWER**

**1.04**

Adding Decimals with Hundredths Grids · 19

**ANSWER**

**1.44**

Adding Decimals with Hundredths Grids · 22

**ANSWER**

**2.32**

Adding Decimals with Hundredths Grids · 21

**ANSWER**

**1.14**

Adding Decimals with Hundredths Grids · 24

**ANSWER**

**1.06**

Adding Decimals with Hundredths Grids · 23

**ANSWER**

**1.36**