Adding Decimals with Hundredths Grids · 1

The grids show 2.38 in pink and 0.17 in blue. Count all the shaded squares: 2.38 + 0.17 = ___



Adding Decimals with Hundredths Grids · 2

The pink squares show 1.35. Pink and blue together show 2.81. What number do the blue squares show? 1.35 + ___ = 2.81



Adding Decimals with Hundredths Grids · 3

The grids show 2.09 in pink and 0.22 in blue. Count all the shaded squares: 2.09 + 0.22 = ___



Adding Decimals with Hundredths Grids · 4

The pink squares show 0.36. Pink and blue together show 2.31. What number do the blue squares show? 0.36 + ___ = 2.31



Adding Decimals with Hundredths Grids · 5

The grids show 0.26 in pink and 1.89 in blue. Count all the shaded squares: 0.26 + 1.89 = ___



Adding Decimals with Hundredths Grids · 6

The pink squares show 0.78. Pink and blue together show 2.41. What number do the blue squares show? 0.78 + ___ = 2.41



Adding Decimals with Hundredths Grids · 7

The grids show 1.17 in pink and 1.19 in blue. Count all the shaded squares: 1.17 + 1.19 = ___

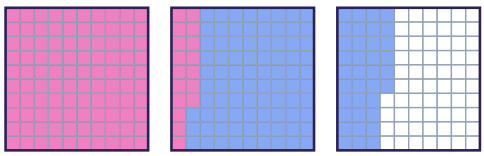

Adding Decimals with Hundredths Grids · 8

The pink squares show 1.99. Pink and blue together show 2.20. What number do the blue squares show? 1.99 + ___ = 2.20



Adding Decimals with Hundredths Grids · 2

ANSWER

1.46

Adding Decimals with Hundredths Grids · 1

ANSWER

2.55

Adding Decimals with Hundredths Grids · 4

ANSWER

1.95

Adding Decimals with Hundredths Grids · 3

ANSWER

2.31

Adding Decimals with Hundredths Grids · 6

ANSWER

1.63

Adding Decimals with Hundredths Grids · 5

ANSWER

2.15

Adding Decimals with Hundredths Grids · 8

ANSWER

0.21

Adding Decimals with Hundredths Grids · 7

ANSWER

2.36

Adding Decimals with Hundredths Grids · 9

The grids show 0.17 in pink and 1.97 in blue. Count all the shaded squares: 0.17 + 1.97 = ___



Adding Decimals with Hundredths Grids · 10

The pink squares show 0.23. Pink and blue together show 2.31. What number do the blue squares show? 0.23 + ___ = 2.31



Adding Decimals with Hundredths Grids · 11

The grids show 0.59 in pink and 1.78 in blue. Count all the shaded squares: 0.59 + 1.78 = ___



Adding Decimals with Hundredths Grids · 12

The pink squares show 1.99. Pink and blue together show 2.74. What number do the blue squares show? 1.99 + ___ = 2.74



Adding Decimals with Hundredths Grids · 13

The grids show 1.79 in pink and 0.73 in blue. Count all the shaded squares: 1.79 + 0.73 = ___



Adding Decimals with Hundredths Grids · 14

The pink squares show 0.37. Pink and blue together show 2.52. What number do the blue squares show? 0.37 + ___ = 2.52



Adding Decimals with Hundredths Grids · 15

The grids show 2.54 in pink and 0.26 in blue. Count all the shaded squares: 2.54 + 0.26 = ___



Adding Decimals with Hundredths Grids · 16

The pink squares show 1.29. Pink and blue together show 2.11. What number do the blue squares show? 1.29 + ___ = 2.11

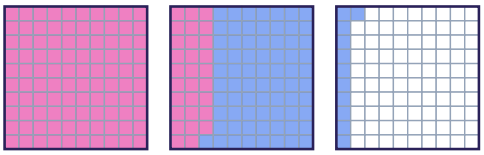

Adding Decimals with Hundredths Grids · 10

ANSWER

2.08

Adding Decimals with Hundredths Grids · 9

ANSWER

2.14

Adding Decimals with Hundredths Grids · 12

ANSWER

0.75

Adding Decimals with Hundredths Grids · 11

ANSWER

2.37

Adding Decimals with Hundredths Grids · 14

ANSWER

2.15

Adding Decimals with Hundredths Grids · 13

ANSWER

2.52

Adding Decimals with Hundredths Grids · 16

ANSWER

0.82

Adding Decimals with Hundredths Grids · 15

ANSWER

2.8

Adding Decimals with Hundredths Grids · 17

The grids show 0.25 in pink and 1.99 in blue. Count all the shaded squares: 0.25 + 1.99 = ___



Adding Decimals with Hundredths Grids · 18

The pink squares show 2.05. Pink and blue together show 2.20. What number do the blue squares show? 2.05 + ___ = 2.20



Adding Decimals with Hundredths Grids · 19

The grids show 0.69 in pink and 2.05 in blue. Count all the shaded squares: 0.69 + 2.05 = ___



Adding Decimals with Hundredths Grids · 20

The pink squares show 2.25. Pink and blue together show 2.74. What number do the blue squares show? 2.25 + ___ = 2.74



Adding Decimals with Hundredths Grids · 21

The grids show 0.45 in pink and 1.76 in blue. Count all the shaded squares: 0.45 + 1.76 = ___



Adding Decimals with Hundredths Grids · 22

The pink squares show 1.27. Pink and blue together show 2.44. What number do the blue squares show? 1.27 + ___ = 2.44



Adding Decimals with Hundredths Grids · 23

The grids show 0.24 in pink and 2.59 in blue. Count all the shaded squares: 0.24 + 2.59 = ___



Adding Decimals with Hundredths Grids · 24

The pink squares show 0.13. Pink and blue together show 2.52. What number do the blue squares show? 0.13 + ___ = 2.52



Adding Decimals with Hundredths Grids · 18

ANSWER

0.15

Adding Decimals with Hundredths Grids · 17

ANSWER

2.24

Adding Decimals with Hundredths Grids · 20

ANSWER

0.49

Adding Decimals with Hundredths Grids · 19

ANSWER

2.74

Adding Decimals with Hundredths Grids · 22

ANSWER

1.17

Adding Decimals with Hundredths Grids · 21

ANSWER

2.21

Adding Decimals with Hundredths Grids · 24

ANSWER

2.39

Adding Decimals with Hundredths Grids · 23

ANSWER

2.83