Adding Decimals with Hundredths Grids · 1

The grids show 0.19 in pink and 0.22 in blue. Count all the shaded squares: 0.19 + 0.22 = ___



Adding Decimals with Hundredths Grids · 2

The pink squares show 0.24. Pink and blue together show 0.38. What number do the blue squares show? 0.24 + ___ = 0.38

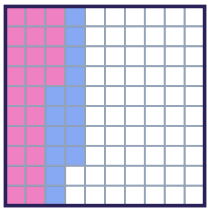

Adding Decimals with Hundredths Grids · 3

The grids show 0.29 in pink and 0.59 in blue. Count all the shaded squares: 0.29 + 0.59 = ___

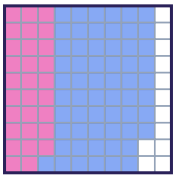

Adding Decimals with Hundredths Grids · 4

The pink squares show 0.59. Pink and blue together show 0.79. What number do the blue squares show? 0.59 + ___ = 0.79

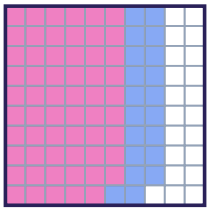

Adding Decimals with Hundredths Grids · 5

The grids show 1.15 in pink and 0.36 in blue. Count all the shaded squares: 1.15 + 0.36 = ___

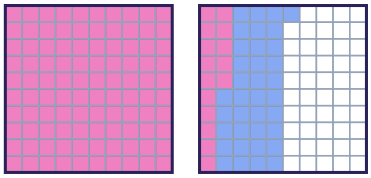

Adding Decimals with Hundredths Grids · 6

The pink squares show 1.08. Pink and blue together show 1.34. What number do the blue squares show? 1.08 + ___ = 1.34

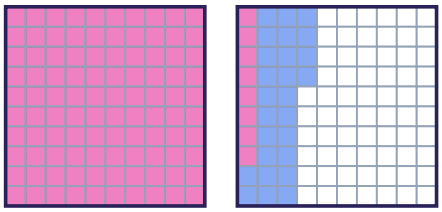

Adding Decimals with Hundredths Grids · 7

The grids show 0.29 in pink and 0.32 in blue. Count all the shaded squares: 0.29 + 0.32 = ___

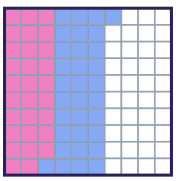

Adding Decimals with Hundredths Grids · 8

The pink squares show 0.33. Pink and blue together show 0.59. What number do the blue squares show? 0.33 + ___ = 0.59

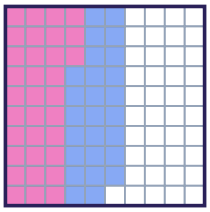

Adding Decimals with Hundredths Grids · 2

ANSWER

0.14

Adding Decimals with Hundredths Grids · 1

ANSWER

0.41

Adding Decimals with Hundredths Grids · 4

ANSWER

0.2

Adding Decimals with Hundredths Grids · 3

ANSWER

0.88

Adding Decimals with Hundredths Grids · 6

ANSWER

0.26

Adding Decimals with Hundredths Grids · 5

ANSWER

1.51

Adding Decimals with Hundredths Grids · 8

ANSWER

0.26

Adding Decimals with Hundredths Grids · 7

ANSWER

0.61

Adding Decimals with Hundredths Grids · 9

The grids show 0.67 in pink and 0.14 in blue. Count all the shaded squares: 0.67 + 0.14 = ___

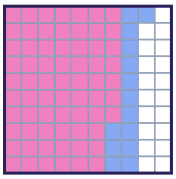

Adding Decimals with Hundredths Grids · 10

The pink squares show 0.53. Pink and blue together show 0.83. What number do the blue squares show? 0.53 + ___ = 0.83

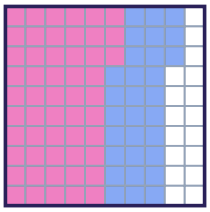

Adding Decimals with Hundredths Grids · 11

The grids show 1.05 in pink and 0.29 in blue. Count all the shaded squares: 1.05 + 0.29 = ___

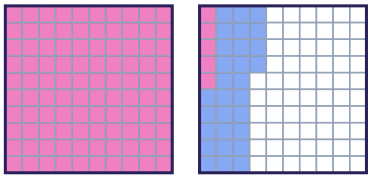

Adding Decimals with Hundredths Grids · 12

The pink squares show 0.47. Pink and blue together show 1.62. What number do the blue squares show? 0.47 + ___ = 1.62

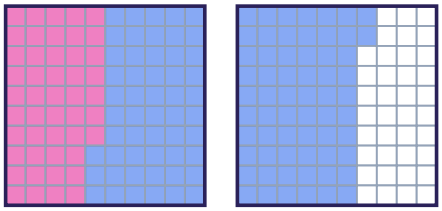

Adding Decimals with Hundredths Grids · 13

The grids show 0.15 in pink and 0.26 in blue. Count all the shaded squares: 0.15 + 0.26 = ___



Adding Decimals with Hundredths Grids · 14

The pink squares show 0.49. Pink and blue together show 0.59. What number do the blue squares show? 0.49 + ___ = 0.59

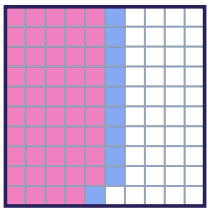

Adding Decimals with Hundredths Grids · 15

The grids show 0.57 in pink and 0.29 in blue. Count all the shaded squares: 0.57 + 0.29 = ___



Adding Decimals with Hundredths Grids · 16

The pink squares show 0.30. Pink and blue together show 0.72. What number do the blue squares show? 0.30 + ___ = 0.72



Adding Decimals with Hundredths Grids · 10

ANSWER

0.3

Adding Decimals with Hundredths Grids · 9

ANSWER

0.81

Adding Decimals with Hundredths Grids · 12

ANSWER

1.15

Adding Decimals with Hundredths Grids · 11

ANSWER

1.34

Adding Decimals with Hundredths Grids · 14

ANSWER

0.1

Adding Decimals with Hundredths Grids · 13

ANSWER

0.41

Adding Decimals with Hundredths Grids · 16

ANSWER

0.42

Adding Decimals with Hundredths Grids · 15

ANSWER

0.86

Adding Decimals with Hundredths Grids · 17

The grids show 0.89 in pink and 0.22 in blue. Count all the shaded squares: 0.89 + 0.22 = ___

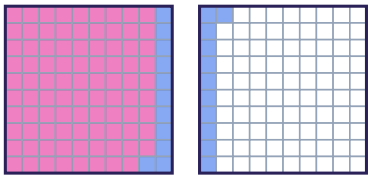

Adding Decimals with Hundredths Grids · 18

The pink squares show 0.94. Pink and blue together show 1.12. What number do the blue squares show? 0.94 + ___ = 1.12

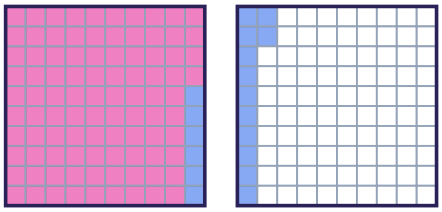

Adding Decimals with Hundredths Grids · 19

The grids show 0.49 in pink and 0.17 in blue. Count all the shaded squares: 0.49 + 0.17 = ___

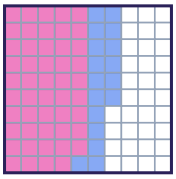

Adding Decimals with Hundredths Grids · 20

The pink squares show 0.49. Pink and blue together show 0.79. What number do the blue squares show? 0.49 + ___ = 0.79

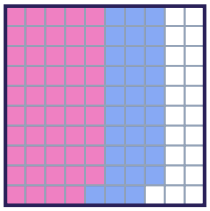

Adding Decimals with Hundredths Grids · 21

The grids show 0.29 in pink and 0.29 in blue. Count all the shaded squares: 0.29 + 0.29 = ___



Adding Decimals with Hundredths Grids · 22

The pink squares show 0.72. Pink and blue together show 0.87. What number do the blue squares show? 0.72 + ___ = 0.87

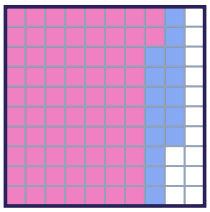

Adding Decimals with Hundredths Grids · 23

The grids show 0.14 in pink and 0.97 in blue. Count all the shaded squares: 0.14 + 0.97 = ___

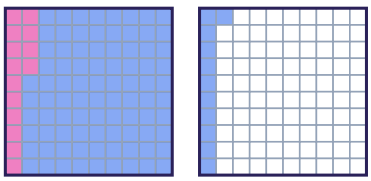

Adding Decimals with Hundredths Grids · 24

The pink squares show 0.82. Pink and blue together show 1.50. What number do the blue squares show? 0.82 + ___ = 1.50

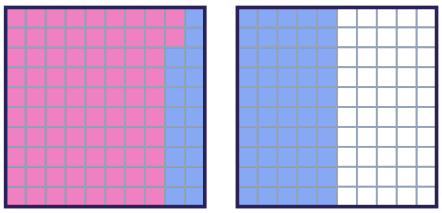

Adding Decimals with Hundredths Grids · 18

ANSWER

0.18

Adding Decimals with Hundredths Grids · 17

ANSWER

1.11

Adding Decimals with Hundredths Grids · 20

ANSWER

0.3

Adding Decimals with Hundredths Grids · 19

ANSWER

0.66

Adding Decimals with Hundredths Grids · 22

ANSWER

0.15

Adding Decimals with Hundredths Grids · 21

ANSWER

0.58

Adding Decimals with Hundredths Grids · 24

ANSWER

0.68

Adding Decimals with Hundredths Grids · 23

ANSWER

1.11