Task card 1 100th Day of School Math

One box of crayons costs $2.40. Ava buys 2 boxes of crayons. How much does Ava spend?

Task card 2 100th Day of School Math

One batch of a recipe uses $\frac{1}{4}$ cup of sprinkles. Ava makes 5 batches. How many cups of sprinkles does Ava use?

Task card 3 100th Day of School Math

Ava buys a box of crayons for $3.70 and pays with a $10 bill. How much change does Ava get?

Task card 4 100th Day of School Math

One box of crayons costs $4.35. Omar buys 5 boxes of crayons. How much does Omar spend?

Task card 5 100th Day of School Math

A party box is 9 inches long, 6 inches wide and 2 inches tall. What is its volume in cubic inches?

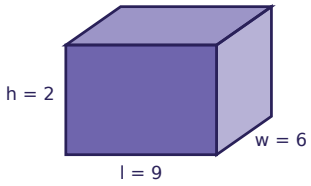

Task card 6 100th Day of School Math

One batch of a recipe uses $\frac{1}{4}$ cup of sprinkles. Zoe makes 2 batches. How many cups of sprinkles does Zoe use?

Task card 7 100th Day of School Math

A party box is 5 inches long, 6 inches wide and 6 inches tall. What is its volume in cubic inches?

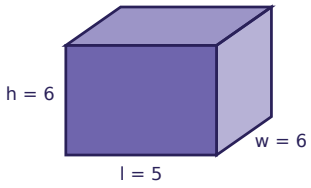

Task card 8 100th Day of School Math

Noah buys a box of crayons for $4.20 and pays with a $10 bill. How much change does Noah get?

Task card 9 100th Day of School Math

One box of crayons costs $3.65. Lily buys 6 boxes of crayons. How much does Lily spend?

Task card 10 100th Day of School Math

A party box is 10 inches long, 4 inches wide and 6 inches tall. What is its volume in cubic inches?

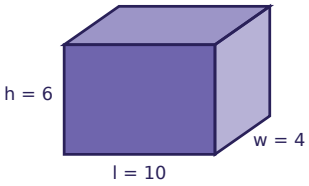

Task card 11 100th Day of School Math

Zoe buys a box of crayons for $4.04 and pays with a $10 bill. How much change does Zoe get?

Task card 12 100th Day of School Math

One box of crayons costs $3.00. Ella buys 4 boxes of crayons. How much does Ella spend?

Task card 13 100th Day of School Math

One batch of a recipe uses $\frac{2}{3}$ cup of sprinkles. Ben makes 5 batches. How many cups of sprinkles does Ben use?

Task card 14 100th Day of School Math

One batch of a recipe uses $\frac{2}{3}$ cup of sprinkles. Zoe makes 3 batches. How many cups of sprinkles does Zoe use?

Task card 15 100th Day of School Math

A party box is 8 inches long, 3 inches wide and 7 inches tall. What is its volume in cubic inches?

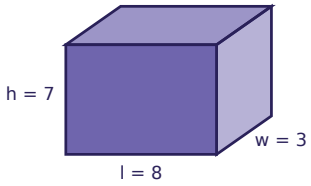

Task card 16 100th Day of School Math

Ava buys a box of crayons for $3.20 and pays with a $10 bill. How much change does Ava get?

Task card 17 100th Day of School Math

Leo buys a party hat for $2.84 and pays with a $10 bill. How much change does Leo get?

Task card 18 100th Day of School Math

One batch of a recipe uses $\frac{3}{4}$ cup of sprinkles. Noah makes 5 batches. How many cups of sprinkles does Noah use?

Task card 19 100th Day of School Math

Leo buys a party hat for $1.98 and pays with a $10 bill. How much change does Leo get?

Task card 20 100th Day of School Math

One party hat costs $1.75. Zoe buys 9 party hats. How much does Zoe spend?

Task card 21 100th Day of School Math

One batch of a recipe uses $\frac{5}{6}$ cup of sprinkles. Sam makes 5 batches. How many cups of sprinkles does Sam use?

Task card 22 100th Day of School Math

A party box is 5 inches long, 8 inches wide and 4 inches tall. What is its volume in cubic inches?

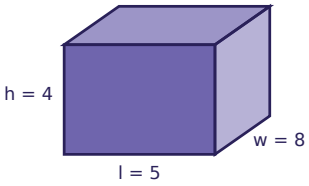

Task card 23 100th Day of School Math

A party box is 12 inches long, 8 inches wide and 5 inches tall. What is its volume in cubic inches?

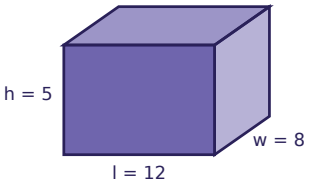

Task card 24 100th Day of School Math

One pack of stickers costs $2.60. Ella buys 8 packs of stickers. How much does Ella spend?

100th Day of School Math Task Cards

Recording sheet · Grade 5 · Read each story and solve. Write money like $4.50 and fractions like 1 1/2.

Name: _____ Date: _____

Scan to check your answers

1	2	3	4
5	6	7	8
9	10	11	12
13	14	15	16
17	18	19	20
21	22	23	24

100th Day of School Math Task Cards: Answer Key

Grade 5 · Medium

The answers online

1. $4.80	**2.** $1\frac{1}{4}$	**3.** $6.30
4. $21.75	**5.** 108	**6.** $\frac{1}{2}$
7. 180	**8.** $5.80	**9.** $21.90
10. 240	**11.** $5.96	**12.** $12.00
13. $3\frac{1}{3}$	**14.** 2	**15.** 168
16. $6.80	**17.** $7.16	**18.** $3\frac{3}{4}$
19. $8.02	**20.** $15.75	**21.** $4\frac{1}{6}$
22. 160	**23.** 480	**24.** $20.80