**Task card 1** 100th Day of School Math

Zoe buys a party hat for $2.39 and pays with a $10 bill. How much change does Zoe get?

**Task card 2** 100th Day of School Math

One pack of stickers costs $2.85. Leo buys 8 packs of stickers. How much does Leo spend?

**Task card 3** 100th Day of School Math

One batch of a recipe uses $\frac{2}{3}$ cup of sprinkles. Omar makes 2 batches. How many cups of sprinkles does Omar use?

**Task card 4** 100th Day of School Math

One batch of a recipe uses $\frac{2}{3}$ cup of sprinkles. Noah makes 5 batches. How many cups of sprinkles does Noah use?

**Task card 5** 100th Day of School Math

One box of crayons costs $4.80. Ben buys 6 boxes of crayons. How much does Ben spend?

**Task card 6** 100th Day of School Math

Ben buys a box of crayons for $2.70 and pays with a $10 bill. How much change does Ben get?

**Task card 7** 100th Day of School Math

A party box is 10 inches long, 10 inches wide and 3 inches tall. What is its volume in cubic inches?

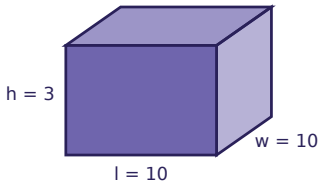


**Task card 8** 100th Day of School Math

A party box is 4 inches long, 7 inches wide and 8 inches tall. What is its volume in cubic inches?

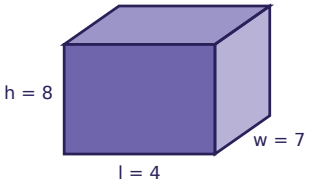


**Task card 9** 100th Day of School Math

Leo buys a pack of stickers for $3.96 and pays with a $10 bill. How much change does Leo get?

**Task card 10** 100th Day of School Math

A party box is 11 inches long, 8 inches wide and 7 inches tall. What is its volume in cubic inches?

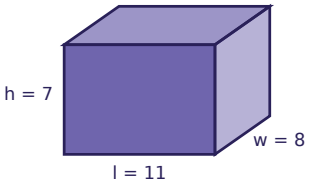


**Task card 11** 100th Day of School Math

One party hat costs $2.40. Omar buys 9 party hats. How much does Omar spend?

**Task card 12** 100th Day of School Math

One box of crayons costs $4.40. Ella buys 9 boxes of crayons. How much does Ella spend?

**Task card 13** 100th Day of School Math

A party box is 14 inches long, 4 inches wide and 6 inches tall. What is its volume in cubic inches?

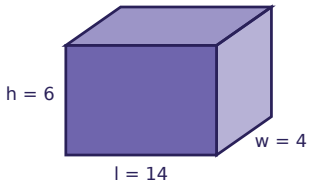


**Task card 14** 100th Day of School Math

Leo buys a party hat for $2.75 and pays with a $10 bill. How much change does Leo get?

**Task card 15** 100th Day of School Math

One batch of a recipe uses $\frac{5}{8}$ cup of sprinkles. Sam makes 5 batches. How many cups of sprinkles does Sam use?

**Task card 16** 100th Day of School Math

One batch of a recipe uses $\frac{5}{6}$ cup of sprinkles. Noah makes 3 batches. How many cups of sprinkles does Noah use?

**Task card 17** 100th Day of School Math

One batch of a recipe uses $\frac{5}{6}$ cup of sprinkles. Leo makes 5 batches. How many cups of sprinkles does Leo use?

**Task card 18** 100th Day of School Math

One box of crayons costs $4.80. Leo buys 3 boxes of crayons. How much does Leo spend?

**Task card 19** 100th Day of School Math

Ava buys a box of crayons for $2.89 and pays with a $10 bill. How much change does Ava get?

**Task card 20** 100th Day of School Math

A party box is 7 inches long, 5 inches wide and 4 inches tall. What is its volume in cubic inches?

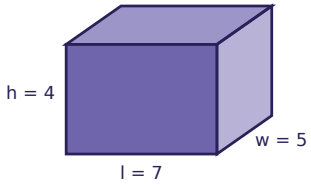


**Task card 21** 100th Day of School Math

One batch of a recipe uses $\frac{3}{8}$ cup of sprinkles. Ella makes 5 batches. How many cups of sprinkles does Ella use?

**Task card 22** 100th Day of School Math

One party hat costs $2.90. Ben buys 2 party hats. How much does Ben spend?

**Task card 23** 100th Day of School Math

Noah buys a box of crayons for $3.18 and pays with a $10 bill. How much change does Noah get?

**Task card 24** 100th Day of School Math

A party box is 8 inches long, 10 inches wide and 7 inches tall. What is its volume in cubic inches?

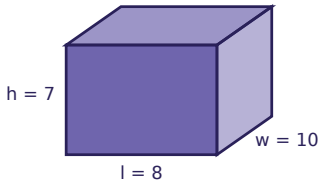

# 100th Day of School Math Task Cards

Recording sheet · Grade 5 · Read each story and solve. Write money like $4.50 and fractions like 1 1/2.

Name: _____ Date: _____

Scan to check your answers

| | | | |
|---|---|---|---|
| 1 | 2 | 3 | 4 |
| 5 | 6 | 7 | 8 |
| 9 | 10 | 11 | 12 |
| 13 | 14 | 15 | 16 |
| 17 | 18 | 19 | 20 |
| 21 | 22 | 23 | 24 |

# 100th Day of School Math Task Cards: Answer Key

Grade 5 · Hard

The answers online

| | | |
|---|---|---|
| **1.** $7.61 | **2.** $22.80 | **3.** $1\frac{1}{3}$ |
| **4.** $3\frac{1}{3}$ | **5.** $28.80 | **6.** $7.30 |
| **7.** 300 | **8.** 224 | **9.** $6.04 |
| **10.** 616 | **11.** $21.60 | **12.** $39.60 |
| **13.** 336 | **14.** $7.25 | **15.** $3\frac{1}{8}$ |
| **16.** $2\frac{1}{2}$ | **17.** $4\frac{1}{6}$ | **18.** $14.40 |
| **19.** $7.11 | **20.** 140 | **21.** $1\frac{7}{8}$ |
| **22.** $5.80 | **23.** $6.82 | **24.** 560 |