100th Day of School Math · 1

One box of crayons costs $2.40. Ava buys 2 boxes of crayons. How much does Ava spend?

100th Day of School Math · 2

One batch of a recipe uses $\frac{1}{4}$ cup of sprinkles. Ava makes 5 batches. How many cups of sprinkles does Ava use?

100th Day of School Math · 3

Ava buys a box of crayons for $3.70 and pays with a $10 bill. How much change does Ava get?

100th Day of School Math · 4

One box of crayons costs $4.35. Omar buys 5 boxes of crayons. How much does Omar spend?

100th Day of School Math · 5

A party box is 9 inches long, 6 inches wide and 2 inches tall. What is its volume in cubic inches?

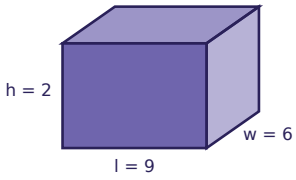

100th Day of School Math · 6

One batch of a recipe uses $\frac{1}{4}$ cup of sprinkles. Zoe makes 2 batches. How many cups of sprinkles does Zoe use?

100th Day of School Math · 7

A party box is 5 inches long, 6 inches wide and 6 inches tall. What is its volume in cubic inches?

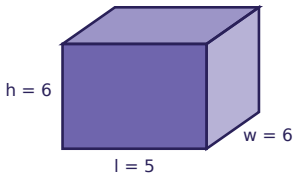

100th Day of School Math · 8

Noah buys a box of crayons for $4.20 and pays with a $10 bill. How much change does Noah get?

100th Day of School Math · 2

ANSWER

$1\frac{1}{4}$

100th Day of School Math · 1

ANSWER

$4.80

100th Day of School Math · 4

ANSWER

$21.75

100th Day of School Math · 3

ANSWER

$6.30

100th Day of School Math · 6

ANSWER

$\frac{1}{2}$

100th Day of School Math · 5

ANSWER

108

100th Day of School Math · 8

ANSWER

$5.80

100th Day of School Math · 7

ANSWER

180

100th Day of School Math · 9

One box of crayons costs $3.65. Lily buys 6 boxes of crayons. How much does Lily spend?

100th Day of School Math · 10

A party box is 10 inches long, 4 inches wide and 6 inches tall. What is its volume in cubic inches?

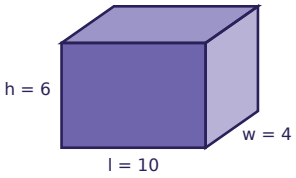

100th Day of School Math · 11

Zoe buys a box of crayons for $4.04 and pays with a $10 bill. How much change does Zoe get?

100th Day of School Math · 12

One box of crayons costs $3.00. Ella buys 4 boxes of crayons. How much does Ella spend?

100th Day of School Math · 13

One batch of a recipe uses $\frac{2}{3}$ cup of sprinkles. Ben makes 5 batches. How many cups of sprinkles does Ben use?

100th Day of School Math · 14

One batch of a recipe uses $\frac{2}{3}$ cup of sprinkles. Zoe makes 3 batches. How many cups of sprinkles does Zoe use?

100th Day of School Math · 15

A party box is 8 inches long, 3 inches wide and 7 inches tall. What is its volume in cubic inches?

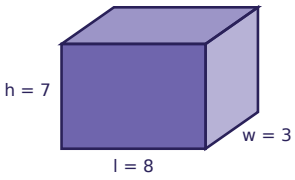

100th Day of School Math · 16

Ava buys a box of crayons for $3.20 and pays with a $10 bill. How much change does Ava get?

100th Day of School Math · 10

ANSWER

240

100th Day of School Math · 9

ANSWER

$21.90

100th Day of School Math · 12

ANSWER

$12.00

100th Day of School Math · 11

ANSWER

$5.96

100th Day of School Math · 14

ANSWER

2

100th Day of School Math · 13

ANSWER

$$3\frac{1}{3}$$

100th Day of School Math · 16

ANSWER

$6.80

100th Day of School Math · 15

ANSWER

168

100th Day of School Math · 17

Leo buys a party hat for $2.84 and pays with a $10 bill. How much change does Leo get?

100th Day of School Math · 18

One batch of a recipe uses $\frac{3}{4}$ cup of sprinkles. Noah makes 5 batches. How many cups of sprinkles does Noah use?

100th Day of School Math · 19

Leo buys a party hat for $1.98 and pays with a $10 bill. How much change does Leo get?

100th Day of School Math · 20

One party hat costs $1.75. Zoe buys 9 party hats. How much does Zoe spend?

100th Day of School Math · 21

One batch of a recipe uses $\frac{5}{6}$ cup of sprinkles. Sam makes 5 batches. How many cups of sprinkles does Sam use?

100th Day of School Math · 22

A party box is 5 inches long, 8 inches wide and 4 inches tall. What is its volume in cubic inches?

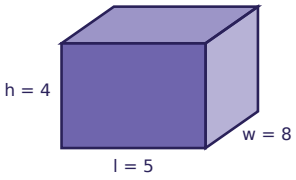

100th Day of School Math · 23

A party box is 12 inches long, 8 inches wide and 5 inches tall. What is its volume in cubic inches?

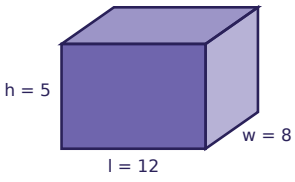

100th Day of School Math · 24

One pack of stickers costs $2.60. Ella buys 8 packs of stickers. How much does Ella spend?

100th Day of School Math · 18

ANSWER

$3\frac{3}{4}$

100th Day of School Math · 17

ANSWER

$7.16

100th Day of School Math · 20

ANSWER

$15.75

100th Day of School Math · 19

ANSWER

$8.02

100th Day of School Math · 22

ANSWER

160

100th Day of School Math · 21

ANSWER

$4\frac{1}{6}$

100th Day of School Math · 24

ANSWER

$20.80

100th Day of School Math · 23

ANSWER

480