100th Day of School Math · 1

One pack of stickers costs $3.50. Zoe buys 4 packs of stickers. How much does Zoe spend?

100th Day of School Math · 2

One pack of stickers costs $2.40. Omar buys 4 packs of stickers. How much does Omar spend?

100th Day of School Math · 3

Noah buys a party hat for $1.75 and pays with a $10 bill. How much change does Noah get?

100th Day of School Math · 4

A party box is 4 inches long, 3 inches wide and 4 inches tall. What is its volume in cubic inches?

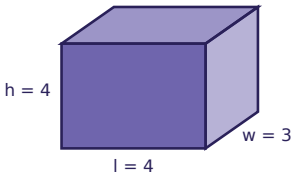

100th Day of School Math · 5

One batch of a recipe uses $\frac{1}{3}$ cup of sprinkles. Lily makes 3 batches. How many cups of sprinkles does Lily use?

100th Day of School Math · 6

Zoe buys a pack of stickers for $4.00 and pays with a $10 bill. How much change does Zoe get?

100th Day of School Math · 7

A party box is 7 inches long, 5 inches wide and 3 inches tall. What is its volume in cubic inches?

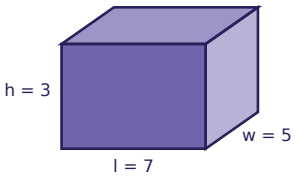

100th Day of School Math · 8

One batch of a recipe uses $\frac{1}{2}$ cup of sprinkles. Mia makes 3 batches. How many cups of sprinkles does Mia use?

100th Day of School Math · 2

ANSWER

$9.60

100th Day of School Math · 1

ANSWER

$14.00

100th Day of School Math · 4

ANSWER

48

100th Day of School Math · 3

ANSWER

$8.25

100th Day of School Math · 6

ANSWER

$6.00

100th Day of School Math · 5

ANSWER

1

100th Day of School Math · 8

ANSWER

$$1\frac{1}{2}$$

100th Day of School Math · 7

ANSWER

105

100th Day of School Math · 9

One pack of stickers costs $3.00. Sam buys 4 packs of stickers. How much does Sam spend?

100th Day of School Math · 10

One batch of a recipe uses $\frac{1}{2}$ cup of sprinkles. Lily makes 4 batches. How many cups of sprinkles does Lily use?

100th Day of School Math · 11

One party hat costs $1.25. Noah buys 2 party hats. How much does Noah spend?

100th Day of School Math · 12

A party box is 8 inches long, 6 inches wide and 4 inches tall. What is its volume in cubic inches?

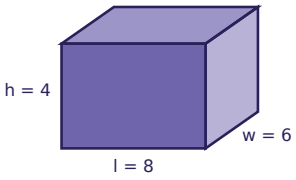

100th Day of School Math · 13

Lily buys a box of crayons for $2.25 and pays with a $10 bill. How much change does Lily get?

100th Day of School Math · 14

A party box is 8 inches long, 4 inches wide and 3 inches tall. What is its volume in cubic inches?

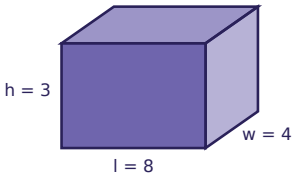

100th Day of School Math · 15

One batch of a recipe uses $\frac{1}{3}$ cup of sprinkles. Mia makes 3 batches. How many cups of sprinkles does Mia use?

100th Day of School Math · 16

Ben buys a box of crayons for $3.00 and pays with a $10 bill. How much change does Ben get?

100th Day of School Math · 10

ANSWER

2

100th Day of School Math · 9

ANSWER

$12.00

100th Day of School Math · 12

ANSWER

192

100th Day of School Math · 11

ANSWER

$2.50

100th Day of School Math · 14

ANSWER

96

100th Day of School Math · 13

ANSWER

$7.75

100th Day of School Math · 16

ANSWER

$7.00

100th Day of School Math · 15

ANSWER

1

100th Day of School Math · 17

A party box is 5 inches long, 4 inches wide and 2 inches tall. What is its volume in cubic inches?

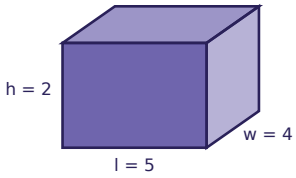

100th Day of School Math · 18

A party box is 5 inches long, 5 inches wide and 6 inches tall. What is its volume in cubic inches?

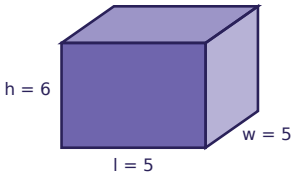

100th Day of School Math · 19

Ella buys a box of crayons for $3.90 and pays with a $10 bill. How much change does Ella get?

100th Day of School Math · 20

One batch of a recipe uses $\frac{1}{3}$ cup of sprinkles. Omar makes 2 batches. How many cups of sprinkles does Omar use?

100th Day of School Math · 21

One party hat costs $2.05. Mia buys 3 party hats. How much does Mia spend?

100th Day of School Math · 22

One batch of a recipe uses $\frac{1}{4}$ cup of sprinkles. Zoe makes 4 batches. How many cups of sprinkles does Zoe use?

100th Day of School Math · 23

One pack of stickers costs $3.20. Sam buys 4 packs of stickers. How much does Sam spend?

100th Day of School Math · 24

Ben buys a box of crayons for $3.40 and pays with a $10 bill. How much change does Ben get?

100th Day of School Math · 18

ANSWER

150

100th Day of School Math · 17

ANSWER

40

100th Day of School Math · 20

ANSWER

$$\frac{2}{3}$$

100th Day of School Math · 19

ANSWER

$6.10

100th Day of School Math · 22

ANSWER

1

100th Day of School Math · 21

ANSWER

$6.15

100th Day of School Math · 24

ANSWER

$6.60

100th Day of School Math · 23

ANSWER

$12.80