Task card 1 Winter Math

Omar eats $\frac{1}{8}$ of a chocolate cake. Lily eats $\frac{4}{8}$ of it. What fraction of the chocolate cake did they eat together?

Task card 2 Winter Math

Ella builds a snow wall all the way around a rectangular snow fort that is 10 feet long and 5 feet wide. How many feet of wall does Ella build?

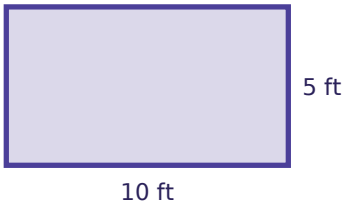

Task card 3 Winter Math

Each tin holds 22 snowball cookies. The bakery fills 53 tins. How many snowball cookies is that?

Task card 4 Winter Math

Sam builds a snow wall all the way around a rectangular snow fort that is 11 feet long and 4 feet wide. How many feet of wall does Sam build?

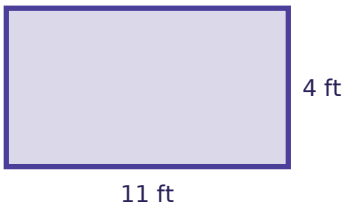

Task card 5 Winter Math

There are 81 snowball cookies. Each tin holds 6. After filling as many tins as possible, how many snowball cookies are left over?

Task card 6 Winter Math

Ben eats $\frac{1}{10}$ of a chocolate cake. Mia eats $\frac{2}{10}$ of it. What fraction of the chocolate cake did they eat together?

Task card 7 Winter Math

There are 77 snowball cookies. Each tin holds 6. After filling as many tins as possible, how many snowball cookies are left over?

Task card 8 Winter Math

Each tin holds 22 cinnamon rolls. The bakery fills 23 tins. How many cinnamon rolls is that?

Task card 9 Winter Math

There are 68 snowball cookies. Each tin holds 5. How many tins can be filled all the way?

Task card 10 Winter Math

There are 86 cinnamon rolls. Each tin holds 4. How many tins can be filled all the way?

Task card 11 Winter Math

Each tin holds 20 cinnamon rolls. The bakery fills 78 tins. How many cinnamon rolls is that?

Task card 12 Winter Math

Zoe eats $\frac{1}{8}$ of a chocolate cake. Leo eats $\frac{4}{8}$ of it. What fraction of the chocolate cake did they eat together?

Task card 13 Winter Math

Each tin holds 19 cinnamon rolls. The bakery fills 52 tins. How many cinnamon rolls is that?

Task card 14 Winter Math

Ben builds a snow wall all the way around a rectangular snow fort that is 4 feet long and 2 feet wide. How many feet of wall does Ben build?



Task card 15 Winter Math

Noah eats $\frac{5}{12}$ of a chocolate cake. Zoe eats $\frac{6}{12}$ of it. What fraction of the chocolate cake did they eat together?

Task card 16 Winter Math

Zoe builds a snow wall all the way around a rectangular snow fort that is 8 feet long and 4 feet wide. How many feet of wall does Zoe build?



Task card 17 Winter Math

There are 34 snowball cookies. Each tin holds 8. How many tins can be filled all the way?

Task card 18 Winter Math

Noah builds a snow wall all the way around a rectangular snow fort that is 12 feet long and 2 feet wide. How many feet of wall does Noah build?



Task card 19 Winter Math

Zoe eats $\frac{3}{12}$ of a chocolate cake. Lily eats $\frac{2}{12}$ of it. What fraction of the chocolate cake did they eat together?

Task card 20 Winter Math

Each tin holds 17 cocoa muffins. The bakery fills 85 tins. How many cocoa muffins is that?

Task card 21 Winter Math

Omar eats $\frac{2}{9}$ of a chocolate cake. Sam eats $\frac{3}{9}$ of it. What fraction of the chocolate cake did they eat together?

Task card 22 Winter Math

There are 56 snowball cookies. Each tin holds 6. How many tins can be filled all the way?

Task card 23 Winter Math

Ben builds a snow wall all the way around a rectangular snow fort that is 7 feet long and 2 feet wide. How many feet of wall does Ben build?

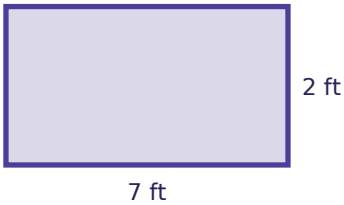

Task card 24 Winter Math

Each tin holds 13 cocoa muffins. The bakery fills 31 tins. How many cocoa muffins is that?

Winter Math Task Cards

Recording sheet · Grade 4 · Read each story and solve.

Name: _____ Date: _____

Scan to check your answers

1	2	3	4
5	6	7	8
9	10	11	12
13	14	15	16
17	18	19	20
21	22	23	24

Winter Math Task Cards: Answer Key

Grade 4 · Hard

The answers online

1. $\frac{5}{8}$	**2.** 30	**3.** 1166
4. 30	**5.** 3	**6.** $\frac{3}{10}$
7. 5	**8.** 506	**9.** 13
10. 21	**11.** 1560	**12.** $\frac{5}{8}$
13. 988	**14.** 12	**15.** $\frac{11}{12}$
16. 24	**17.** 4	**18.** 28
19. $\frac{5}{12}$	**20.** 1445	**21.** $\frac{5}{9}$
22. 9	**23.** 18	**24.** 403