Winter Math · 1

Omar eats $\frac{1}{8}$ of a chocolate cake. Lily eats $\frac{4}{8}$ of it. What fraction of the chocolate cake did they eat together?

Winter Math · 2

Ella builds a snow wall all the way around a rectangular snow fort that is 10 feet long and 5 feet wide. How many feet of wall does Ella build?

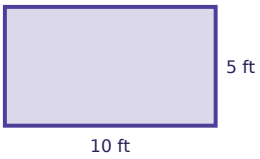

Winter Math · 3

Each tin holds 22 snowball cookies. The bakery fills 53 tins. How many snowball cookies is that?

Winter Math · 4

Sam builds a snow wall all the way around a rectangular snow fort that is 11 feet long and 4 feet wide. How many feet of wall does Sam build?

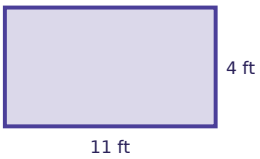

Winter Math · 5

There are 81 snowball cookies. Each tin holds 6. After filling as many tins as possible, how many snowball cookies are left over?

Winter Math · 6

Ben eats $\frac{1}{10}$ of a chocolate cake. Mia eats $\frac{2}{10}$ of it. What fraction of the chocolate cake did they eat together?

Winter Math · 7

There are 77 snowball cookies. Each tin holds 6. After filling as many tins as possible, how many snowball cookies are left over?

Winter Math · 8

Each tin holds 22 cinnamon rolls. The bakery fills 23 tins. How many cinnamon rolls is that?

Winter Math · 2

ANSWER

30

Winter Math · 1

ANSWER

$$\frac{5}{8}$$

Winter Math · 4

ANSWER

30

Winter Math · 3

ANSWER

1166

Winter Math · 6

ANSWER

$$\frac{3}{10}$$

Winter Math · 5

ANSWER

3

Winter Math · 8

ANSWER

506

Winter Math · 7

ANSWER

5

Winter Math · 9

There are 68 snowball cookies. Each tin holds 5. How many tins can be filled all the way?

Winter Math · 10

There are 86 cinnamon rolls. Each tin holds 4. How many tins can be filled all the way?

Winter Math · 11

Each tin holds 20 cinnamon rolls. The bakery fills 78 tins. How many cinnamon rolls is that?

Winter Math · 12

Zoe eats $\frac{1}{8}$ of a chocolate cake. Leo eats $\frac{4}{8}$ of it. What fraction of the chocolate cake did they eat together?

Winter Math · 13

Each tin holds 19 cinnamon rolls. The bakery fills 52 tins. How many cinnamon rolls is that?

Winter Math · 14

Ben builds a snow wall all the way around a rectangular snow fort that is 4 feet long and 2 feet wide. How many feet of wall does Ben build?

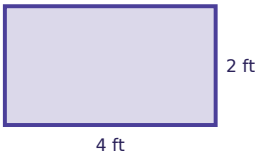

Winter Math · 15

Noah eats $\frac{5}{12}$ of a chocolate cake. Zoe eats $\frac{6}{12}$ of it. What fraction of the chocolate cake did they eat together?

Winter Math · 16

Zoe builds a snow wall all the way around a rectangular snow fort that is 8 feet long and 4 feet wide. How many feet of wall does Zoe build?

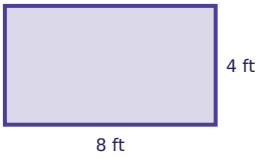

Winter Math · 10

ANSWER

21

Winter Math · 9

ANSWER

13

Winter Math · 12

ANSWER

$$\frac{5}{8}$$

Winter Math · 11

ANSWER

1560

Winter Math · 14

ANSWER

12

Winter Math · 13

ANSWER

988

Winter Math · 16

ANSWER

24

Winter Math · 15

ANSWER

$$\frac{11}{12}$$

Winter Math · 17

There are 34 snowball cookies. Each tin holds 8. How many tins can be filled all the way?

Winter Math · 18

Noah builds a snow wall all the way around a rectangular snow fort that is 12 feet long and 2 feet wide. How many feet of wall does Noah build?

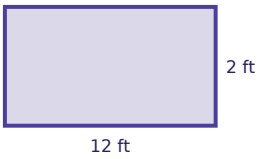

Winter Math · 19

Zoe eats $\frac{3}{12}$ of a chocolate cake. Lily eats $\frac{2}{12}$ of it. What fraction of the chocolate cake did they eat together?

Winter Math · 20

Each tin holds 17 cocoa muffins. The bakery fills 85 tins. How many cocoa muffins is that?

Winter Math · 21

Omar eats $\frac{2}{9}$ of a chocolate cake. Sam eats $\frac{3}{9}$ of it. What fraction of the chocolate cake did they eat together?

Winter Math · 22

There are 56 snowball cookies. Each tin holds 6. How many tins can be filled all the way?

Winter Math · 23

Ben builds a snow wall all the way around a rectangular snow fort that is 7 feet long and 2 feet wide. How many feet of wall does Ben build?

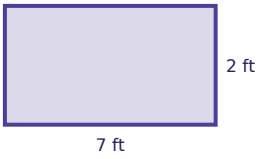

Winter Math · 24

Each tin holds 13 cocoa muffins. The bakery fills 31 tins. How many cocoa muffins is that?

Winter Math · 18

ANSWER

28

Winter Math · 17

ANSWER

4

Winter Math · 20

ANSWER

1445

Winter Math · 19

ANSWER

$$\frac{5}{12}$$

Winter Math · 22

ANSWER

9

Winter Math · 21

ANSWER

$$\frac{5}{9}$$

Winter Math · 24

ANSWER

403

Winter Math · 23

ANSWER

18