Winter Math · 1

Omar builds a snow wall all the way around a rectangular snow fort that is 7 feet long and 5 feet wide. How many feet of wall does Omar build?

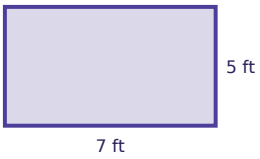

Winter Math · 2

Lily builds a snow wall all the way around a rectangular snow fort that is 4 feet long and 2 feet wide. How many feet of wall does Lily build?

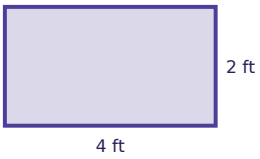

Winter Math · 3

Mia eats $\frac{5}{8}$ of a chocolate cake. Lily eats $\frac{2}{8}$ of it. What fraction of the chocolate cake did they eat together?

Winter Math · 4

Each tin holds 5 cocoa muffins. The bakery fills 24 tins. How many cocoa muffins is that?

Winter Math · 5

Ella eats $\frac{2}{7}$ of a chocolate cake. Leo eats $\frac{1}{7}$ of it. What fraction of the chocolate cake did they eat together?

Winter Math · 6

There are 19 cinnamon rolls. Each tin holds 3. How many tins can be filled all the way?

Winter Math · 7

There are 50 cinnamon rolls. Each tin holds 6. How many tins can be filled all the way?

Winter Math · 8

Each tin holds 8 cocoa muffins. The bakery fills 18 tins. How many cocoa muffins is that?

Winter Math · 2

ANSWER

12

Winter Math · 1

ANSWER

24

Winter Math · 4

ANSWER

120

Winter Math · 3

ANSWER

$$\frac{7}{8}$$

Winter Math · 6

ANSWER

6

Winter Math · 5

ANSWER

$$\frac{3}{7}$$

Winter Math · 8

ANSWER

144

Winter Math · 7

ANSWER

8

Winter Math · 9

There are 75 cocoa muffins. Each tin holds 7. How many tins can be filled all the way?

Winter Math · 10

Each tin holds 5 snowball cookies. The bakery fills 21 tins. How many snowball cookies is that?

Winter Math · 11

Ava eats $\frac{2}{7}$ of a chocolate cake. Ella eats $\frac{3}{7}$ of it. What fraction of the chocolate cake did they eat together?

Winter Math · 12

Each tin holds 9 cocoa muffins. The bakery fills 38 tins. How many cocoa muffins is that?

Winter Math · 13

Leo builds a snow wall all the way around a rectangular snow fort that is 5 feet long and 4 feet wide. How many feet of wall does Leo build?

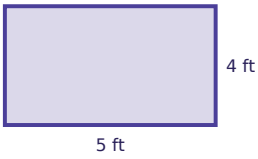

Winter Math · 14

There are 39 cinnamon rolls. Each tin holds 6. After filling as many tins as possible, how many cinnamon rolls are left over?

Winter Math · 15

Lily builds a snow wall all the way around a rectangular snow fort that is 6 feet long and 2 feet wide. How many feet of wall does Lily build?

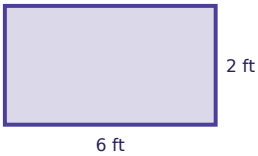

Winter Math · 16

Leo eats $\frac{2}{8}$ of a chocolate cake. Sam eats $\frac{5}{8}$ of it. What fraction of the chocolate cake did they eat together?

Winter Math · 10

ANSWER

105

Winter Math · 9

ANSWER

10

Winter Math · 12

ANSWER

342

Winter Math · 11

ANSWER

$$\frac{5}{7}$$

Winter Math · 14

ANSWER

3

Winter Math · 13

ANSWER

18

Winter Math · 16

ANSWER

$$\frac{7}{8}$$

Winter Math · 15

ANSWER

16

Winter Math · 17

Zoe builds a snow wall all the way around a rectangular snow fort that is 4 feet long and 3 feet wide. How many feet of wall does Zoe build?

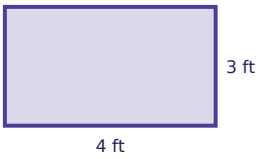

Winter Math · 18

Each tin holds 7 snowball cookies. The bakery fills 34 tins. How many snowball cookies is that?

Winter Math · 19

Noah eats $\frac{1}{5}$ of a chocolate cake. Zoe eats $\frac{1}{5}$ of it. What fraction of the chocolate cake did they eat together?

Winter Math · 20

Zoe builds a snow wall all the way around a rectangular snow fort that is 6 feet long and 4 feet wide. How many feet of wall does Zoe build?

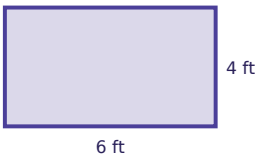

Winter Math · 21

There are 62 cocoa muffins. Each tin holds 9. How many tins can be filled all the way?

Winter Math · 22

There are 57 cocoa muffins. Each tin holds 5. How many tins can be filled all the way?

Winter Math · 23

Each tin holds 3 cocoa muffins. The bakery fills 30 tins. How many cocoa muffins is that?

Winter Math · 24

Ben eats $\frac{2}{5}$ of a chocolate cake. Zoe eats $\frac{2}{5}$ of it. What fraction of the chocolate cake did they eat together?

Winter Math · 18

ANSWER

238

Winter Math · 17

ANSWER

14

Winter Math · 20

ANSWER

20

Winter Math · 19

ANSWER

$\frac{2}{5}$

Winter Math · 22

ANSWER

11

Winter Math · 21

ANSWER

6

Winter Math · 24

ANSWER

$\frac{4}{5}$

Winter Math · 23

ANSWER

90