Task card 1 Valentine's Day Math

Ava eats $\frac{2}{7}$ of a heart-shaped cake. Zoe eats $\frac{1}{7}$ of it. What fraction of the heart-shaped cake did they eat together?

Task card 2 Valentine's Day Math

There are 26 heart cookies. Each box holds 3. After filling as many boxs as possible, how many heart cookies are left over?

Task card 3 Valentine's Day Math

Each box holds 7 brownies. The bakery fills 28 boxs. How many brownies is that?

Task card 4 Valentine's Day Math

Omar glues red ribbon all the way around a rectangular bulletin board that is 4 feet wide and 3 feet tall. How many feet of ribbon does Omar need?



Task card 5 Valentine's Day Math

There are 44 brownies. Each box holds 8. After filling as many boxs as possible, how many brownies are left over?

Task card 6 Valentine's Day Math

Lily glues red ribbon all the way around a rectangular bulletin board that is 6 feet wide and 4 feet tall. How many feet of ribbon does Lily need?



Task card 7 Valentine's Day Math

Each box holds 4 heart cookies. The bakery fills 24 boxs. How many heart cookies is that?

Task card 8 Valentine's Day Math

Ava eats $\frac{3}{8}$ of a heart-shaped cake. Leo eats $\frac{2}{8}$ of it. What fraction of the heart-shaped cake did they eat together?

Task card 9 Valentine's Day Math

Each box holds 7 heart cookies. The bakery fills 40 boxs. How many heart cookies is that?

Task card 10 Valentine's Day Math

Zoe glues red ribbon all the way around a rectangular bulletin board that is 7 feet wide and 4 feet tall. How many feet of ribbon does Zoe need?

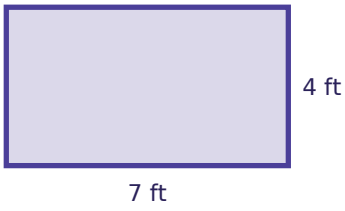

Task card 11 Valentine's Day Math

There are 22 brownies. Each box holds 4. After filling as many boxs as possible, how many brownies are left over?

Task card 12 Valentine's Day Math

Each box holds 5 cupcakes. The bakery fills 13 boxs. How many cupcakes is that?

Task card 13 Valentine's Day Math

Ella eats $\frac{2}{8}$ of a heart-shaped cake. Ava eats $\frac{1}{8}$ of it. What fraction of the heart-shaped cake did they eat together?

Task card 14 Valentine's Day Math

There are 44 cupcakes. Each box holds 7. How many boxs can be filled all the way?

Task card 15 Valentine's Day Math

Ben glues red ribbon all the way around a rectangular bulletin board that is 5 feet wide and 4 feet tall. How many feet of ribbon does Ben need?

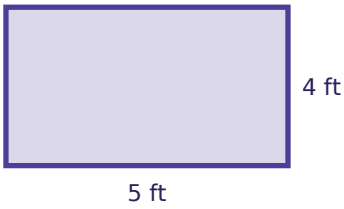

Task card 16 Valentine's Day Math

Sam eats $\frac{4}{7}$ of a heart-shaped cake. Ben eats $\frac{2}{7}$ of it. What fraction of the heart-shaped cake did they eat together?

Task card 17 Valentine's Day Math

Each box holds 8 heart cookies. The bakery fills 46 boxs. How many heart cookies is that?

Task card 18 Valentine's Day Math

Each box holds 8 brownies. The bakery fills 12 boxs. How many brownies is that?

Task card 19 Valentine's Day Math

There are 85 cupcakes. Each box holds 7. After filling as many boxs as possible, how many cupcakes are left over?

Task card 20 Valentine's Day Math

There are 86 brownies. Each box holds 7. After filling as many boxs as possible, how many brownies are left over?

Task card 21 Valentine's Day Math

Noah eats $\frac{4}{7}$ of a heart-shaped cake. Ben eats $\frac{2}{7}$ of it. What fraction of the heart-shaped cake did they eat together?

Task card 22 Valentine's Day Math

Ava glues red ribbon all the way around a rectangular bulletin board that is 9 feet wide and 7 feet tall. How many feet of ribbon does Ava need?



Task card 23 Valentine's Day Math

Ben glues red ribbon all the way around a rectangular bulletin board that is 5 feet wide and 2 feet tall. How many feet of ribbon does Ben need?

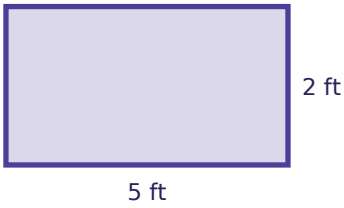

Task card 24 Valentine's Day Math

Ava eats $\frac{2}{7}$ of a heart-shaped cake. Ben eats $\frac{3}{7}$ of it. What fraction of the heart-shaped cake did they eat together?

Valentine's Day Math Task Cards

Recording sheet · Grade 4 · Read each story and solve.

Name: _____ Date: _____

Scan to check your answers

1	2	3	4
5	6	7	8
9	10	11	12
13	14	15	16
17	18	19	20
21	22	23	24

Valentine's Day Math Task Cards: Answer Key

Grade 4 · Easy

The answers online

1. $\frac{3}{7}$	**2.** 2	**3.** 196
4. 14	**5.** 4	**6.** 20
7. 96	**8.** $\frac{5}{8}$	**9.** 280
10. 22	**11.** 2	**12.** 65
13. $\frac{3}{8}$	**14.** 6	**15.** 18
16. $\frac{6}{7}$	**17.** 368	**18.** 96
19. 1	**20.** 2	**21.** $\frac{6}{7}$
22. 32	**23.** 14	**24.** $\frac{5}{7}$