Valentine's Day Math · 1

Ella glues red ribbon all the way around a rectangular bulletin board that is 5 feet wide and 4 feet tall. How many feet of ribbon does Ella need?

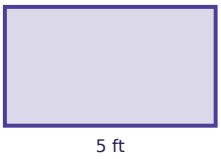

Valentine's Day Math · 2

Leo eats $\frac{1}{9}$ of a heart-shaped cake. Ben eats $\frac{1}{9}$ of it. What fraction of the heart-shaped cake did they eat together?

Valentine's Day Math · 3

There are 125 brownies. Each box holds 9. How many boxs can be filled all the way?

Valentine's Day Math · 4

Each box holds 7 heart cookies. The bakery fills 31 boxs. How many heart cookies is that?

Valentine's Day Math · 5

Mia glues red ribbon all the way around a rectangular bulletin board that is 9 feet wide and 6 feet tall. How many feet of ribbon does Mia need?

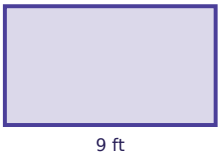

Valentine's Day Math · 6

There are 45 brownies. Each box holds 7. How many boxs can be filled all the way?

Valentine's Day Math · 7

Mia eats $\frac{1}{9}$ of a heart-shaped cake. Omar eats $\frac{1}{9}$ of it. What fraction of the heart-shaped cake did they eat together?

Valentine's Day Math · 8

Each box holds 6 brownies. The bakery fills 47 boxs. How many brownies is that?

Valentine's Day Math · 2

ANSWER

$\frac{2}{9}$

Valentine's Day Math · 1

ANSWER

18

Valentine's Day Math · 4

ANSWER

217

Valentine's Day Math · 3

ANSWER

13

Valentine's Day Math · 6

ANSWER

6

Valentine's Day Math · 5

ANSWER

30

Valentine's Day Math · 8

ANSWER

282

Valentine's Day Math · 7

ANSWER

$\frac{2}{9}$

Valentine's Day Math · 9

There are 74 cupcakes. Each box holds 6. How many boxs can be filled all the way?

Valentine's Day Math · 10

Each box holds 5 heart cookies. The bakery fills 42 boxs. How many heart cookies is that?

Valentine's Day Math · 11

Each box holds 8 brownies. The bakery fills 37 boxs. How many brownies is that?

Valentine's Day Math · 12

Mia eats $\frac{1}{9}$ of a heart-shaped cake. Noah eats $\frac{1}{9}$ of it. What fraction of the heart-shaped cake did they eat together?

Valentine's Day Math · 13

There are 110 cupcakes. Each box holds 8. How many boxs can be filled all the way?

Valentine's Day Math · 14

Noah eats $\frac{1}{9}$ of a heart-shaped cake. Sam eats $\frac{7}{9}$ of it. What fraction of the heart-shaped cake did they eat together?

Valentine's Day Math · 15

Mia glues red ribbon all the way around a rectangular bulletin board that is 6 feet wide and 4 feet tall. How many feet of ribbon does Mia need?

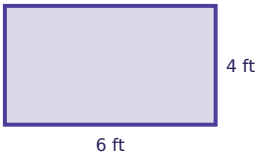

Valentine's Day Math · 16

Noah glues red ribbon all the way around a rectangular bulletin board that is 11 feet wide and 6 feet tall. How many feet of ribbon does Noah need?

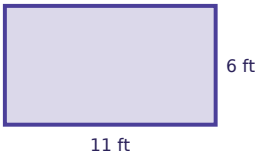

Valentine's Day Math · 10

ANSWER

210

Valentine's Day Math · 9

ANSWER

12

Valentine's Day Math · 12

ANSWER

$$\frac{2}{9}$$

Valentine's Day Math · 11

ANSWER

296

Valentine's Day Math · 14

ANSWER

$$\frac{8}{9}$$

Valentine's Day Math · 13

ANSWER

13

Valentine's Day Math · 16

ANSWER

34

Valentine's Day Math · 15

ANSWER

20

Valentine's Day Math · 17

Leo eats $\frac{3}{12}$ of a heart-shaped cake. Omar eats $\frac{4}{12}$ of it. What fraction of the heart-shaped cake did they eat together?

Valentine's Day Math · 18

Mia glues red ribbon all the way around a rectangular bulletin board that is 9 feet wide and 2 feet tall. How many feet of ribbon does Mia need?

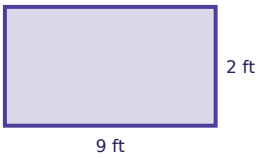

Valentine's Day Math · 19

Each box holds 20 cupcakes. The bakery fills 36 boxs. How many cupcakes is that?

Valentine's Day Math · 20

There are 47 heart cookies. Each box holds 4. How many boxs can be filled all the way?

Valentine's Day Math · 21

Each box holds 15 brownies. The bakery fills 71 boxs. How many brownies is that?

Valentine's Day Math · 22

Mia eats $\frac{1}{8}$ of a heart-shaped cake. Omar eats $\frac{4}{8}$ of it. What fraction of the heart-shaped cake did they eat together?

Valentine's Day Math · 23

There are 125 cupcakes. Each box holds 9. After filling as many boxs as possible, how many cupcakes are left over?

Valentine's Day Math · 24

Sam glues red ribbon all the way around a rectangular bulletin board that is 7 feet wide and 2 feet tall. How many feet of ribbon does Sam need?

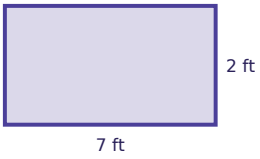

Valentine's Day Math · 18

ANSWER

22

Valentine's Day Math · 17

ANSWER

$$\frac{7}{12}$$

Valentine's Day Math · 20

ANSWER

11

Valentine's Day Math · 19

ANSWER

720

Valentine's Day Math · 22

ANSWER

$$\frac{5}{8}$$

Valentine's Day Math · 21

ANSWER

1065

Valentine's Day Math · 24

ANSWER

18

Valentine's Day Math · 23

ANSWER

8